Leyendo rectas numéricas no tradicionales Nombre:

Encontrar el valor de R.

1)

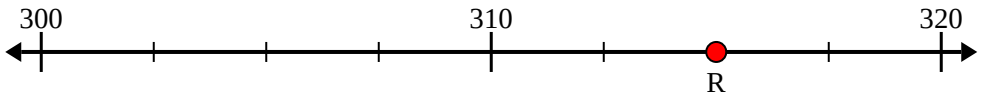

2)

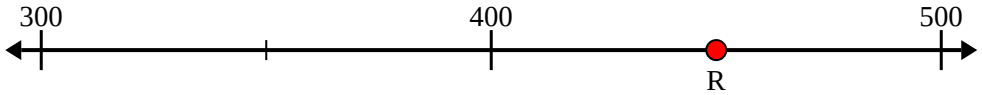

3)

4)

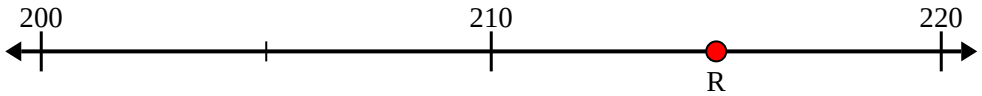

5)

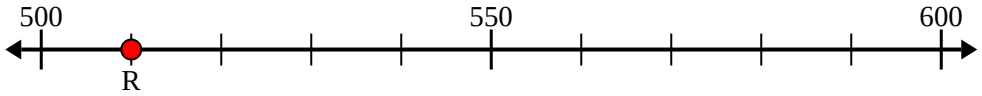

6)

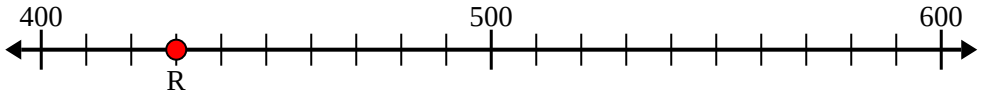

7)

8)

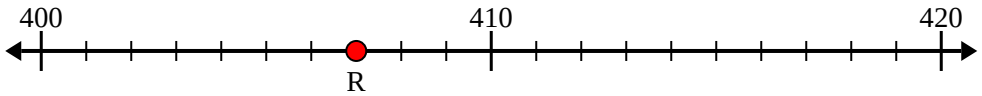

9)

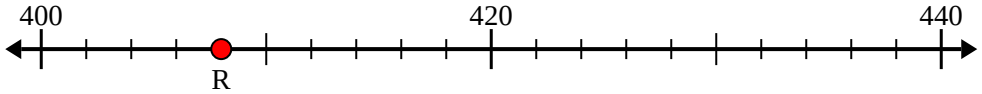

10)

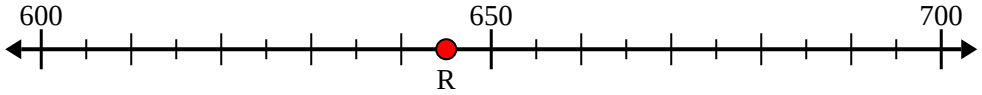

Respuestas

1. _____
2. _____
3. _____
4. _____
5. _____
6. _____
7. _____
8. _____
9. _____
10. _____

1-10	90	80	70	60	50	40	30	20	10	0

Leyendo rectas numéricas no tradicionales

Nombre: **Clave De Respuestas**

Encontrar el valor de R.

1)

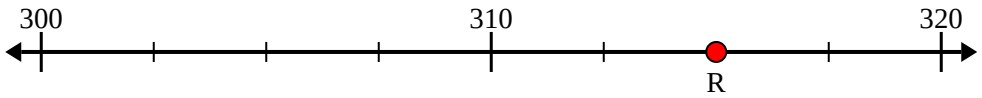

2)

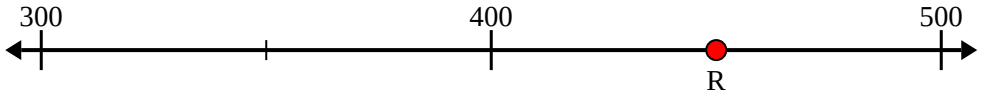

3)

4)

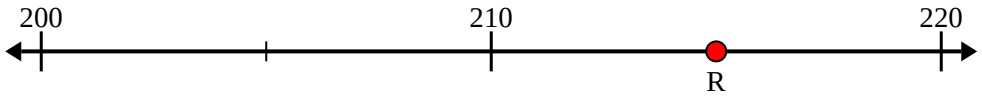

5)

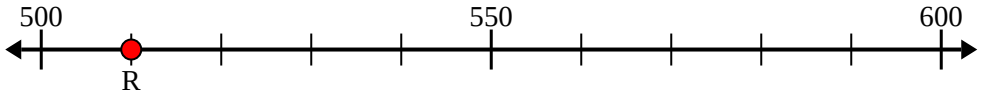

6)

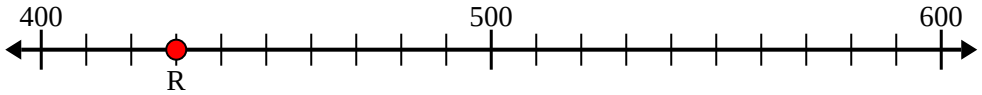

7)

8)

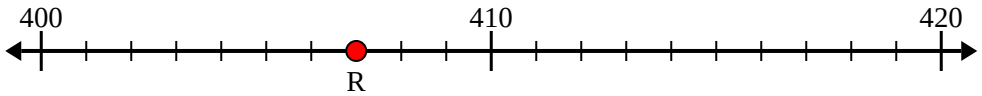

9)

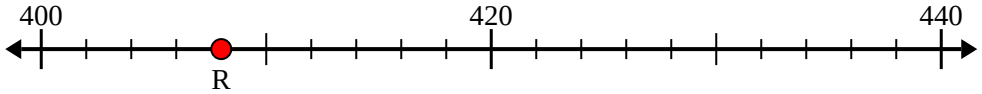

10)

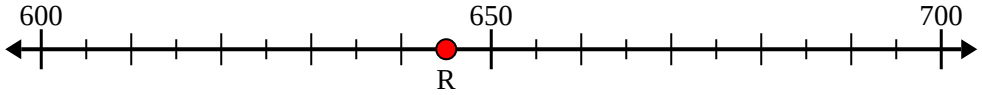

Respuestas

1. **315**
2. **450**
3. **330**
4. **215**
5. **510**
6. **430**
7. **225**
8. **407**
9. **408**
10. **645**

1-10	90	80	70	60	50	40	30	20	10	0