Marcando el valor en una recta numérica Nombre:

Marque la ubicación del número en la recta numérica.

Ej) 11

0 20

1) 1

0 20

2) 3

0 20

3) 4

0 20

4) 15

0 20

5) 16

0 20

6) 14

0 20

7) 13

0 20

8) 19

0 20

9) 7

0 20

10) 18

0 20

Marcando el valor en una recta numérica

Nombre: **Clave De Respuestas**

Marque la ubicación del número en la recta numérica.

Ej) 11

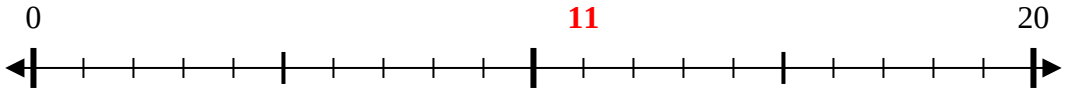

1) 1

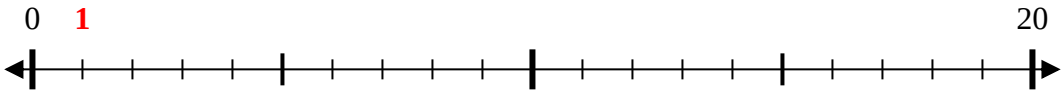

2) 3

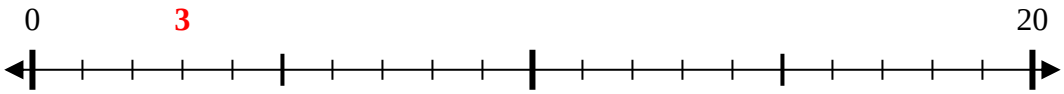

3) 4

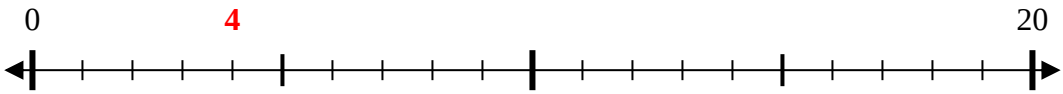

4) 15

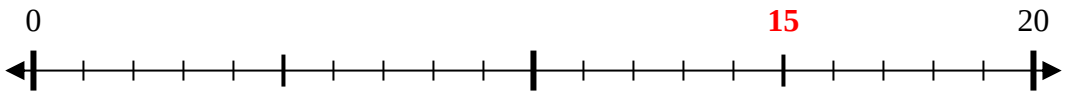

5) 16

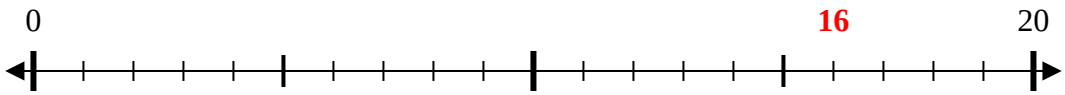

6) 14

7) 13

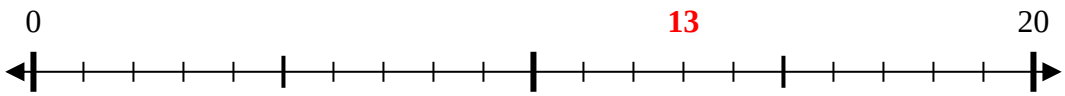

8) 19

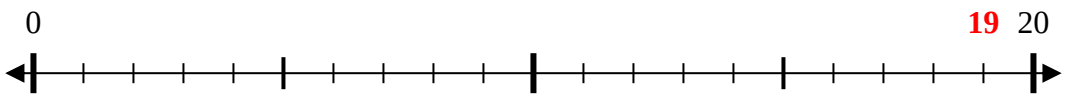

9) 7

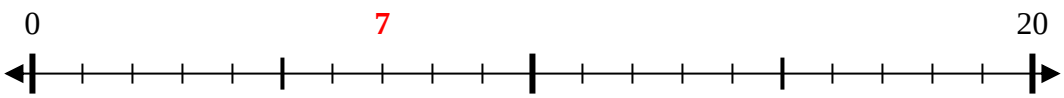

10) 18

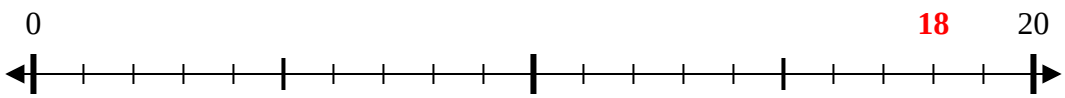

1-10	90	80	70	60	50	40	30	20	10	0