Emparejando Relojes

Nombre:

Emparejar el reloj analógico con el reloj digital correspondiente.

1) 

2) 

3)

4) 

5) 

6) 

7) 

8) 

9) 

10) 

11) 

12) 

13) 

14) 

15)

16) 

A. 10:30 **B.** 6:30 **C.** 5:00 **D.** 6:00

E. 3:00 **F.** 2:30 **G.** 3:30 **H.** 1:30

I. 11:30 **J.** 5:30 **K.** 9:30 **L.** 1:00

M. 2:00 **N.** 10:00 **O.** 7:30 **P.** 4:30

Respuestas

1. _____
2. _____
3. _____
4. _____
5. _____
6. _____
7. _____
8. _____
9. _____
10. _____
11. _____
12. _____
13. _____
14. _____
15. _____
16. _____

1-10	94	88	81	75	69	63	56	50	44	38
11-16	31	25	19	13	6	0				

Emparejando Relojes

Nombre: **Clave De Respuestas**

Emparejar el reloj analógico con el reloj digital correspondiente.

1) 

2) 

3)

4) 

5) 

6) 

7) 

8) 

9) 

10) 

11) 

12) 

13) 

14) 

15)

16) 

A. 10:30 B. 6:30 C. 5:00 D. 6:00

E. 3:00 F. 2:30 G. 3:30 H. 1:30

I. 11:30 J. 5:30 K. 9:30 L. 1:00

M. 2:00 N. 10:00 O. 7:30 P. 4:30

Respuestas

1. O
2. H
3. B
4. I
5. G
6. C
7. K
8. E
9. N
10. A
11. F
12. J
13. P
14. M
15. L
16. D

1-10	94	88	81	75	69	63	56	50	44	38
11-16	31	25	19	13	6	0				