Encontrando Diferencias de Temperatura

Nombre:

Determinar la diferencia en temperatura para los siguientes termómetros.

1)

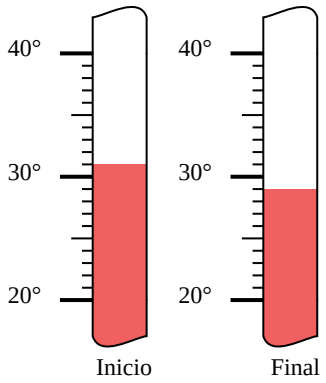

2)

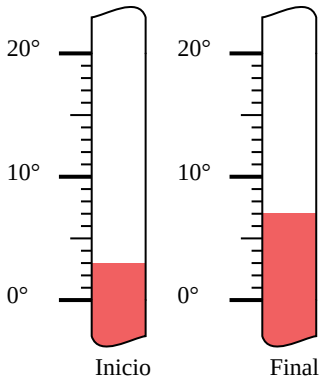

3)

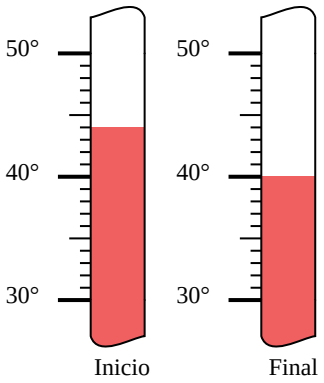

4)

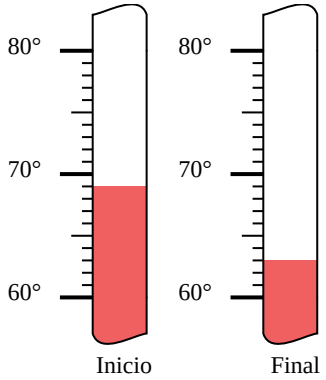

5)

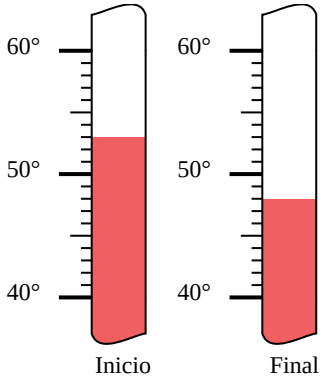

6)

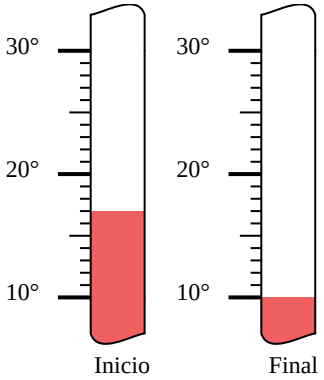

7)

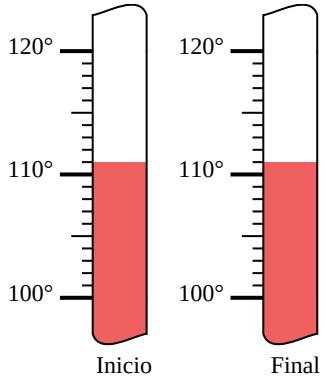

8)

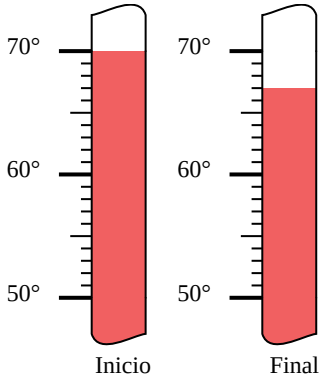

9)

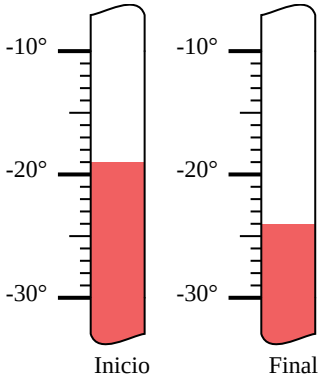

10)

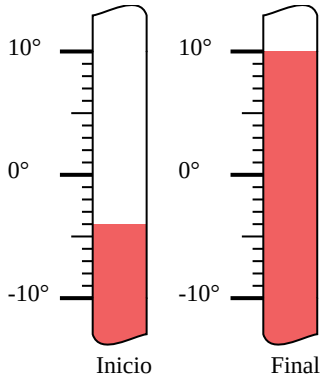

11)

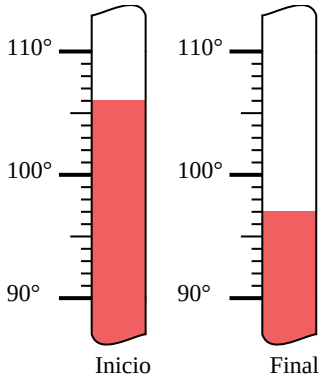

12)

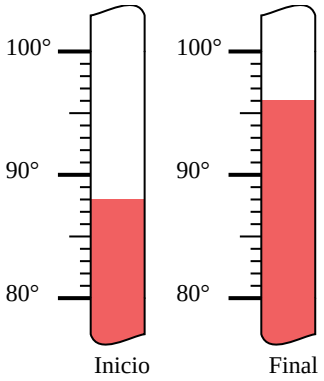

Respuestas

1. _____
2. _____
3. _____
4. _____
5. _____
6. _____
7. _____
8. _____
9. _____
10. _____
11. _____
12. _____

1-10	92	83	75	67	58	50	42	33	25	17
11-12	8	0								

Encontrando Diferencias de Temperatura

Nombre: **Clave De Respuestas**

Determinar la diferencia en temperatura para los siguientes termómetros.

1)

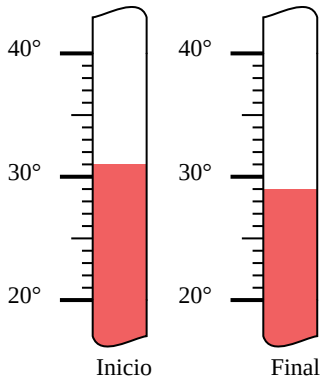

Inicio 31 — Final 29

2)

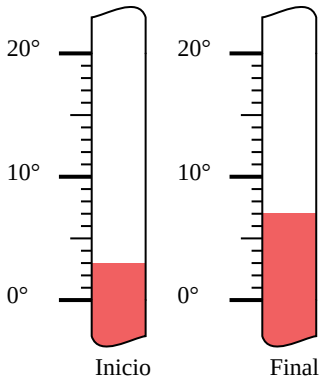

Inicio 3 — Final 7

3)

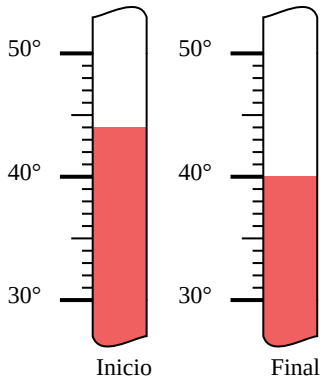

Inicio 44 — Final 40

4)

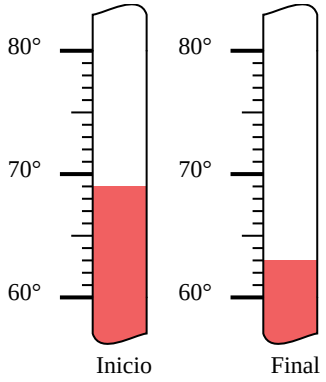

Inicio 69 — Final 63

5)

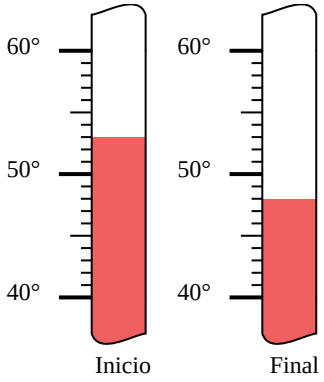

Inicio 53 — Final 48

6)

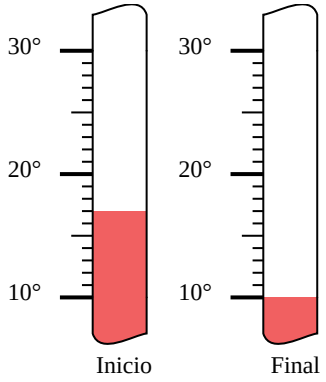

Inicio 17 — Final 10

7)

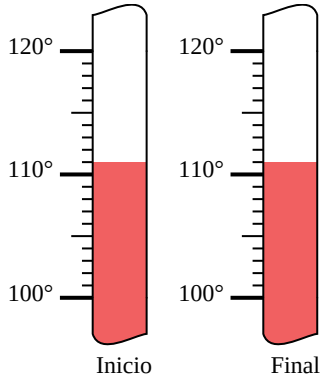

Inicio 111 — Final 111

8)

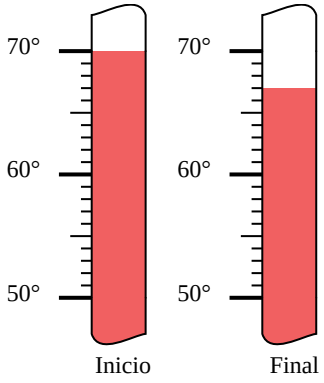

Inicio 70 — Final 67

9)

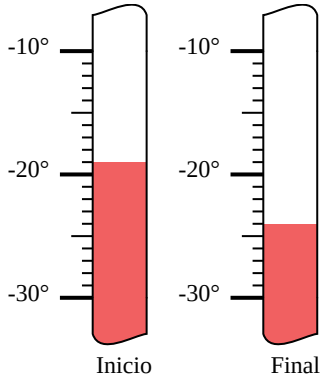

Inicio -19 — Final -24

10)

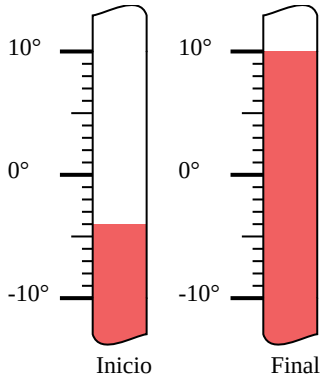

Inicio -4 — Final 10

11)

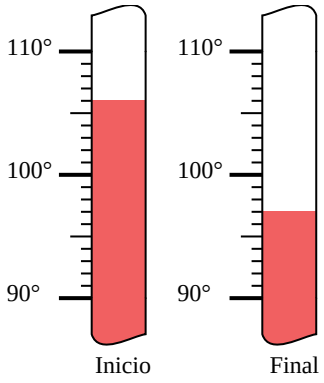

Inicio 106 — Final 97

12)

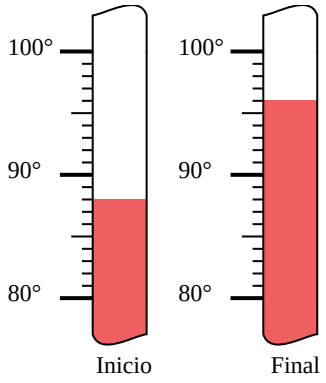

Inicio 88 — Final 96

Respuestas

1. 2°
2. 4°
3. 4°
4. 6°
5. 5°
6. 7°
7. 0°
8. 3°
9. 5°
10. 14°
11. 9°
12. 8°

1-10	92	83	75	67	58	50	42	33	25	17
11-12	8	0								