Identificación de figuras similares y congruentes

Nombre:

Determina si las figuras que se muestran son 'similares', 'congruentes' o 'ninguna'.

1)

2)



3)

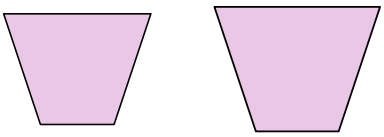

4)



5)

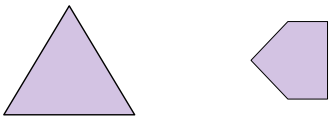

6)

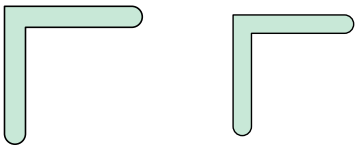

7)

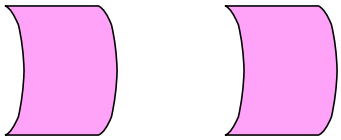

8)

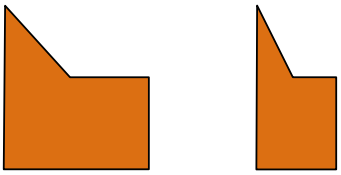

9)

10)

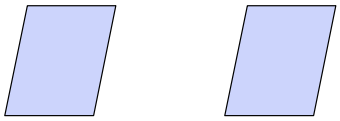

11)

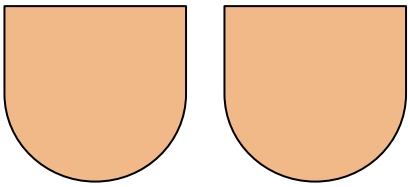

12)

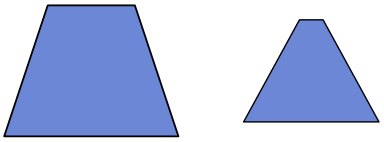

13)

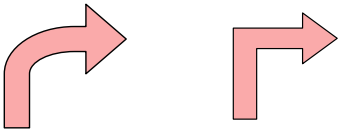

14)

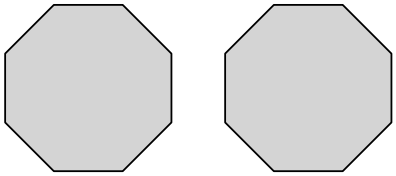

15)

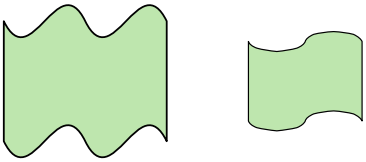

16)

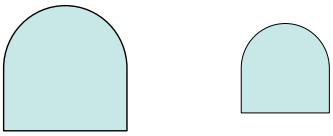

Respuestas

1. _____
2. _____
3. _____
4. _____
5. _____
6. _____
7. _____
8. _____
9. _____
10. _____
11. _____
12. _____
13. _____
14. _____
15. _____
16. _____

1-10	94	88	81	75	69	63	56	50	44	38
11-16	31	25	19	13	6	0				

Identificación de figuras similares y congruentes

Nombre: **Clave De Respuestas**

Determina si las figuras que se muestran son 'similares', 'congruentes' o 'ninguna'.

1)

2)



3)

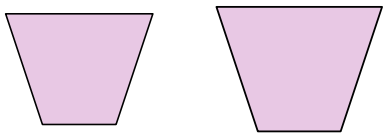

4)



5)

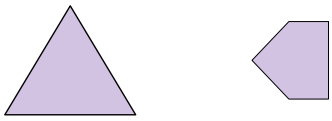

6)

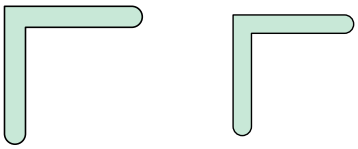

7)

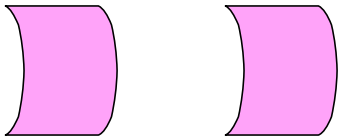

8)

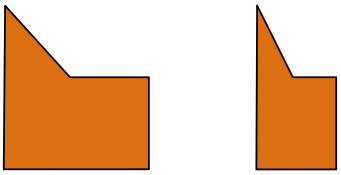

9)

10)

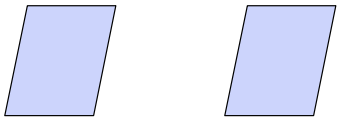

11)

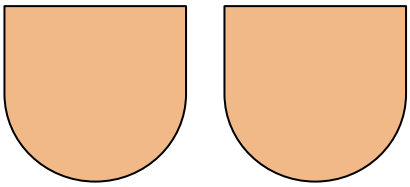

12)

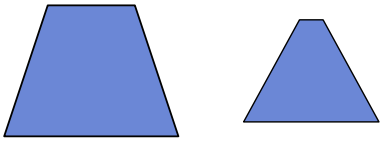

13)

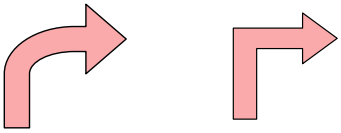

14)

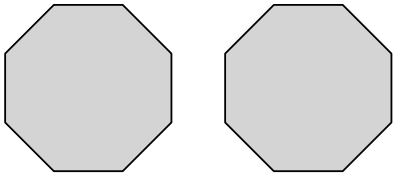

15)

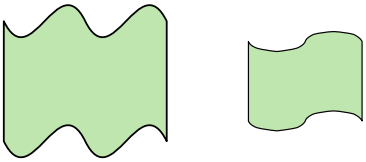

16)

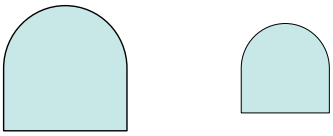

Respuestas

1. ninguno
2. ninguno
3. similar
4. similar
5. ninguno
6. similar
7. congruente
8. ninguno
9. congruente
10. congruente
11. congruente
12. ninguno
13. ninguno
14. congruente
15. ninguno
16. similar

1-10	94	88	81	75	69	63	56	50	44	38
11-16	31	25	19	13	6	0				