Identificando Figuras

Nombre:

Determinar si la forma mostrada es un 'Triángulo', 'Cuadrado', 'Rectángulo', 'Hexágono' u 'Otro'.

1)

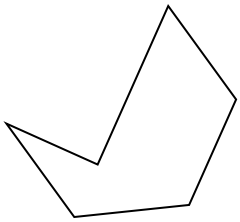

2)

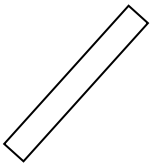

3)

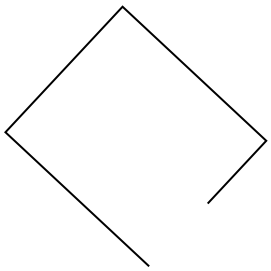

4)

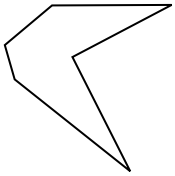

5)

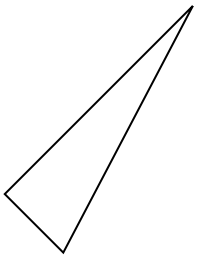

6)



7)

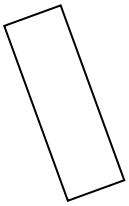

8)

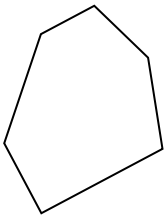

9)

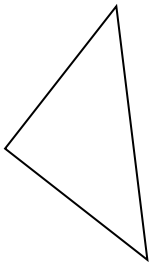

10)

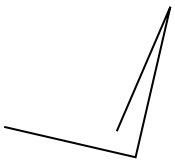

11)

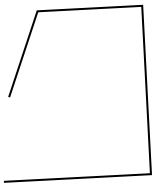

12)

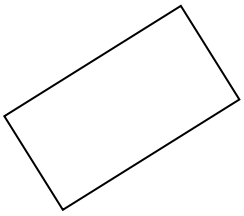

13)

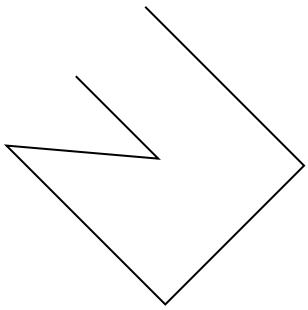

14)

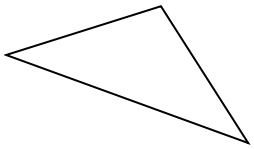

15)

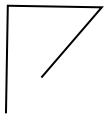

Respuestas

1. _____
2. _____
3. _____
4. _____
5. _____
6. _____
7. _____
8. _____
9. _____
10. _____
11. _____
12. _____
13. _____
14. _____
15. _____

1-10	93	87	80	73	67	60	53	47	40	33
11-15	27	20	13	7	0					

Determinar si la forma mostrada es un 'Triángulo', 'Cuadrado', 'Rectángulo', 'Hexágono' u 'Otro'.

1)
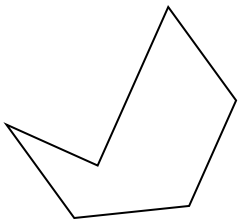

2)
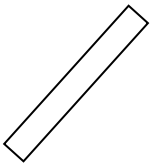

3)
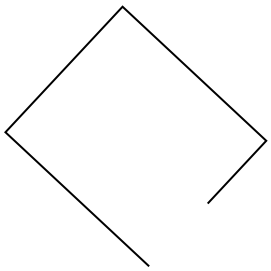

4)
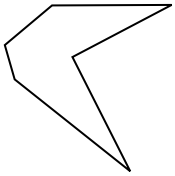

5)
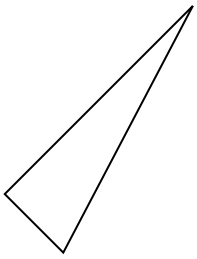

6)


7)
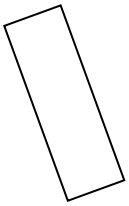

8)
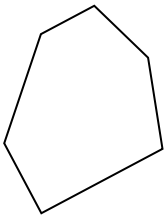

9)
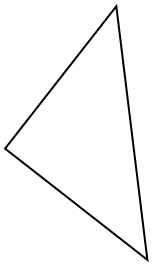

10)
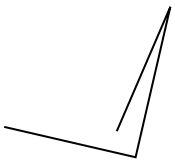

11)
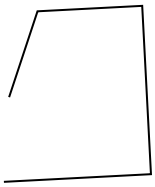

12)
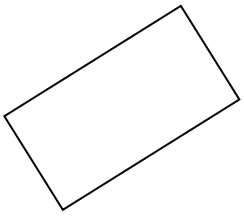

13)
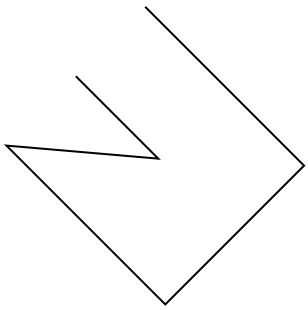

14)
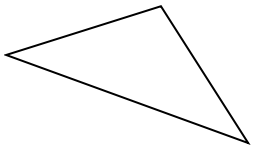

15)
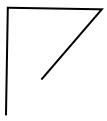

Respuestas

1. hexágono
2. rectangle
3. Otra
4. hexágono
5. triangle
6. Otra
7. rectangle
8. hexágono
9. triangle
10. Otra
11. Otra
12. rectangle
13. Otra
14. triangle
15. Otra

1-10	93	87	80	73	67	60	53	47	40	33
11-15	27	20	13	7	0					