Redondeando a Decenas (con rectas numéricas) Nombre:

Usar las rectas numéricas para encontrar el número más cercano a 10.

Ej)

25

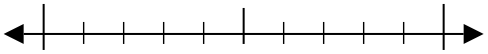

1)

39

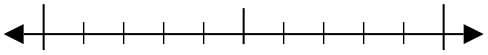

2)

40

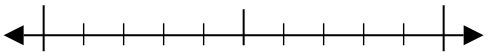

3)

48

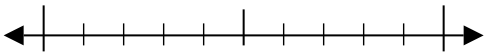

4)

125

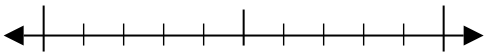

5)

226

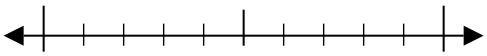

6)

896

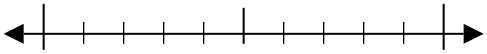

7)

391

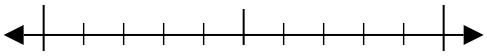

8)

8,795

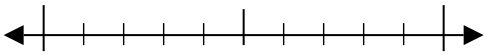

9)

7,950

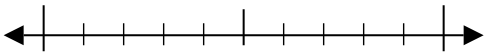

Respuestas

Ej. 30

1. _____

2. _____

3. _____

4. _____

5. _____

6. _____

7. _____

8. _____

9. _____

1-9	89	78	67	56	44	33	22	11	0

Redondeando a Decenas (con rectas numéricas) Nombre: **Clave De Respuestas**

Usar las rectas numéricas para encontrar el número más cercano a 10.

Ej)

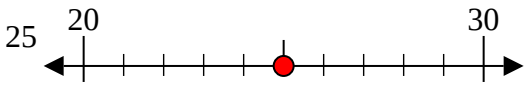

1)

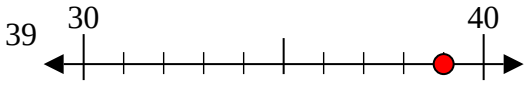

2)

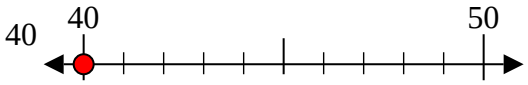

3)

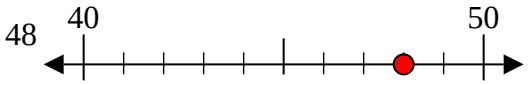

4)

5)

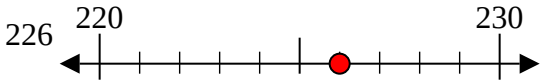

6)

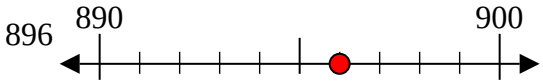

7)

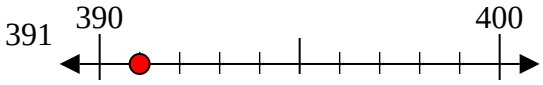

8)

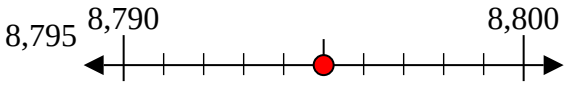

9)

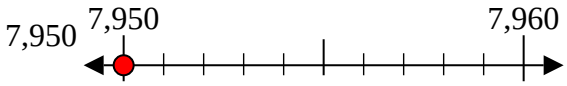

Respuestas

Ej.	30
1.	40
2.	40
3.	50
4.	130
5.	230
6.	900
7.	390
8.	8800
9.	7950

1-9	89	78	67	56	44	33	22	11	0