Máquinas de Funciones - (Sumar y Restar) Nombre:

Determina la regla que cada máquina de función está usando.

Ej)

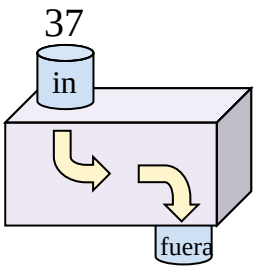

Restar 14

1)

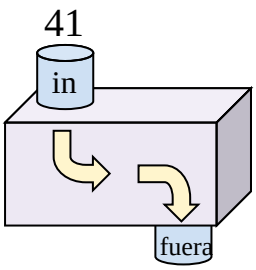

2)

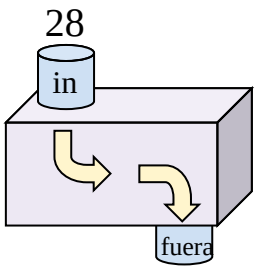

3)

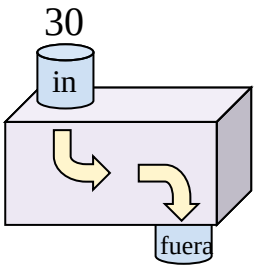

4)

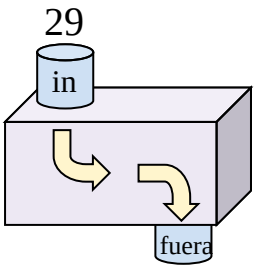

5)

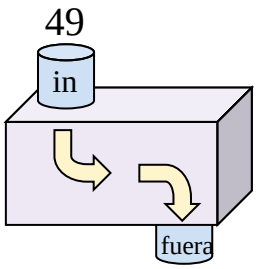

6)

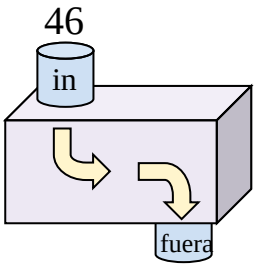

7)

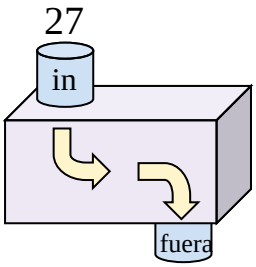

8)

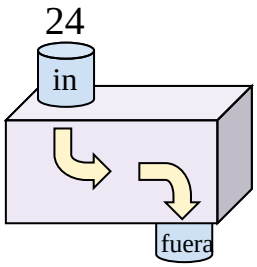

9)

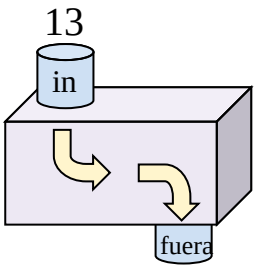

10)

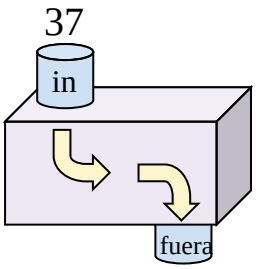

11)

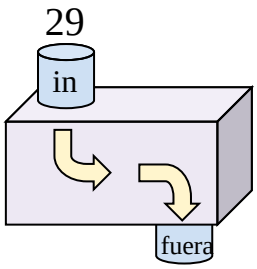

Respuestas

Ej. Restar 14

1. _____
2. _____
3. _____
4. _____
5. _____
6. _____
7. _____
8. _____
9. _____
10. _____
11. _____

1-10	91	82	73	64	55	45	36	27	18	9
11	0									

Determina la regla que cada máquina de función está usando.

Ej)

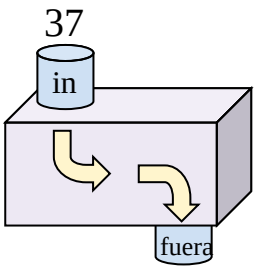

Restar 14

1)

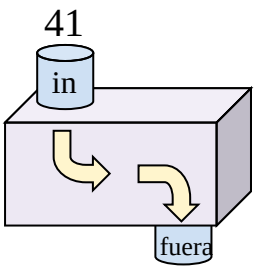

Restar 19

2)

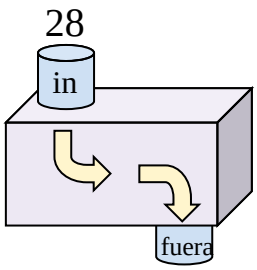

Agregar 16

3)

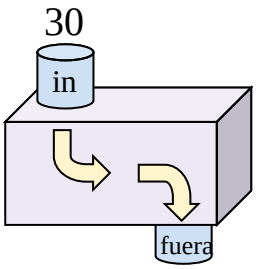

Agregar 14

4)

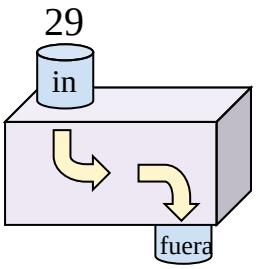

Agregar 21

5)

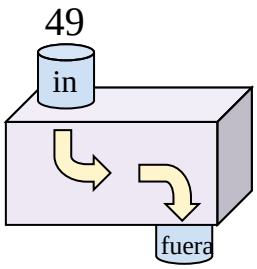

Restar 33

6)

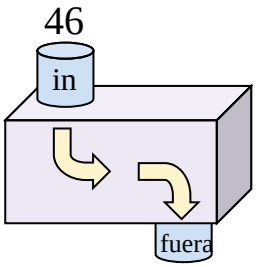

Restar 29

7)

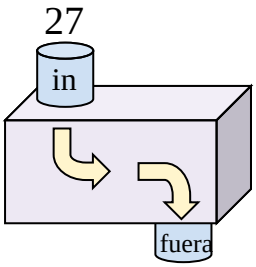

Agregar 9

8)

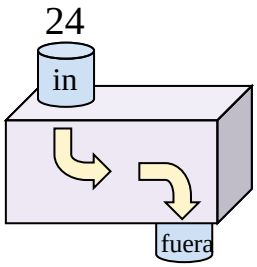

Agregar 6

9)

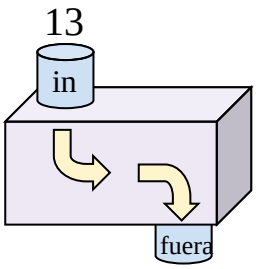

Agregar 12

10)

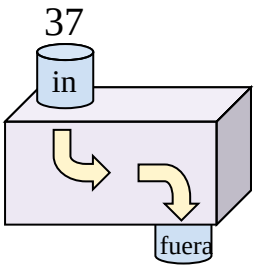

Restar 7

11)

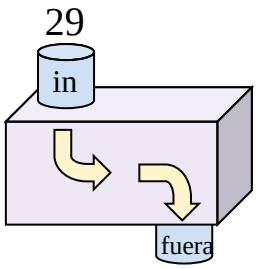

Agregar 16

Respuestas

Ej. **Restar 14**

1. **Restar 19**
2. **Agregar 16**
3. **Agregar 14**
4. **Agregar 21**
5. **Restar 33**
6. **Restar 29**
7. **Agregar 9**
8. **Agregar 6**
9. **Agregar 12**
10. **Restar 7**
11. **Agregar 16**

1-10	91	82	73	64	55	45	36	27	18	9
11	0									