Determina la regla que cada máquina de función está usando.

Ej)

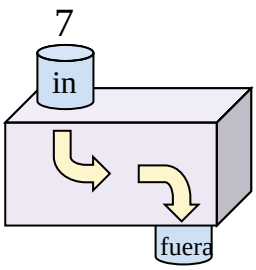

Agregar 13

1)

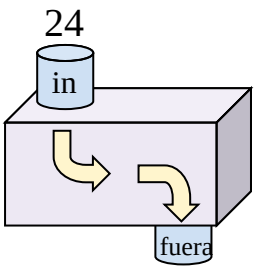

2)

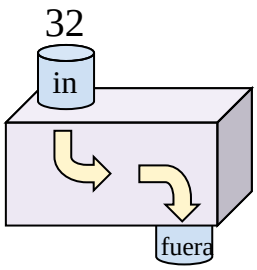

3)

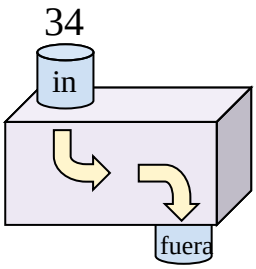

4)

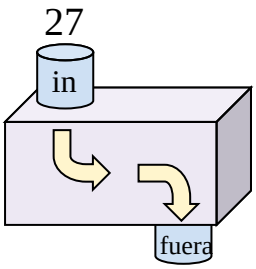

5)

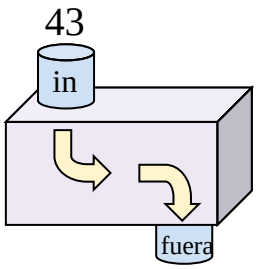

6)

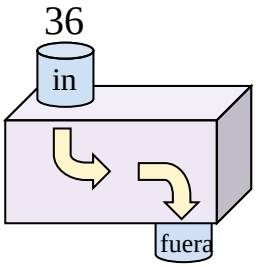

7)

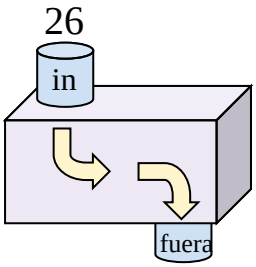

8)

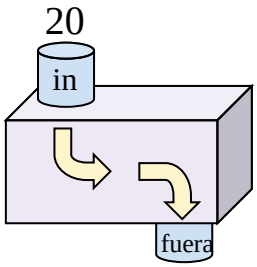

9)

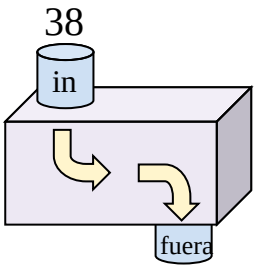

10)

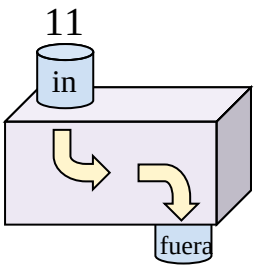

11)

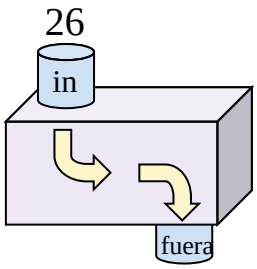

Respuestas

Ej. Agregar 13

1. _____
2. _____
3. _____
4. _____
5. _____
6. _____
7. _____
8. _____
9. _____
10. _____
11. _____

1-10	91	82	73	64	55	45	36	27	18	9
11	0									

Determina la regla que cada máquina de función está usando.

Ej)

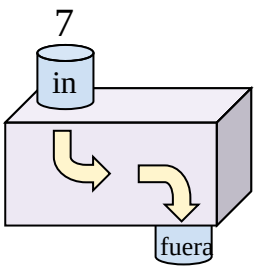

Agregar 13

1)

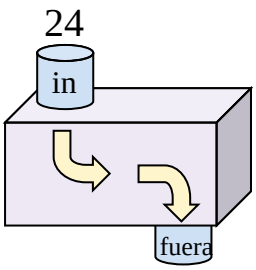

Agregar 9

2)

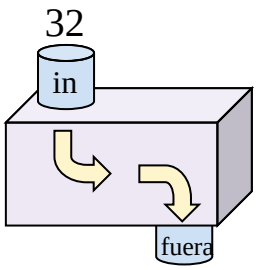

Restar 23

3)

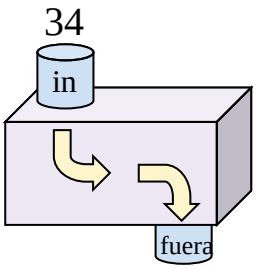

Restar 5

4)

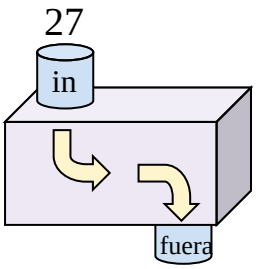

Agregar 10

5)

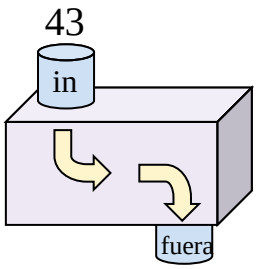

Restar 17

6)

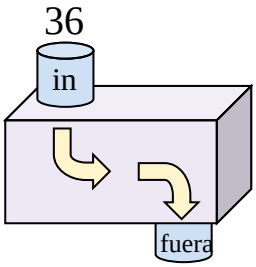

Restar 16

7)

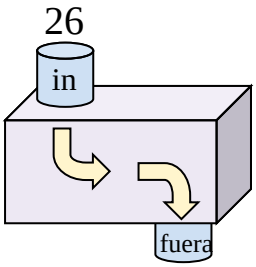

Agregar 5

8)

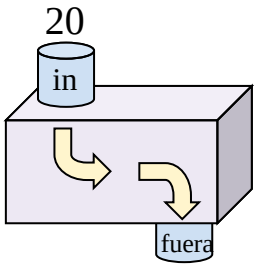

Agregar 13

9)

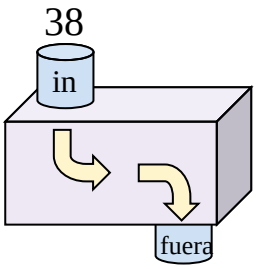

Restar 26

10)

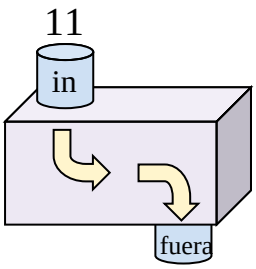

Agregar 8

11)

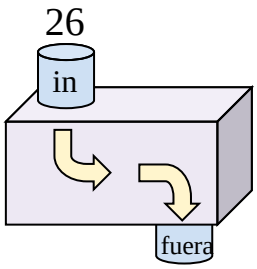

Restar 16

Respuestas

Ej. **Agregar 13**

1. **Agregar 9**
2. **Restar 23**
3. **Restar 5**
4. **Agregar 10**
5. **Restar 17**
6. **Restar 16**
7. **Agregar 5**
8. **Agregar 13**
9. **Restar 26**
10. **Agregar 8**
11. **Restar 16**

1-10	91	82	73	64	55	45	36	27	18	9
11	0									