Matrices rectangulares

Nombre:

Escribir una ecuación para expresar los grupos y después encontrar el número de figuras.

Ej)



1)

2)

3)



4)



5)

6)



7)

8)

9)



10)

11)



12)

13)

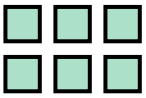

14)



Respuestas

Ej. $3 \times 3 = 9$

1. _____
2. _____
3. _____
4. _____
5. _____
6. _____
7. _____
8. _____
9. _____
10. _____
11. _____
12. _____
13. _____
14. _____

1-10	93	86	79	71	64	57	50	43	36	29
11-14	21	14	7	0						

Matrices rectangulares

Nombre: **Clave De Respuestas**

Escribir una ecuación para expresar los grupos y después encontrar el número de figuras.

Ej)



1)

2)

3)



4)



5)

6)



7)

8)

9)



10)

11)



12)

13)

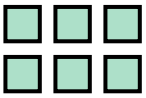

14)



Respuestas

Ej.	3 × 3 = 9
1.	5 × 2 = 10
2.	3 × 5 = 15
3.	5 × 3 = 15
4.	4 × 2 = 8
5.	4 × 5 = 20
6.	5 × 5 = 25
7.	2 × 2 = 4
8.	2 × 4 = 8
9.	4 × 3 = 12
10.	2 × 5 = 10
11.	5 × 4 = 20
12.	3 × 4 = 12
13.	2 × 3 = 6
14.	3 × 2 = 6

1-10	93	86	79	71	64	57	50	43	36	29
11-14	21	14	7	0						