Escribiendo Fracciones

Nombre:

Escribe la cantidad sombreada como una fracción de la cantidad total.

1)

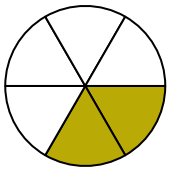

2)

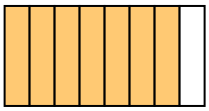

3)

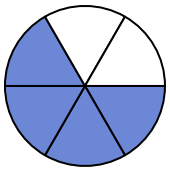

4)

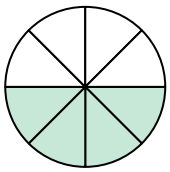

5)

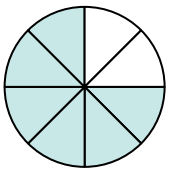

6)

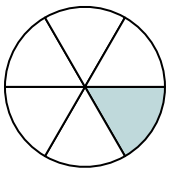

7)

8)

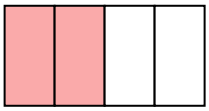

9)

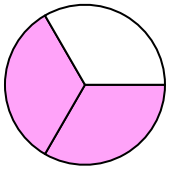

10)

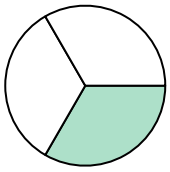

11)

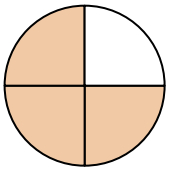

12)

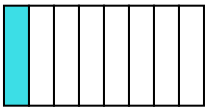

13)

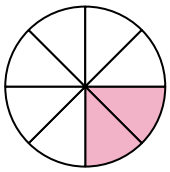

14)

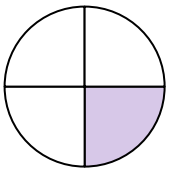

15)

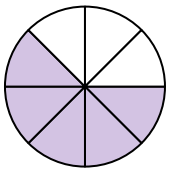

16)

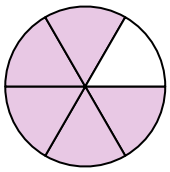

17)

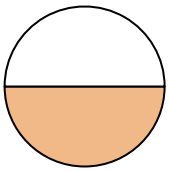

18)

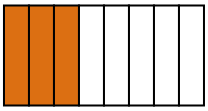

Respuestas

1. _____
2. _____
3. _____
4. _____
5. _____
6. _____
7. _____
8. _____
9. _____
10. _____
11. _____
12. _____
13. _____
14. _____
15. _____
16. _____
17. _____
18. _____

1-10	94	89	83	78	72	67	61	56	50	44
11-18	39	33	28	22	17	11	6	0		

Escribe la cantidad sombreada como una fracción de la cantidad total.

1) 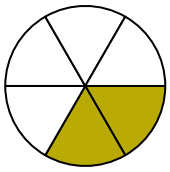

2) 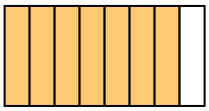

3) 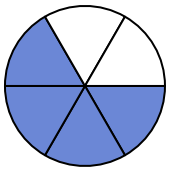

4) 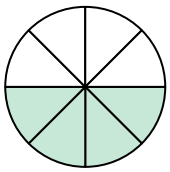

5) 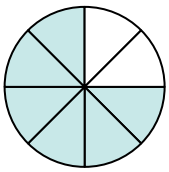

6) 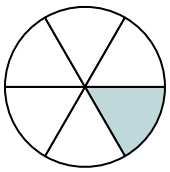

7)

8) 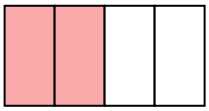

9) 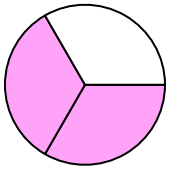

10) 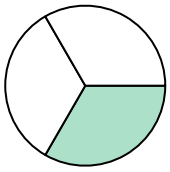

11) 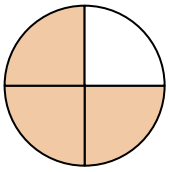

12) 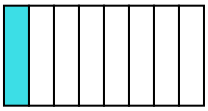

13) 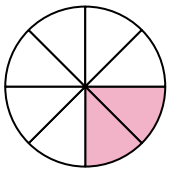

14) 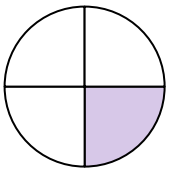

15) 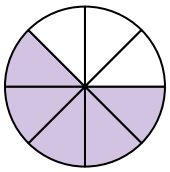

16) 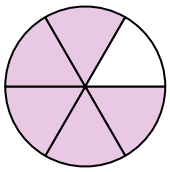

17) 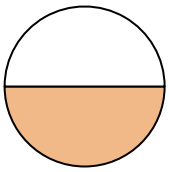

18) 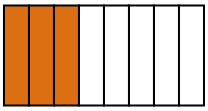

Respuestas

1. $\frac{2}{6}$
2. $\frac{7}{8}$
3. $\frac{4}{6}$
4. $\frac{4}{8}$
5. $\frac{6}{8}$
6. $\frac{1}{6}$
7. $\frac{3}{6}$
8. $\frac{2}{4}$
9. $\frac{2}{3}$
10. $\frac{1}{3}$
11. $\frac{3}{4}$
12. $\frac{1}{8}$
13. $\frac{2}{8}$
14. $\frac{1}{4}$
15. $\frac{5}{8}$
16. $\frac{5}{6}$
17. $\frac{1}{2}$
18. $\frac{3}{8}$

1-10	94	89	83	78	72	67	61	56	50	44
11-18	39	33	28	22	17	11	6	0		