Determinando fracciones Relativamente a la Mitad Nombre:

Determina si el área sombreada es 'más', 'menos' o 'igual' que la mitad.

1) 

2)

3) 

4)

5) 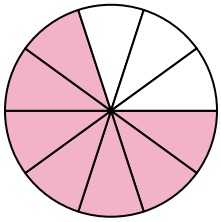

6) 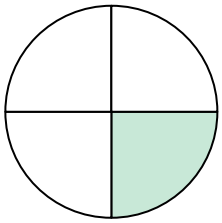

7) 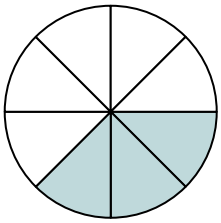

8)

9) 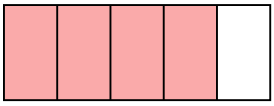

10)

11) 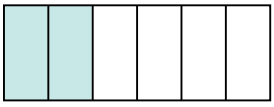

12) 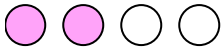

13)

14) 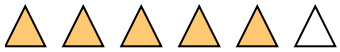

15) 

16) 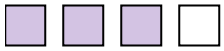

17)

18) 

19) 

20)

Respuestas

1. _____
2. _____
3. _____
4. _____
5. _____
6. _____
7. _____
8. _____
9. _____
10. _____
11. _____
12. _____
13. _____
14. _____
15. _____
16. _____
17. _____
18. _____
19. _____
20. _____

1-10	95	90	85	80	75	70	65	60	55	50
11-20	45	40	35	30	25	20	15	10	5	0

Determinando fracciones Relativamente a la Mitad Nombre: **Clave De Respuestas**

Determina si el área sombreada es 'más', 'menos' o 'igual' que la mitad.

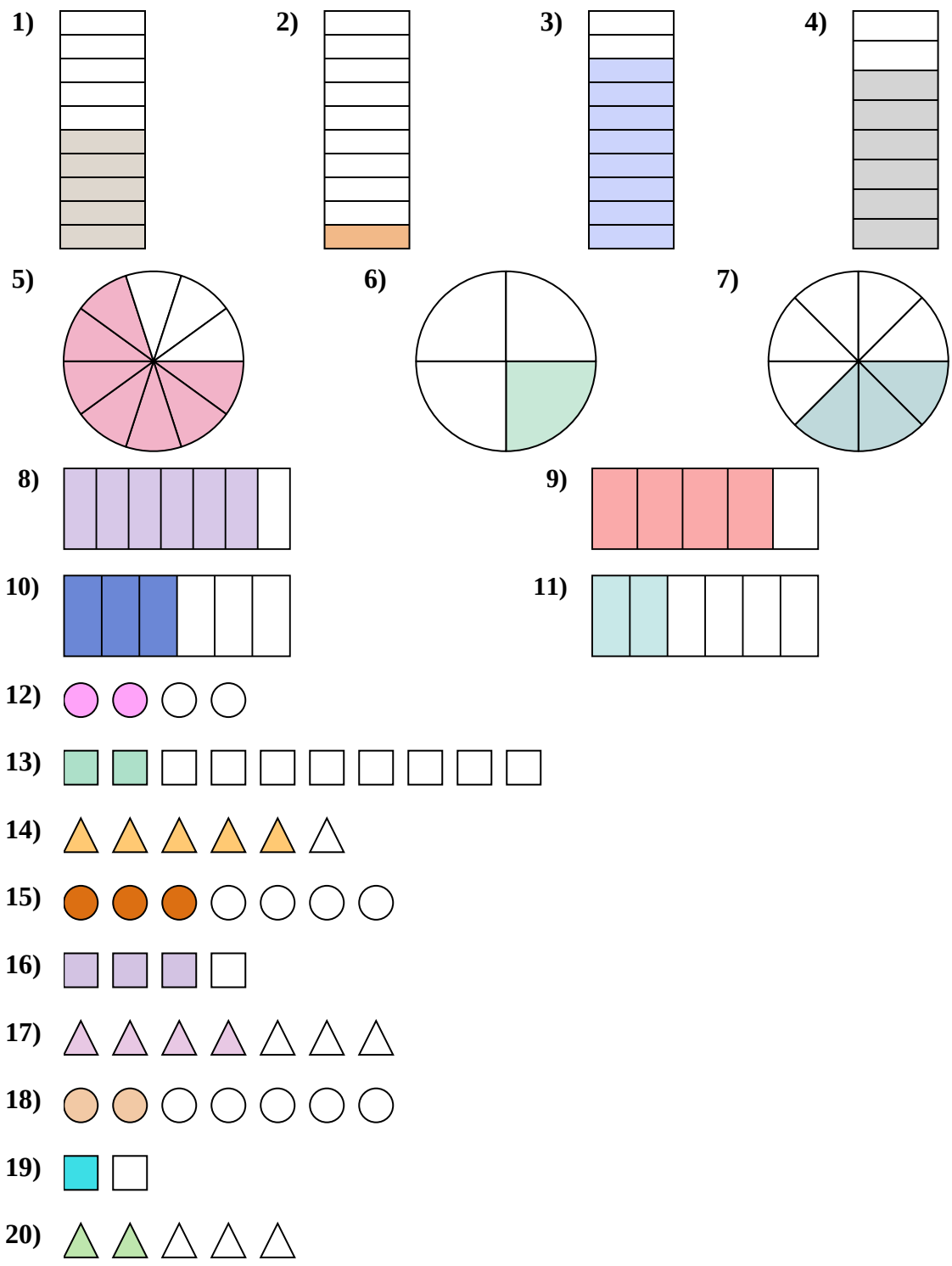

Respuestas

1. igual
2. menor
3. mayor
4. mayor
5. mayor
6. menor
7. menor
8. mayor
9. mayor
10. igual
11. menor
12. igual
13. menor
14. mayor
15. menor
16. mayor
17. mayor
18. menor
19. igual
20. menor

1-10	95	90	85	80	75	70	65	60	55	50
11-20	45	40	35	30	25	20	15	10	5	0