Determinando fracciones Relativamente a la Mitad Nombre:

Determina si el área sombreada es 'más', 'menos' o 'igual' que la mitad.

1)

2) 

3) 

4) 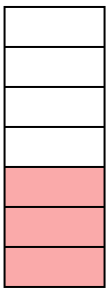

5) 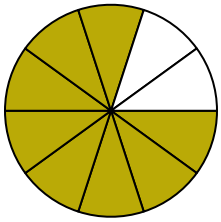

6) 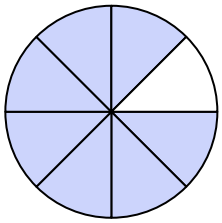

7) 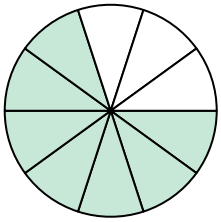

8)

9) 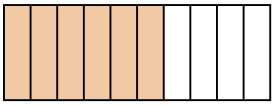

10) 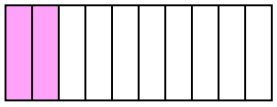

11) 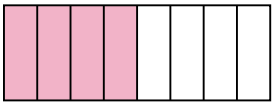

12) 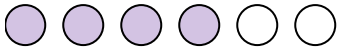

13)

14) 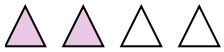

15) 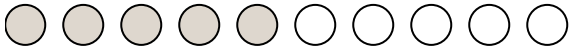

16) 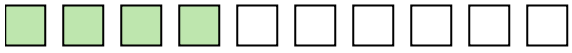

17)

18) 

19)

20)

Respuestas

1. _____
2. _____
3. _____
4. _____
5. _____
6. _____
7. _____
8. _____
9. _____
10. _____
11. _____
12. _____
13. _____
14. _____
15. _____
16. _____
17. _____
18. _____
19. _____
20. _____

1-10	95	90	85	80	75	70	65	60	55	50
11-20	45	40	35	30	25	20	15	10	5	0

Determinando fracciones Relativamente a la Mitad Nombre: **Clave De Respuestas**

Determina si el área sombreada es 'más', 'menos' o 'igual' que la mitad.

1)

2) 

3) 

4) 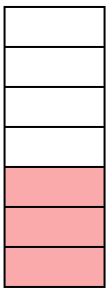

5) 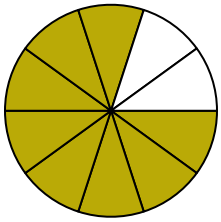

6) 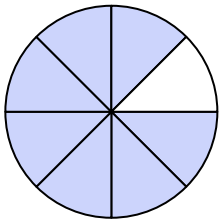

7) 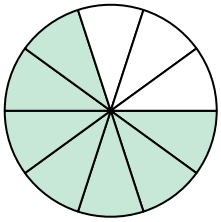

8)

9) 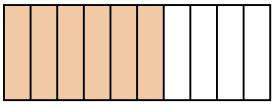

10) 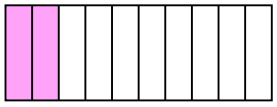

11) 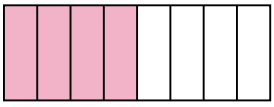

12) 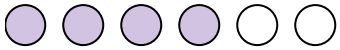

13)

14) 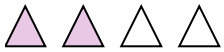

15) 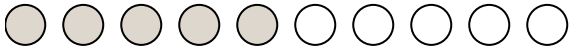

16) 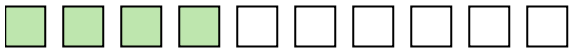

17)

18) 

19)

20)

Respuestas

1. menor
2. mayor
3. menor
4. menor
5. mayor
6. mayor
7. mayor
8. menor
9. mayor
10. menor
11. igual
12. mayor
13. mayor
14. igual
15. igual
16. menor
17. menor
18. mayor
19. menor
20. menor

1-10	95	90	85	80	75	70	65	60	55	50
11-20	45	40	35	30	25	20	15	10	5	0