Dividiendo con una recta numérica Nombre:

Usa la recta numérica para resolver cada problema. El primero ya está marcado como ejemplo.

1) $7 \div \frac{1}{5}$

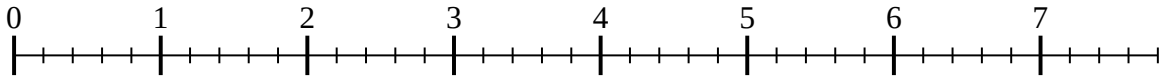

2) $6 \div \frac{1}{6}$

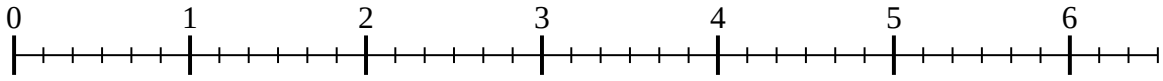

3) $6 \div \frac{1}{4}$

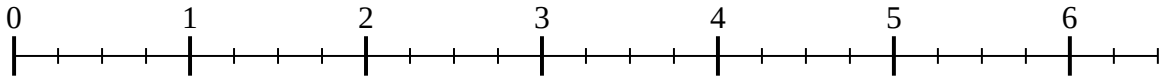

4) $6 \div \frac{1}{3}$

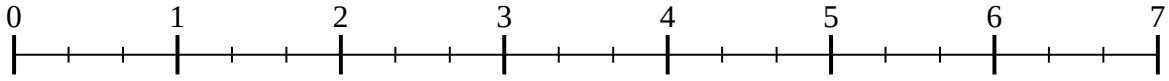

5) $7 \div \frac{1}{6}$

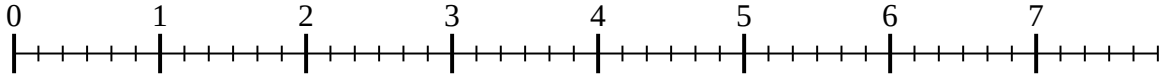

6) $2 \div \frac{1}{5}$

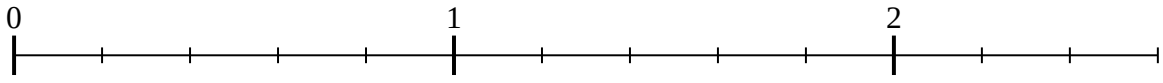

7) $4 \div \frac{1}{4}$

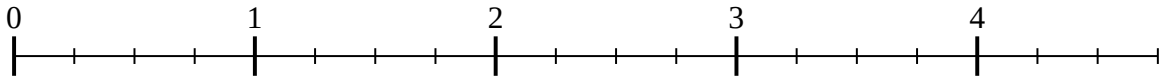

8) $2 \div \frac{1}{6}$

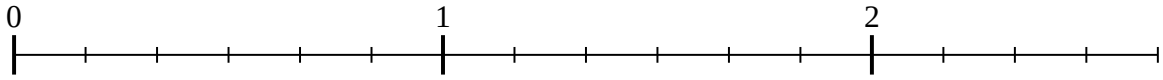

9) $5 \div \frac{1}{5}$

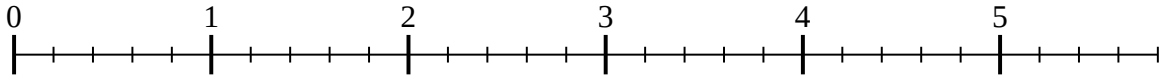

Respuestas

1. _____
2. _____
3. _____
4. _____
5. _____
6. _____
7. _____
8. _____
9. _____

1-9	89	78	67	56	44	33	22	11	0

Usa la recta numérica para resolver cada problema. El primero ya está marcado como ejemplo.

1) $7 \div \frac{1}{5}$

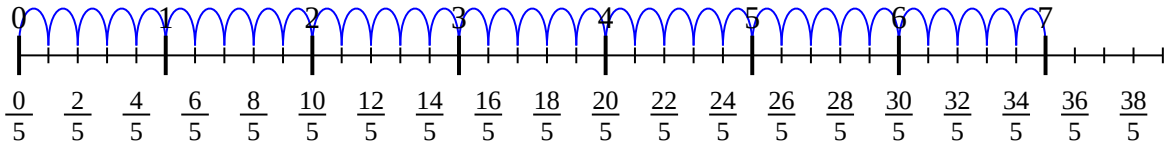

2) $6 \div \frac{1}{6}$

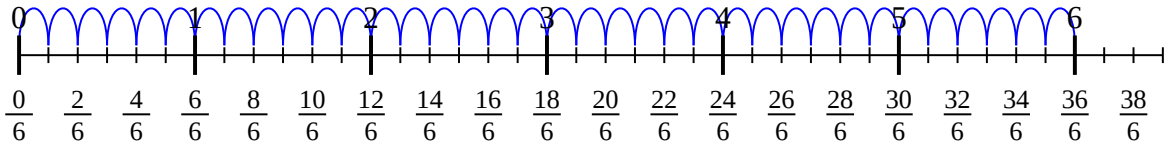

3) $6 \div \frac{1}{4}$

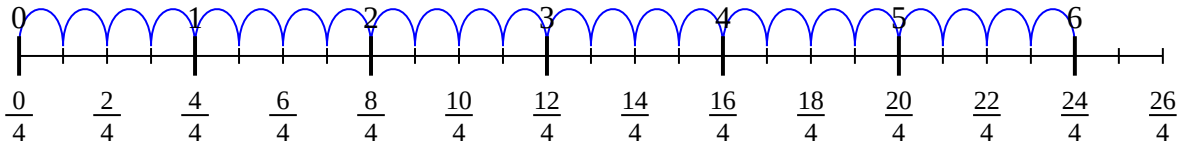

4) $6 \div \frac{1}{3}$

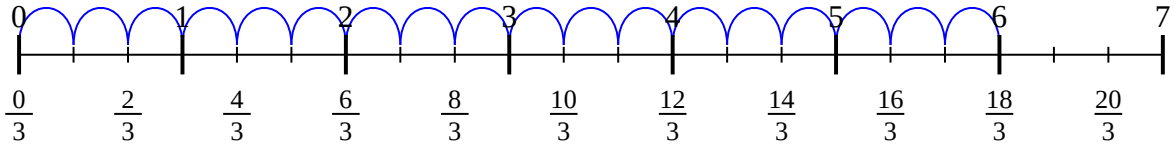

5) $7 \div \frac{1}{6}$

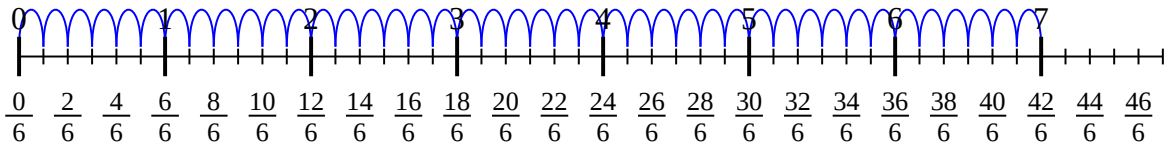

6) $2 \div \frac{1}{5}$

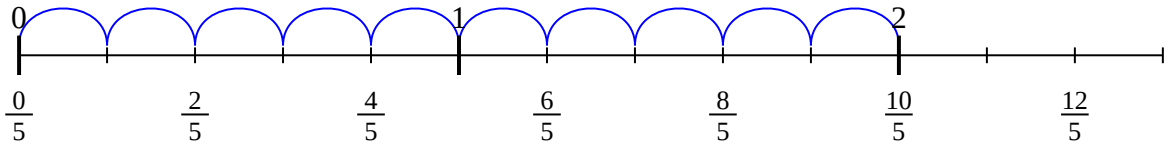

7) $4 \div \frac{1}{4}$

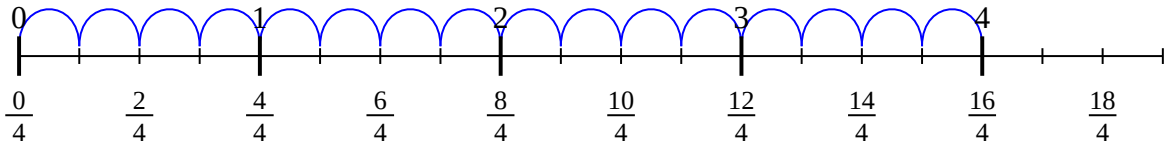

8) $2 \div \frac{1}{6}$

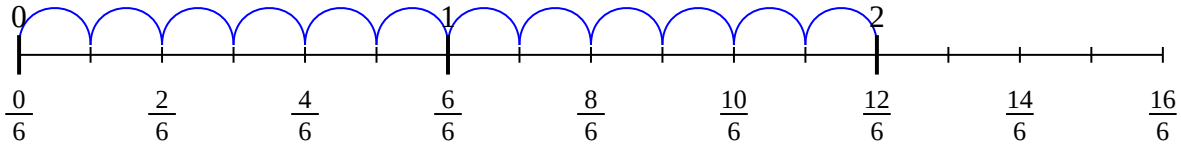

9) $5 \div \frac{1}{5}$

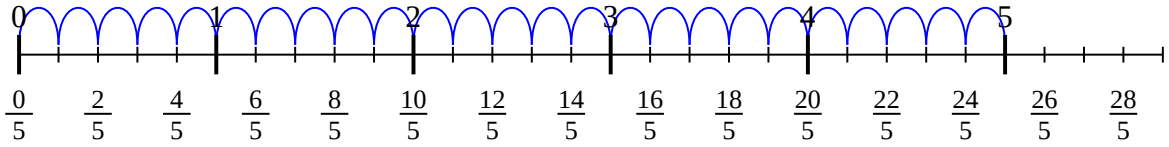

Respuestas

1. $\frac{35}{1}$
2. $\frac{36}{1}$
3. $\frac{24}{1}$
4. $\frac{18}{1}$
5. $\frac{42}{1}$
6. $\frac{10}{1}$
7. $\frac{16}{1}$
8. $\frac{12}{1}$
9. $\frac{25}{1}$

1-9	89	78	67	56	44	33	22	11	0

Dividiendo con una recta numérica Nombre:

Usa la recta numérica para resolver cada problema. El primero ya está marcado como ejemplo.

$^{10}/_{1}$	$^{25}/_{1}$	$^{18}/_{1}$	$^{36}/_{1}$
$^{12}/_{1}$	$^{16}/_{1}$	$^{35}/_{1}$	$^{42}/_{1}$
$^{24}/_{1}$			

1) $7 \div {}^{1}/_{5}$

2) $6 \div {}^{1}/_{6}$

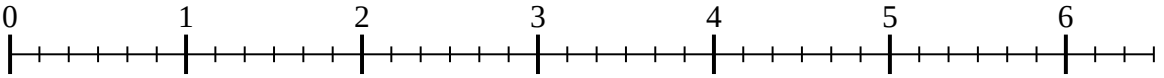

3) $6 \div {}^{1}/_{4}$

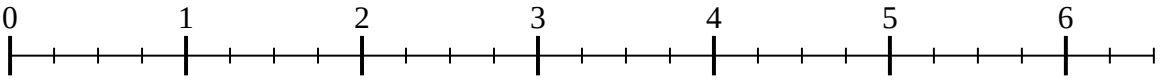

4) $6 \div {}^{1}/_{3}$

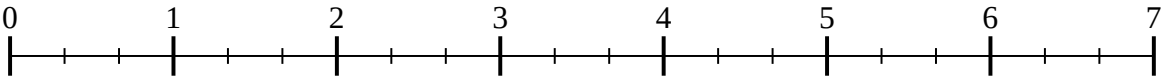

5) $7 \div {}^{1}/_{6}$

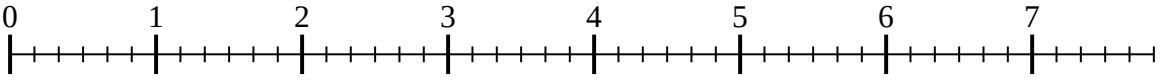

6) $2 \div {}^{1}/_{5}$



7) $4 \div {}^{1}/_{4}$

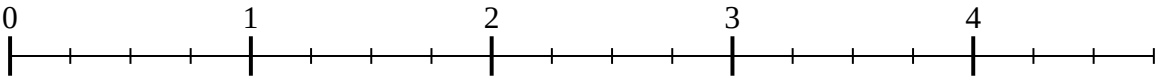

8) $2 \div {}^{1}/_{6}$

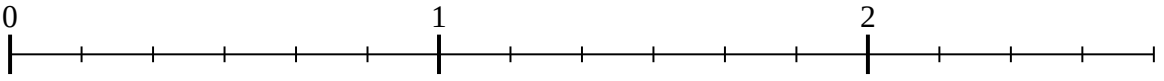

9) $5 \div {}^{1}/_{5}$

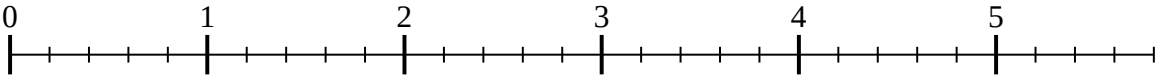

Respuestas

1. _____
2. _____
3. _____
4. _____
5. _____
6. _____
7. _____
8. _____
9. _____

1-9	89	78	67	56	44	33	22	11	0