Multiplicar fracciones con números enteros Nombre:

Usa los modelos visuales para resolver.

1) $\frac{1}{3} \times 7 =$

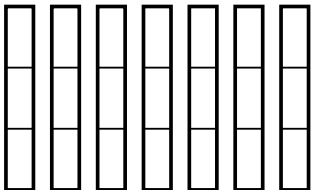

2) $\frac{5}{6} \times 6 =$

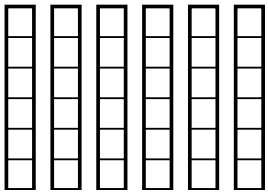

3) $\frac{9}{10} \times 4 =$

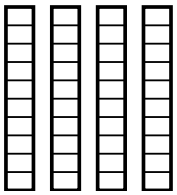

4) $\frac{7}{10} \times 9 =$

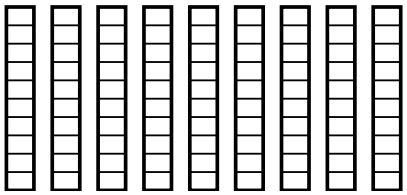

5) $\frac{2}{4} \times 6 =$

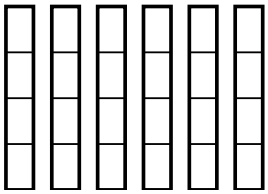

6) $\frac{3}{5} \times 3 =$

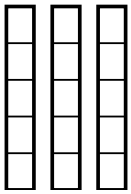

7) $\frac{2}{4} \times 5 =$

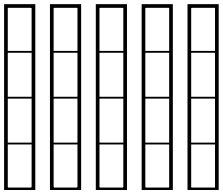

8) $\frac{3}{6} \times 7 =$

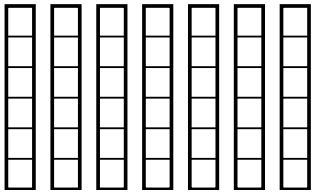

9) $\frac{1}{3} \times 5 =$

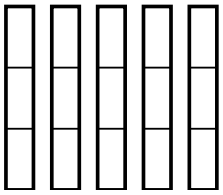

10) $\frac{1}{4} \times 2 =$

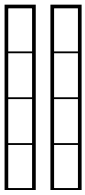

11) $\frac{3}{4} \times 5 =$

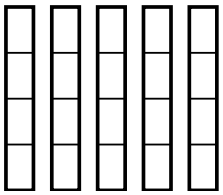

12) $\frac{1}{8} \times 8 =$

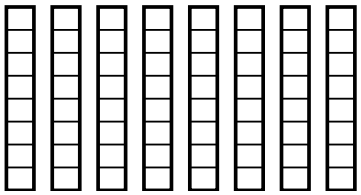

Respuestas

1. _____
2. _____
3. _____
4. _____
5. _____
6. _____
7. _____
8. _____
9. _____
10. _____
11. _____
12. _____

1-10	92	83	75	67	58	50	42	33	25	17
11-12	8	0								

Usa los modelos visuales para resolver.

1) $\frac{1}{3} \times 7 =$

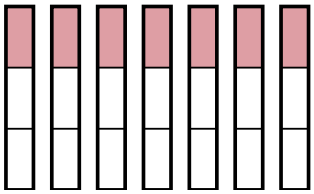

2) $\frac{5}{6} \times 6 =$

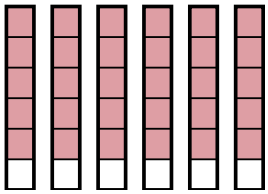

3) $\frac{9}{10} \times 4 =$

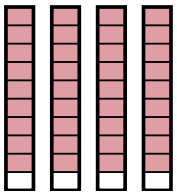

4) $\frac{7}{10} \times 9 =$

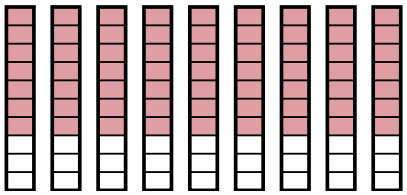

5) $\frac{2}{4} \times 6 =$

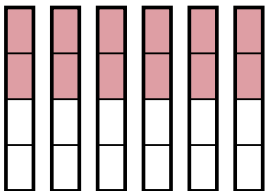

6) $\frac{3}{5} \times 3 =$

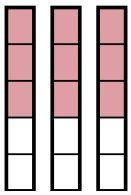

7) $\frac{2}{4} \times 5 =$

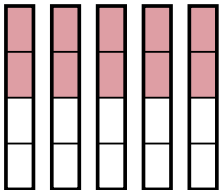

8) $\frac{3}{6} \times 7 =$

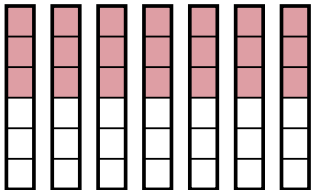

9) $\frac{1}{3} \times 5 =$

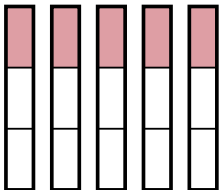

10) $\frac{1}{4} \times 2 =$

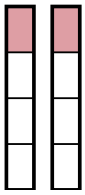

11) $\frac{3}{4} \times 5 =$

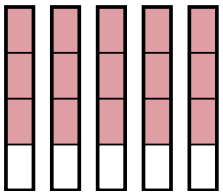

12) $\frac{1}{8} \times 8 =$

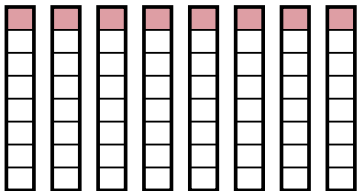

Respuestas

1. $\frac{7}{3}$
2. $\frac{30}{6}$
3. $\frac{36}{10}$
4. $\frac{63}{10}$
5. $\frac{12}{4}$
6. $\frac{9}{5}$
7. $\frac{10}{4}$
8. $\frac{21}{6}$
9. $\frac{5}{3}$
10. $\frac{2}{4}$
11. $\frac{15}{4}$
12. $\frac{8}{8}$

1-10	92	83	75	67	58	50	42	33	25	17
11-12	8	0								