Fracciones Impropias y Mixtas (Visual)

Nombre:

Escribe cada cantidad como un número mixto.

1)

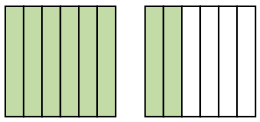

2)

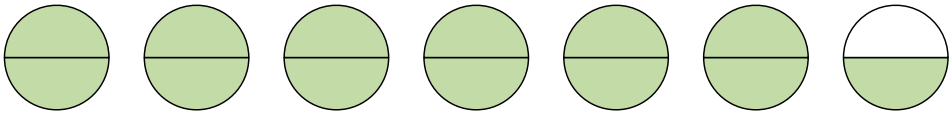

3)

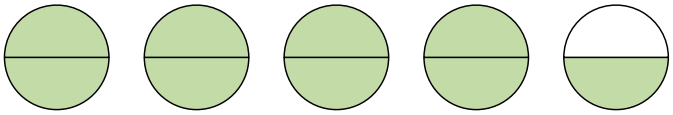

4)

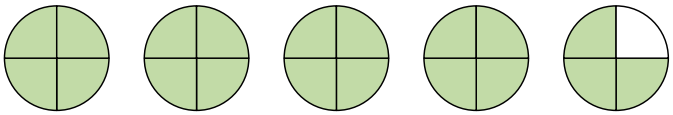

5)

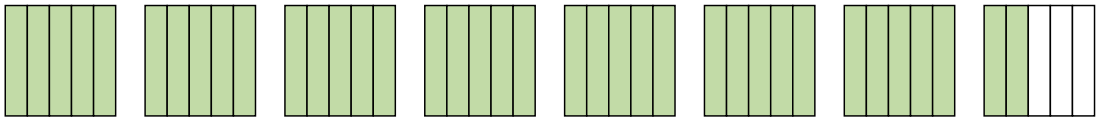

Escriba cada cantidad como una fracción impropia.

6)

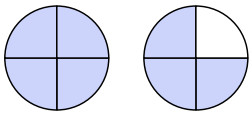

7)

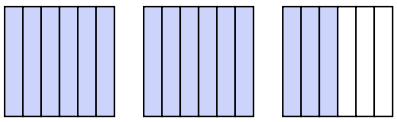

8)

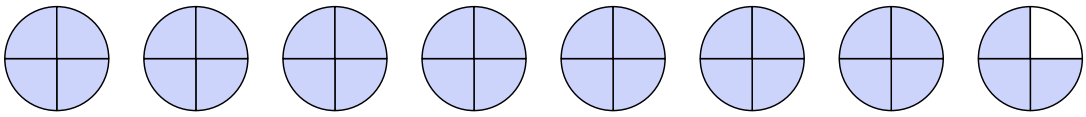

9)

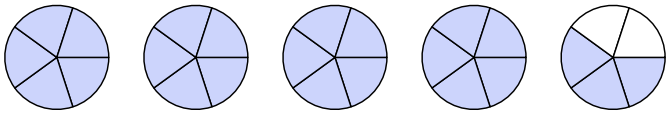

10)

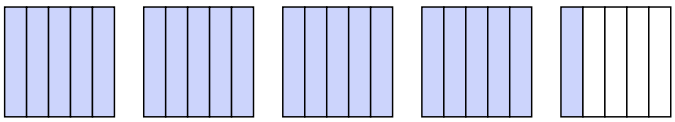

11)



Respuestas

1. _____
2. _____
3. _____
4. _____
5. _____
6. _____
7. _____
8. _____
9. _____
10. _____
11. _____

1-10	91	82	73	64	55	45	36	27	18	9
11	0									

Escribe cada cantidad como un número mixto.

1) 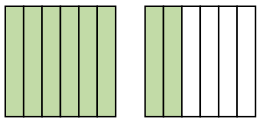

2) 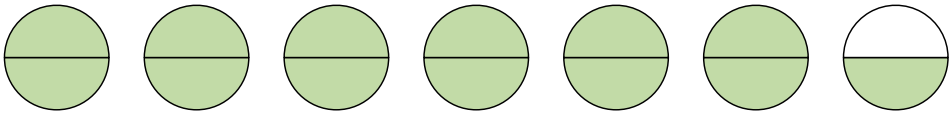

3) 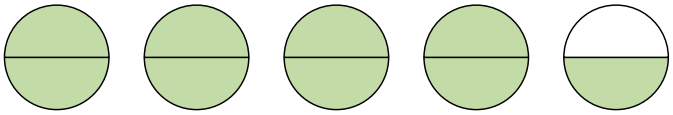

4) 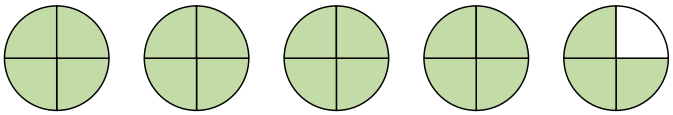

5) 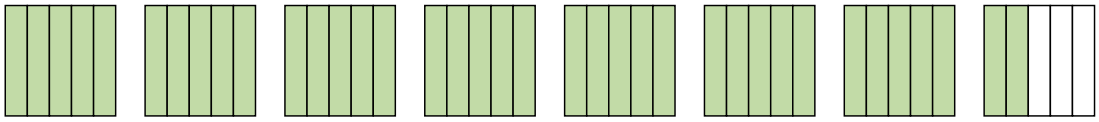

Escriba cada cantidad como una fracción impropia.

6) 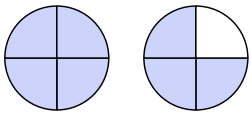

7) 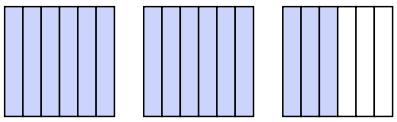

8) 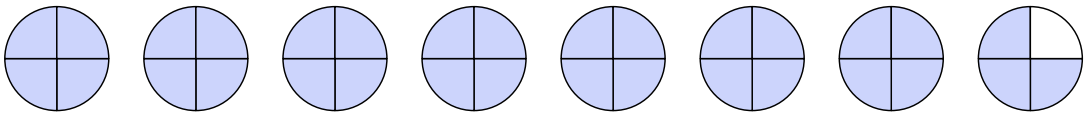

9) 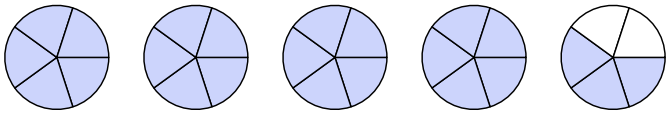

10) 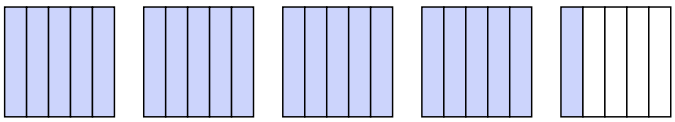

11) 

Respuestas

1. $1\frac{2}{6}$
2. $6\frac{1}{2}$
3. $4\frac{1}{2}$
4. $4\frac{3}{4}$
5. $7\frac{2}{5}$
6. $\frac{7}{4}$
7. $\frac{15}{6}$
8. $\frac{31}{4}$
9. $\frac{23}{5}$
10. $\frac{21}{5}$
11. $\frac{5}{2}$

1-10	91	82	73	64	55	45	36	27	18	9
11	0									