**Determina cuál opción(es) muestran la forma dividida para que cada pieza tenga un área igual. Si ninguna, escriba 'ninguna'.**

**1)** A.  B. 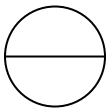 C.  D. 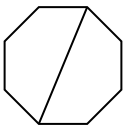

**2)** A. 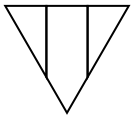 B. 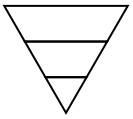 C. 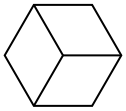 D. 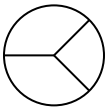

**3)** A. 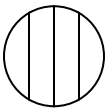 B.  C. 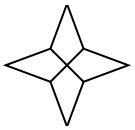 D. 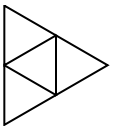

**4)** A. B. 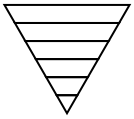 C. 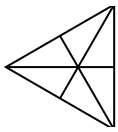 D. 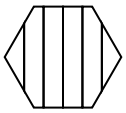

**5)** A. 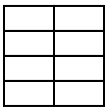 B. 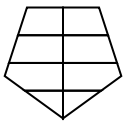 C. 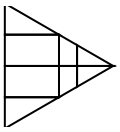 D. 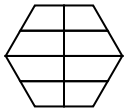

**6)** A. B. 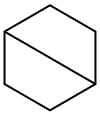 C. 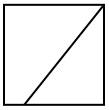 D. 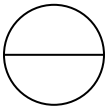

**7)** A. 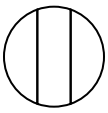 B. 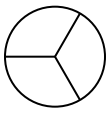 C.  D.

**8)** A. 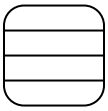 B. 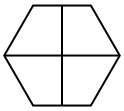 C.  D. 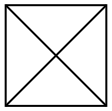

**Respuestas**

1. _____
2. _____
3. _____
4. _____
5. _____
6. _____
7. _____
8. _____



| 1-8 | 88 | 75 | 63 | 50 | 38 | 25 | 13 | 0 |
|---|---|---|---|---|---|---|---|---|

**Determina cuál opción(es) muestran la forma dividida para que cada pieza tenga un área igual. Si ninguna, escriba 'ninguna'.**

**1)** A.  B. 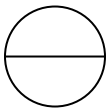 C.  D. 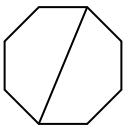

**2)** A. 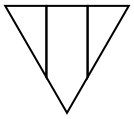 B. 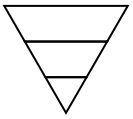 C. 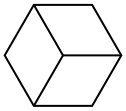 D. 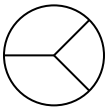

**3)** A. 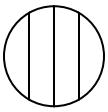 B.  C. 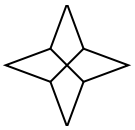 D. 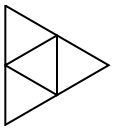

**4)** A. B. 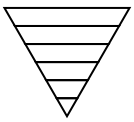 C. 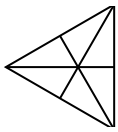 D. 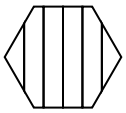

**5)** A. 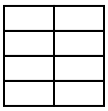 B. 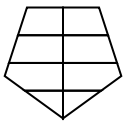 C. 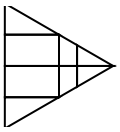 D. 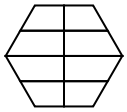

**6)** A. B. 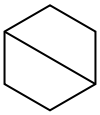 C. 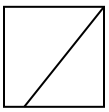 D. 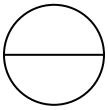

**7)** A. 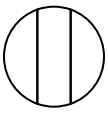 B. 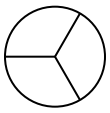 C.  D.

**8)** A. 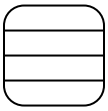 B. 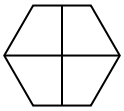 C.  D. 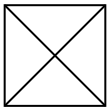

## Respuestas

1. **A,B,D**
2. **C**
3. **B,C,D**
4. **C**
5. **A**
6. **A,B,D**
7. **B,C**
8. **B,C,D**



| | | | | | | | | |
|---|---|---|---|---|---|---|---|---|
| 1-8 | 88 | 75 | 63 | 50 | 38 | 25 | 13 | 0 |