Identificando la Ubicación de Fracción, Positivo y negativo Nombre:

Marca cada ubicación descrita.

1) Marque la ubicación de $-1\frac{3}{5}$

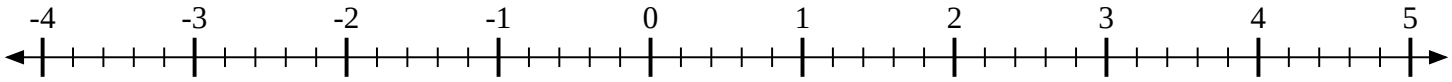

2) Marque la ubicación de $-3\frac{3}{7}$

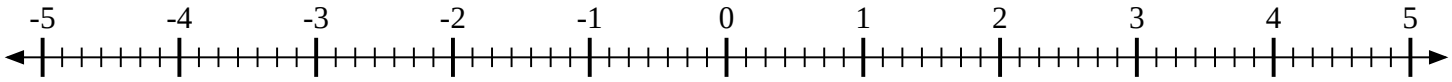

3) Marque la ubicación de $2\frac{1}{2}$

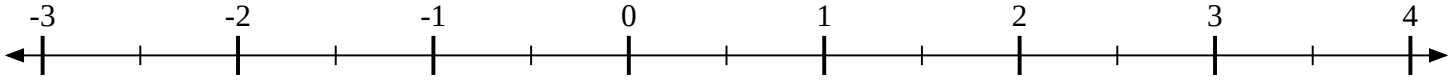

4) Marque la ubicación de $\frac{1}{2}$

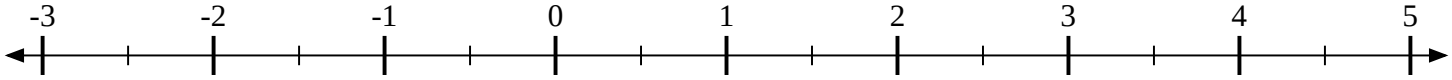

5) Marque la ubicación de $1\frac{2}{4}$

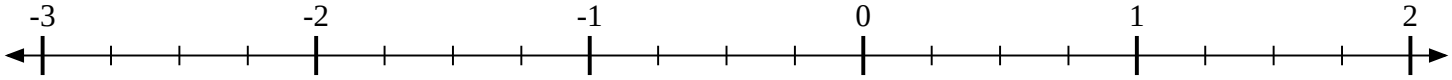

6) Marque la ubicación de $2\frac{2}{6}$

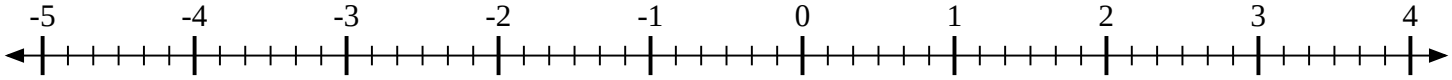

7) Marque la ubicación de $-4\frac{6}{7}$

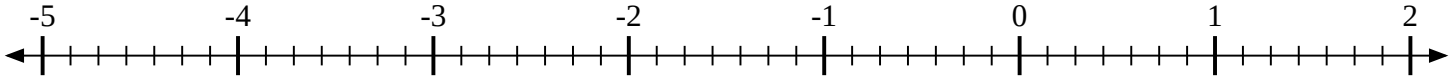

8) Marque la ubicación de $2\frac{3}{4}$

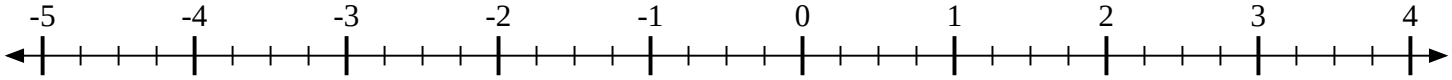

9) Marque la ubicación de $-3\frac{1}{3}$

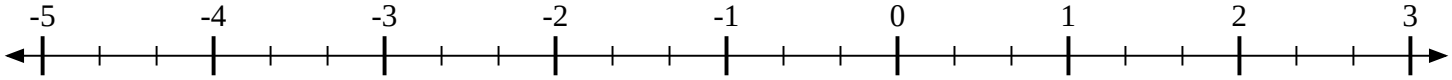

Identificando la Ubicación de Fracción, Positivo y negativo Nombre: **Clave De Respuestas**

Marca cada ubicación descrita.

1) Marque la ubicación de $-1\frac{3}{5}$

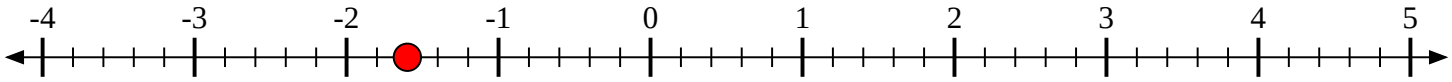

2) Marque la ubicación de $-3\frac{3}{7}$

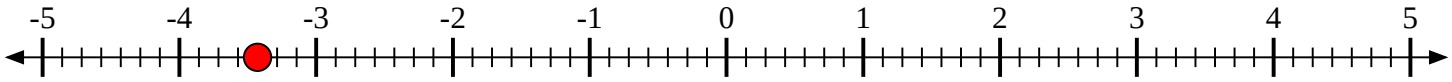

3) Marque la ubicación de $2\frac{1}{2}$

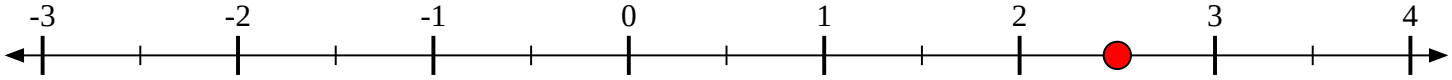

4) Marque la ubicación de $\frac{1}{2}$

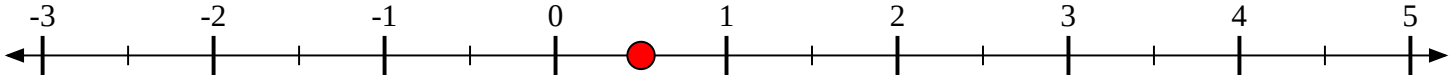

5) Marque la ubicación de $1\frac{2}{4}$

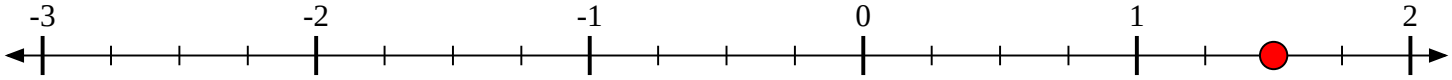

6) Marque la ubicación de $2\frac{2}{6}$

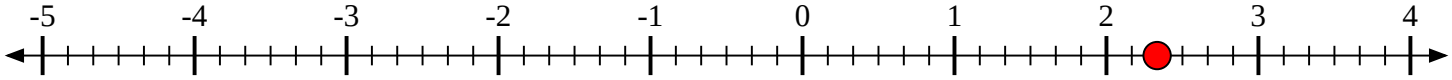

7) Marque la ubicación de $-4\frac{6}{7}$

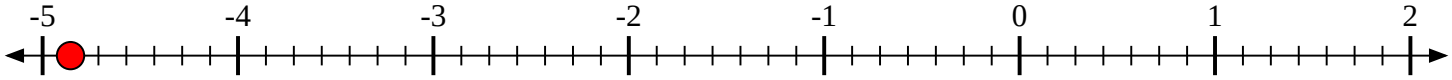

8) Marque la ubicación de $2\frac{3}{4}$

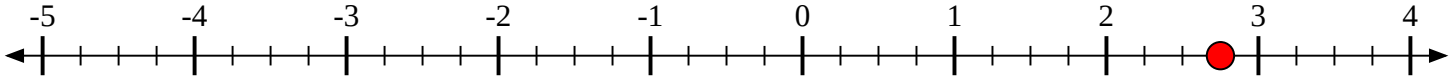
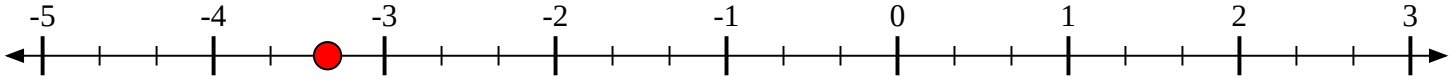
9) Marque la ubicación de $-3\frac{1}{3}$