Marca cada ubicación descrita.

1) Marque la ubicación de $3\frac{1}{4}$

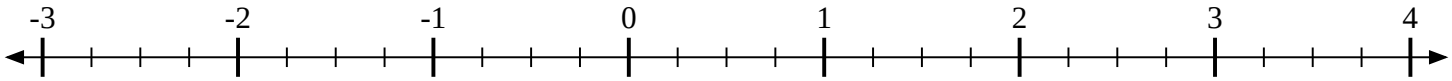

2) Marque la ubicación de $-1\frac{1}{2}$

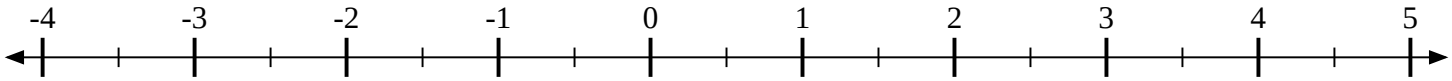

3) Marque la ubicación de $1\frac{1}{8}$

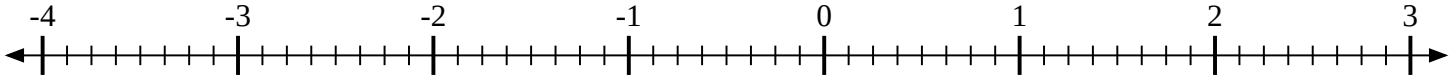

4) Marque la ubicación de $-1\frac{2}{4}$

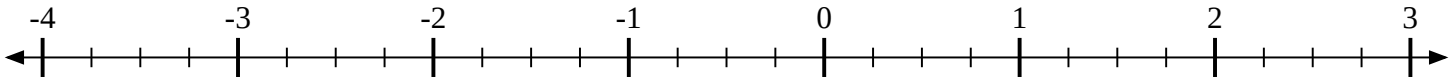

5) Marque la ubicación de $-2\frac{2}{6}$

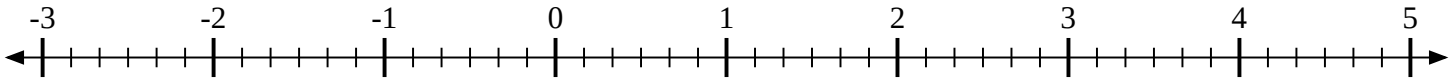

6) Marque la ubicación de $-1\frac{3}{6}$

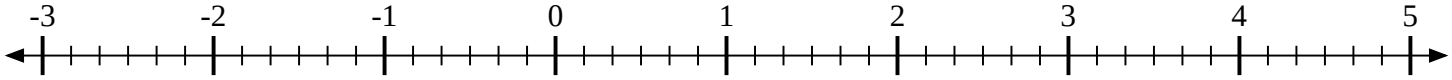

7) Marque la ubicación de $-1\frac{1}{4}$

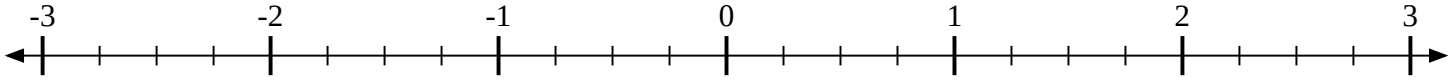

8) Marque la ubicación de $-4\frac{2}{3}$

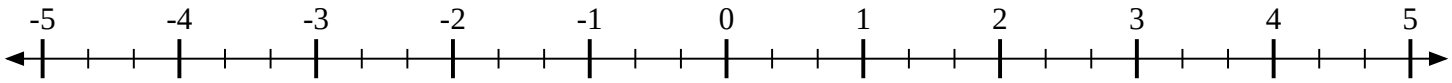

9) Marque la ubicación de $-2\frac{5}{8}$

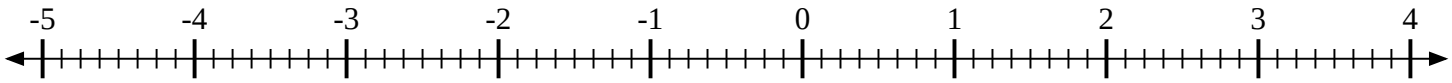

1-9	89	78	67	56	44	33	22	11	0

Marca cada ubicación descrita.

1) Marque la ubicación de $3\frac{1}{4}$

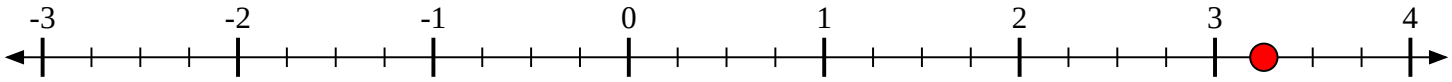

2) Marque la ubicación de $-1\frac{1}{2}$

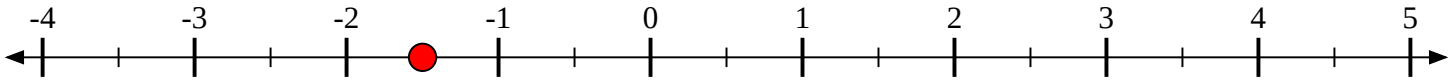

3) Marque la ubicación de $1\frac{1}{8}$

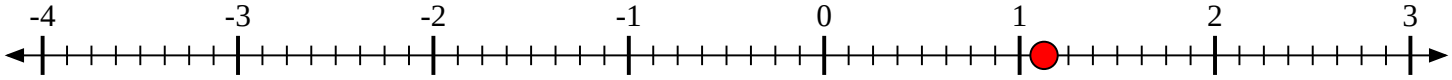

4) Marque la ubicación de $-1\frac{2}{4}$

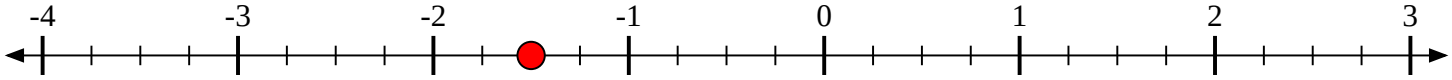

5) Marque la ubicación de $-2\frac{2}{6}$

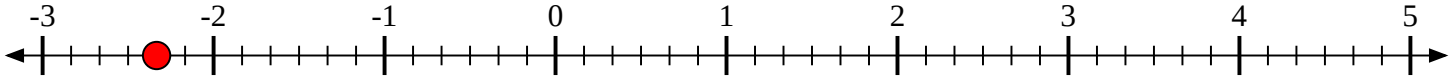

6) Marque la ubicación de $-1\frac{3}{6}$

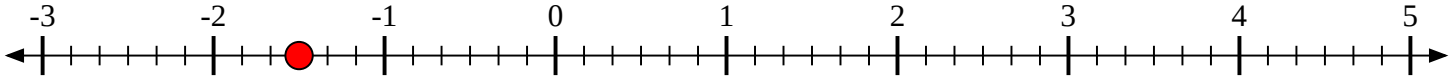

7) Marque la ubicación de $-1\frac{1}{4}$

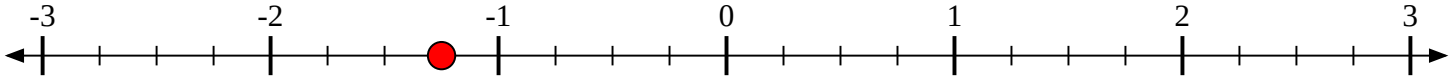

8) Marque la ubicación de $-4\frac{2}{3}$

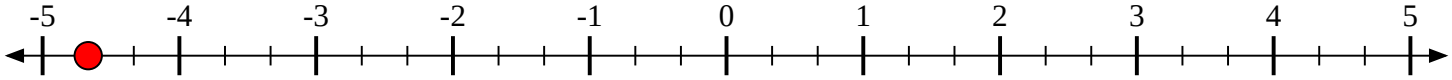

9) Marque la ubicación de $-2\frac{5}{8}$

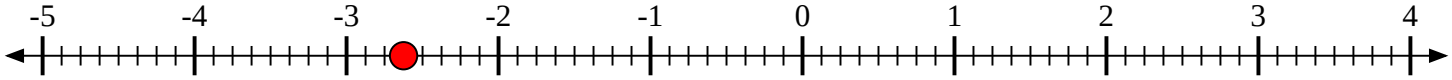

1-9	89	78	67	56	44	33	22	11	0