Encontrando fracciones equivalentes - Visualmente

Nombre:

Determina cuál letra mejor representa a una fracción equivalente.

1)

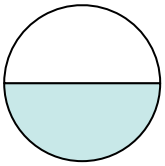

$\frac{1}{2}$

2)

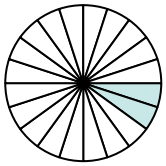

$\frac{2}{20}$

3)

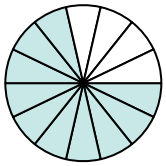

$\frac{10}{14}$

4)

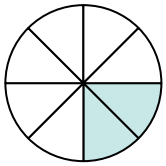

$\frac{2}{8}$

5)

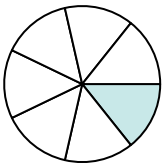

$\frac{1}{7}$

6)

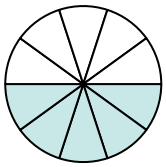

$\frac{5}{10}$

7)

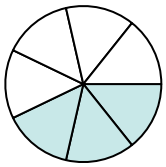

$\frac{3}{7}$

8)

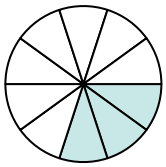

$\frac{3}{10}$

9)

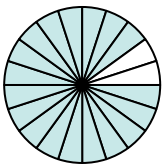

$\frac{18}{20}$

10)

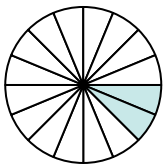

$\frac{2}{16}$

11)

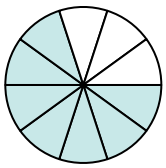

$\frac{7}{10}$

12)

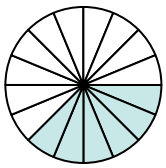

$\frac{6}{16}$

A.

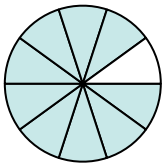

$\frac{9}{10}$

B.

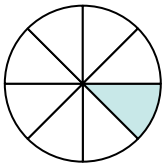

$\frac{1}{8}$

C.

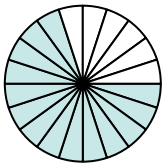

$\frac{14}{20}$

D.



$\frac{10}{20}$

E.

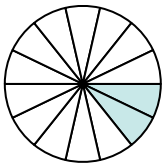

$\frac{2}{14}$

F.

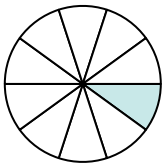

$\frac{1}{10}$

G.

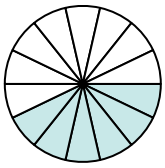

$\frac{6}{14}$

H.



$\frac{6}{20}$

I.

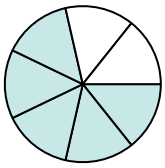

$\frac{5}{7}$

J.

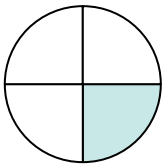

$\frac{1}{4}$

K.

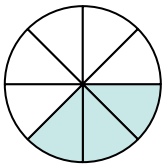

$\frac{3}{8}$

L.



$\frac{10}{20}$

Respuestas

1. _____
2. _____
3. _____
4. _____
5. _____
6. _____
7. _____
8. _____
9. _____
10. _____
11. _____
12. _____

1-10	92	83	75	67	58	50	42	33	25	17
11-12	8	0								

Encontrando fracciones equivalentes - Visualmente

Nombre: **Clave De Respuestas**

Determina cuál letra mejor representa a una fracción equivalente.

1)

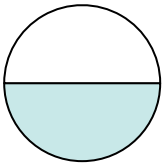

$\frac{1}{2}$

2)

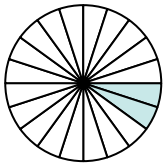

$\frac{2}{20}$

3)

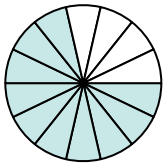

$\frac{10}{14}$

4)

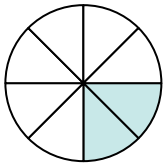

$\frac{2}{8}$

5)

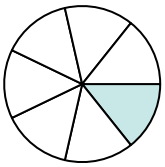

$\frac{1}{7}$

6)

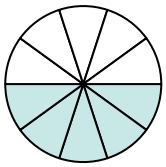

$\frac{5}{10}$

7)

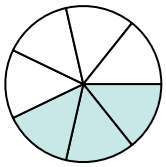

$\frac{3}{7}$

8)

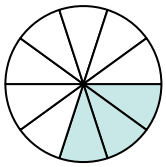

$\frac{3}{10}$

9)

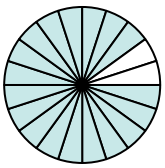

$\frac{18}{20}$

10)

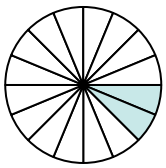

$\frac{2}{16}$

11)

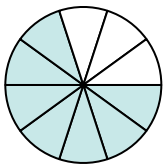

$\frac{7}{10}$

12)

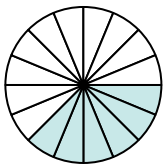

$\frac{6}{16}$

A.

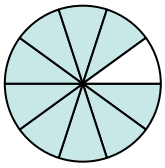

$\frac{9}{10}$

B.

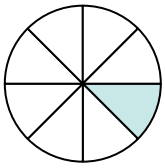

$\frac{1}{8}$

C.

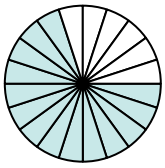

$\frac{14}{20}$

D.



$\frac{10}{20}$

E.

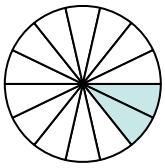

$\frac{2}{14}$

F.

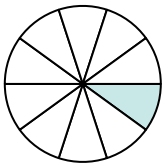

$\frac{1}{10}$

G.

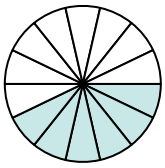

$\frac{6}{14}$

H.



$\frac{6}{20}$

I.

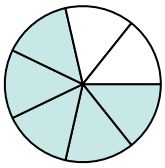

$\frac{5}{7}$

J.

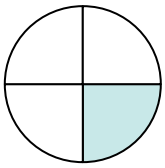

$\frac{1}{4}$

K.

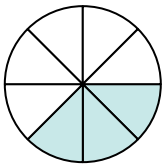

$\frac{3}{8}$

L.



$\frac{10}{20}$

Respuestas

1. L
2. F
3. I
4. J
5. E
6. D
7. G
8. H
9. A
10. B
11. C
12. K

1-10	92	83	75	67	58	50	42	33	25	17
11-12	8	0								