Encontrando fracciones equivalentes - Visualmente

Nombre:

Determina cuál letra mejor representa a una fracción equivalente.

1)

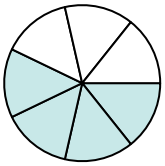

$\frac{4}{7}$

2)

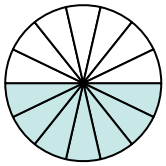

$\frac{7}{14}$

3)

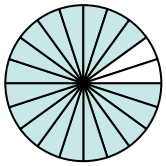

$\frac{18}{20}$

4)

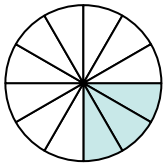

$\frac{3}{12}$

5)

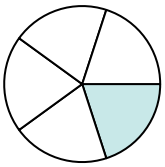

$\frac{1}{5}$

6)

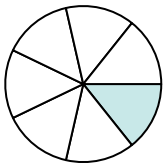

$\frac{1}{7}$

7)

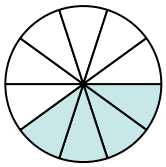

$\frac{4}{10}$

8)

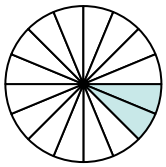

$\frac{2}{16}$

9)

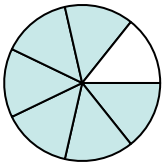

$\frac{6}{7}$

10)

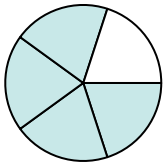

$\frac{4}{5}$

11)

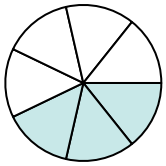

$\frac{3}{7}$

12)

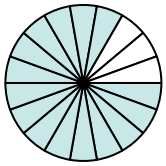

$\frac{15}{18}$

A.

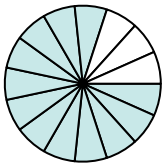

$\frac{12}{15}$

B.

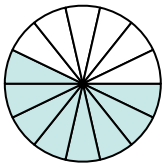

$\frac{8}{14}$

C.

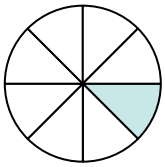

$\frac{1}{8}$

D.

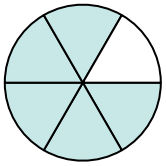

$\frac{5}{6}$

E.

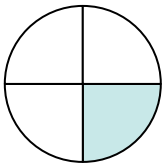

$\frac{1}{4}$

F.

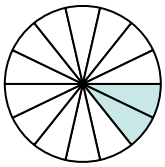

$\frac{2}{14}$

G.

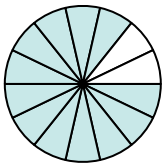

$\frac{12}{14}$

H.

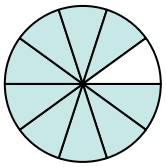

$\frac{9}{10}$

I.

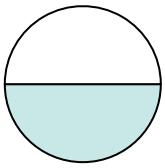

$\frac{1}{2}$

J.

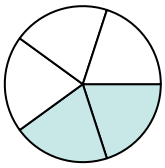

$\frac{2}{5}$

K.

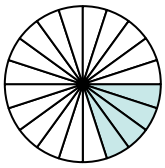

$\frac{4}{20}$

L.

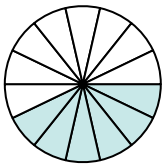

$\frac{6}{14}$

Respuestas

1. _____
2. _____
3. _____
4. _____
5. _____
6. _____
7. _____
8. _____
9. _____
10. _____
11. _____
12. _____

1-10	92	83	75	67	58	50	42	33	25	17
11-12	8	0								

Encontrando fracciones equivalentes - Visualmente

Nombre: **Clave De Respuestas**

Determina cuál letra mejor representa a una fracción equivalente.

1)

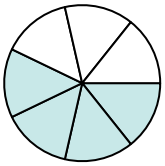

$\frac{4}{7}$

2)

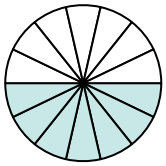

$\frac{7}{14}$

3)

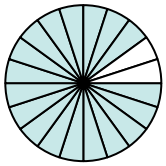

$\frac{18}{20}$

4)

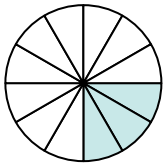

$\frac{3}{12}$

5)

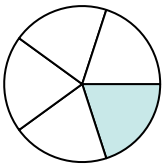

$\frac{1}{5}$

6)

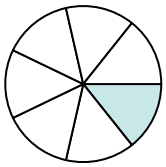

$\frac{1}{7}$

7)

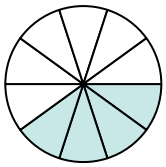

$\frac{4}{10}$

8)

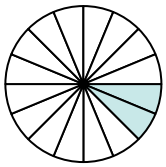

$\frac{2}{16}$

9)

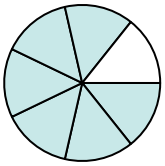

$\frac{6}{7}$

10)

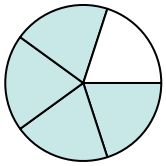

$\frac{4}{5}$

11)

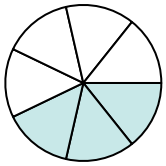

$\frac{3}{7}$

12)

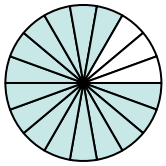

$\frac{15}{18}$

A.

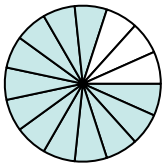

$\frac{12}{15}$

B.

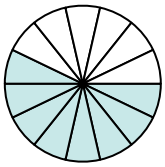

$\frac{8}{14}$

C.

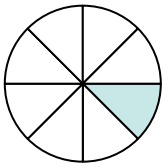

$\frac{1}{8}$

D.

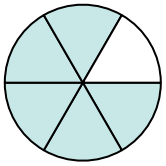

$\frac{5}{6}$

E.

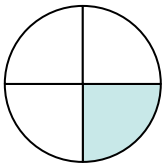

$\frac{1}{4}$

F.

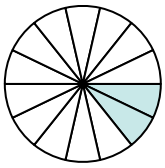

$\frac{2}{14}$

G.

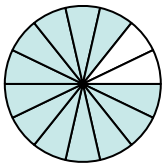

$\frac{12}{14}$

H.

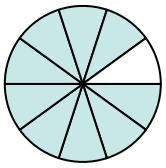

$\frac{9}{10}$

I.

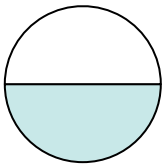

$\frac{1}{2}$

J.

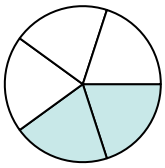

$\frac{2}{5}$

K.

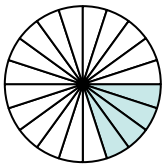

$\frac{4}{20}$

L.

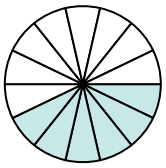

$\frac{6}{14}$

Respuestas

1. B
2. I
3. H
4. E
5. K
6. F
7. J
8. C
9. G
10. A
11. L
12. D

1-10	92	83	75	67	58	50	42	33	25	17
11-12	8	0								