Expresar fracciones numéricamente

Nombre:

Escribe la cantidad sombreada como una fracción.

Ej)

1)



2)

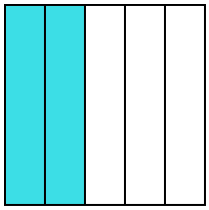

3)



4)

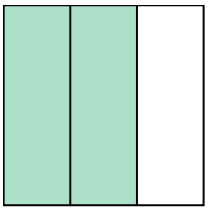

5)

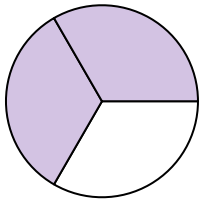

6)

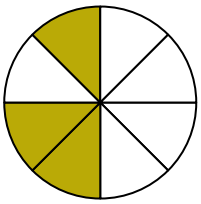

7)

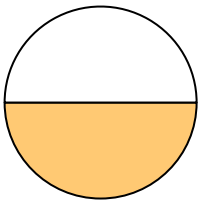

8)

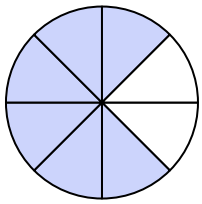

9)



10)

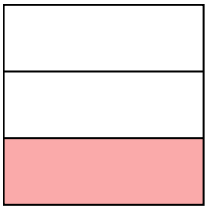

11)



12)



13)

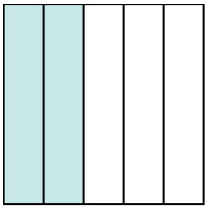

14)

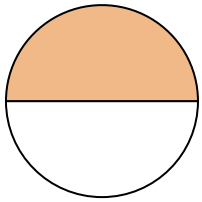

Respuestas

Ej. $\frac{1}{4}$

1. _____
2. _____
3. _____
4. _____
5. _____
6. _____
7. _____
8. _____
9. _____
10. _____
11. _____
12. _____
13. _____
14. _____

1-10	93	86	79	71	64	57	50	43	36	29
11-14	21	14	7	0						

Expresar fracciones numéricamente

Nombre: **Clave De Respuestas**

Escribe la cantidad sombreada como una fracción.

Ej)

1)



2)

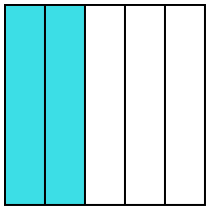

3)



4)

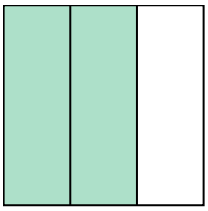

5)

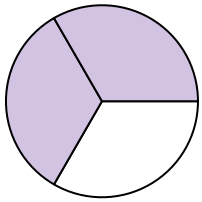

6)

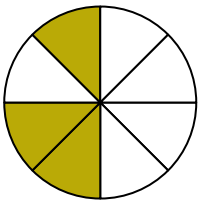

7)

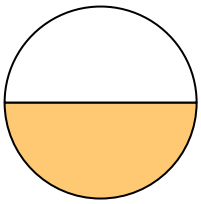

8)

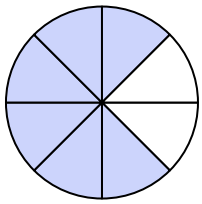

9)



10)

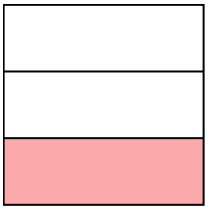

11)



12)



13)

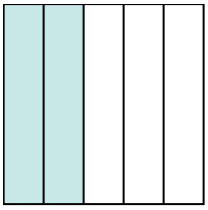

14)

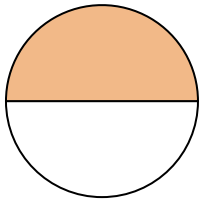

Respuestas

Ej.	1/4
1.	2/4
2.	2/5
3.	6/8
4.	2/3
5.	2/3
6.	3/8
7.	1/2
8.	6/8
9.	4/4
10.	1/3
11.	5/5
12.	1/2
13.	2/5
14.	1/2

1-10	93	86	79	71	64	57	50	43	36	29
11-14	21	14	7	0						

Expresar fracciones numéricamente Nombre:

Escribe la cantidad sombreada como una fracción.

Ej)

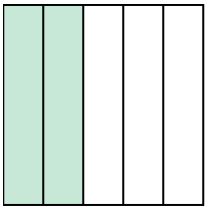

1)



2)

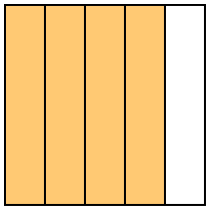

3)

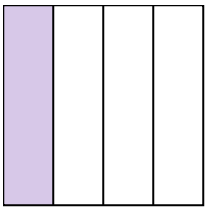

4)



5)

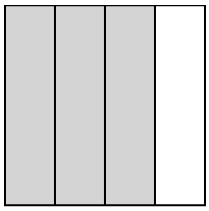

6)

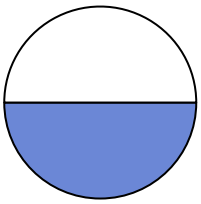

7)

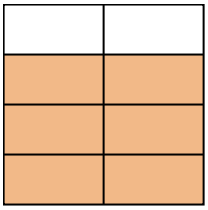

8)

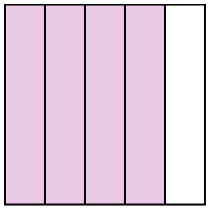

9)

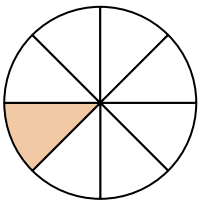

10)

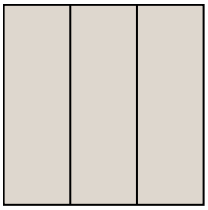

11)



12)



13)

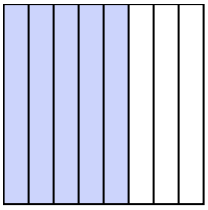

14)



Respuestas

Ej. $\frac{2}{5}$

1. _____
2. _____
3. _____
4. _____
5. _____
6. _____
7. _____
8. _____
9. _____
10. _____
11. _____
12. _____
13. _____
14. _____

1-10	93	86	79	71	64	57	50	43	36	29
11-14	21	14	7	0						

Escribe la cantidad sombreada como una fracción.

Ej) 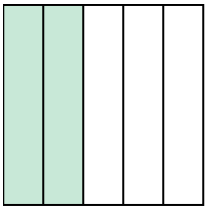

1) 

2) 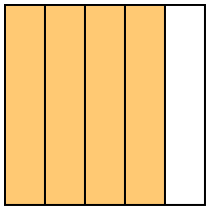

3) 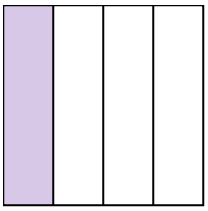

4) 

5) 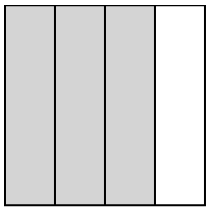

6) 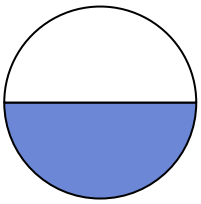

7) 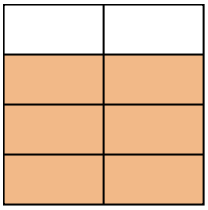

8) 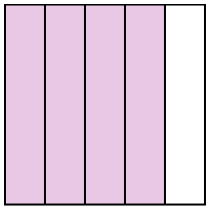

9) 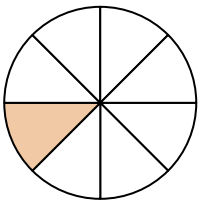

10) 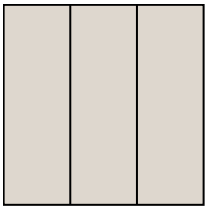

11) 

12) 

13) 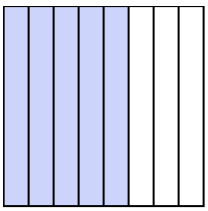

14) 

Respuestas

Ej.	2/5
1.	2/2
2.	4/5
3.	1/4
4.	1/2
5.	3/4
6.	1/2
7.	6/8
8.	4/5
9.	1/8
10.	3/3
11.	1/3
12.	2/4
13.	5/8
14.	1/3

1-10	93	86	79	71	64	57	50	43	36	29
11-14	21	14	7	0						

Expresar fracciones numéricamente Nombre:

Escribe la cantidad sombreada como una fracción.

Ej)

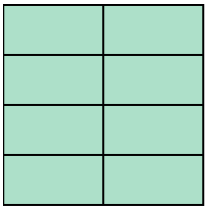

1)



2)

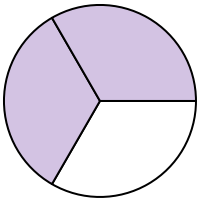

3)

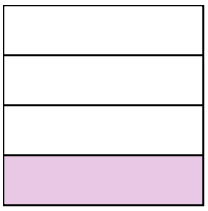

4)

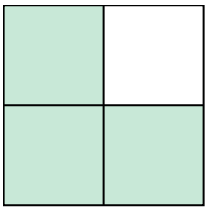

5)



6)

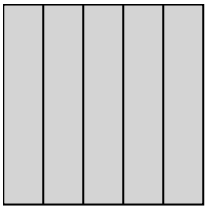

7)

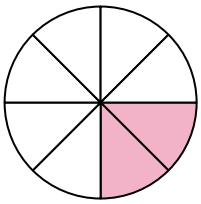

8)



9)



10)

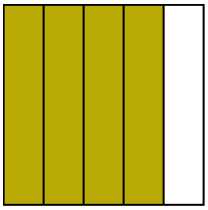

11)

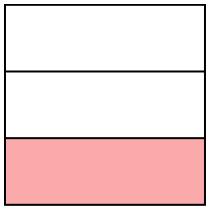

12)



13)



14)



Respuestas

Ej. $\frac{8}{8}$

1. _____
2. _____
3. _____
4. _____
5. _____
6. _____
7. _____
8. _____
9. _____
10. _____
11. _____
12. _____
13. _____
14. _____

1-10	93	86	79	71	64	57	50	43	36	29
11-14	21	14	7	0						

Expresar fracciones numéricamente

Nombre: **Clave De Respuestas**

Escribe la cantidad sombreada como una fracción.

Ej)

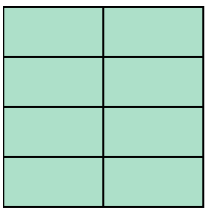

1)



2)

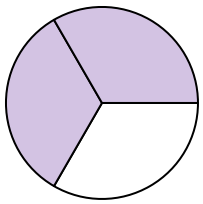

3)

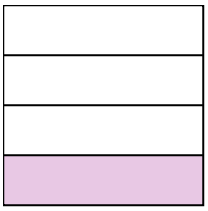

4)

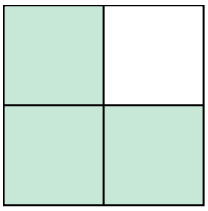

5)



6)

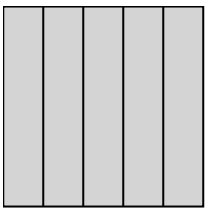

7)

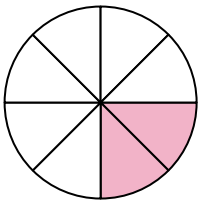

8)



9)



10)

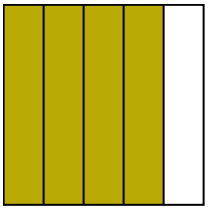

11)

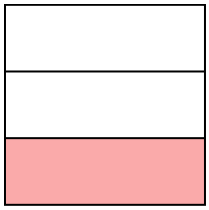

12)



13)



14)



Respuestas

Ej.	8/8
1.	2/2
2.	2/3
3.	1/4
4.	3/4
5.	2/2
6.	5/5
7.	2/8
8.	1/4
9.	3/8
10.	4/5
11.	1/3
12.	1/5
13.	2/2
14.	3/3

1-10	93	86	79	71	64	57	50	43	36	29
11-14	21	14	7	0						

Expresar fracciones numéricamente Nombre:

Escribe la cantidad sombreada como una fracción.

Ej)



1)



2)



3)



4)

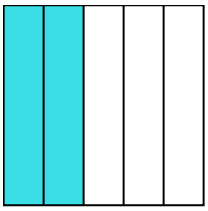

5)

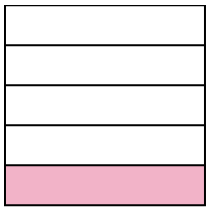

6)

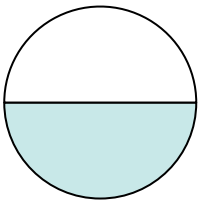

7)



8)

9)



10)

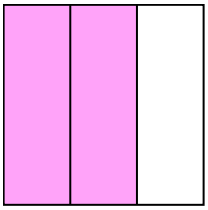

11)

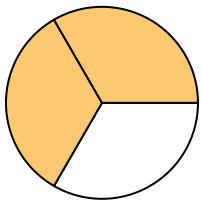

12)



13)

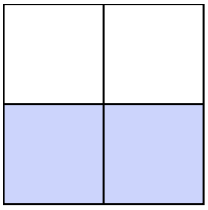

14)

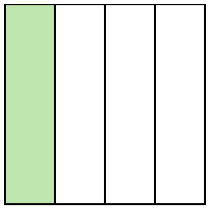

Respuestas

Ej. $\frac{4}{8}$

1. _____
2. _____
3. _____
4. _____
5. _____
6. _____
7. _____
8. _____
9. _____
10. _____
11. _____
12. _____
13. _____
14. _____

1-10	93	86	79	71	64	57	50	43	36	29
11-14	21	14	7	0						

Escribe la cantidad sombreada como una fracción.

Ej)



1)



2)



3)



4)

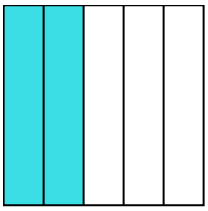

5)

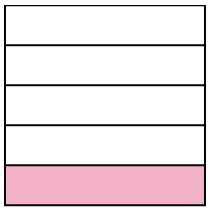

6)

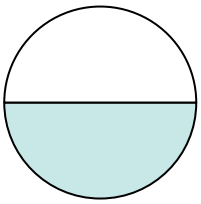

7)



8)

9)



10)

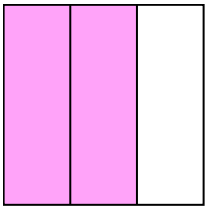

11)

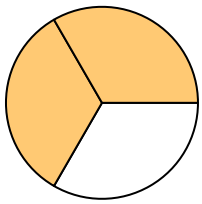

12)



13)

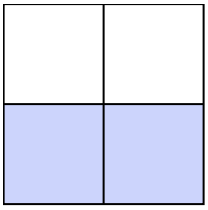

14)

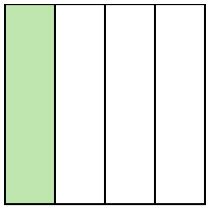

Respuestas

Ej.	$\frac{4}{8}$
1.	$\frac{2}{8}$
2.	$\frac{1}{2}$
3.	$\frac{1}{3}$
4.	$\frac{2}{5}$
5.	$\frac{1}{5}$
6.	$\frac{1}{2}$
7.	$\frac{1}{8}$
8.	$\frac{1}{5}$
9.	$\frac{4}{4}$
10.	$\frac{2}{3}$
11.	$\frac{2}{3}$
12.	$\frac{1}{2}$
13.	$\frac{2}{4}$
14.	$\frac{1}{4}$

1-10	93	86	79	71	64	57	50	43	36	29
11-14	21	14	7	0						

Expresar fracciones numéricamente

Nombre:

Escribe la cantidad sombreada como una fracción.

Ej)



1)

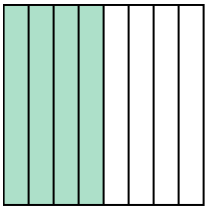

2)

3)



4)

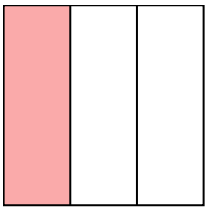

5)



6)

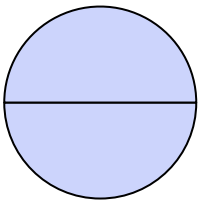

7)

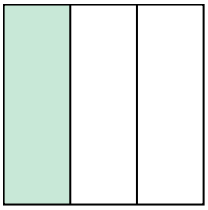

8)

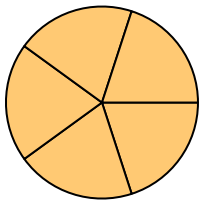

9)

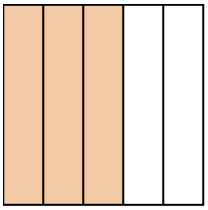

10)

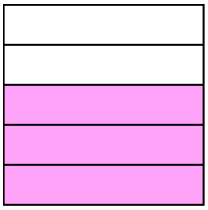

11)

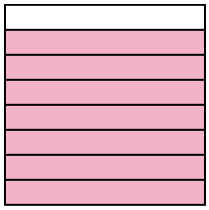

12)



13)

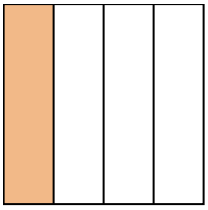

14)

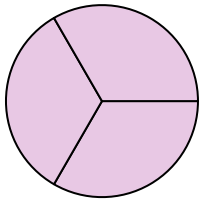

Respuestas

Ej. $\frac{1}{2}$

1. _____
2. _____
3. _____
4. _____
5. _____
6. _____
7. _____
8. _____
9. _____
10. _____
11. _____
12. _____
13. _____
14. _____

1-10	93	86	79	71	64	57	50	43	36	29
11-14	21	14	7	0						

Escribe la cantidad sombreada como una fracción.

Ej)



1)

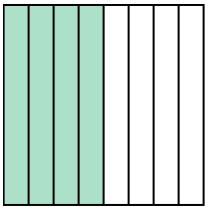

2)

3)



4)

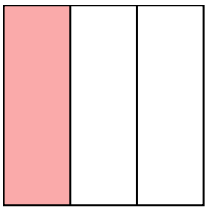

5)



6)

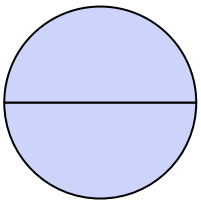

7)

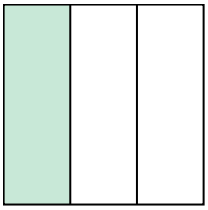

8)

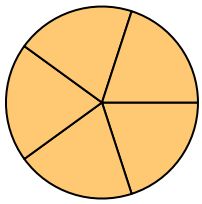

9)

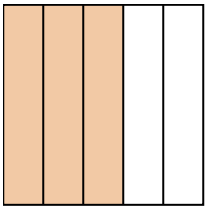

10)

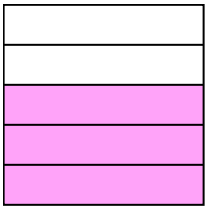

11)

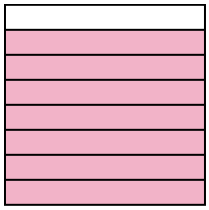

12)



13)

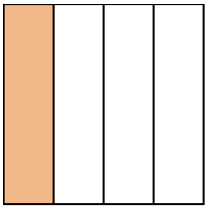

14)

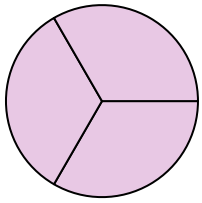

Respuestas

Ej.	1/2
1.	4/8
2.	6/8
3.	1/4
4.	1/3
5.	1/2
6.	2/2
7.	1/3
8.	5/5
9.	3/5
10.	3/5
11.	7/8
12.	4/4
13.	1/4
14.	3/3

1-10	93	86	79	71	64	57	50	43	36	29
11-14	21	14	7	0						

Expresar fracciones numéricamente Nombre:

Escribe la cantidad sombreada como una fracción.

Ej)

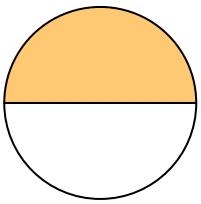

1)



2)

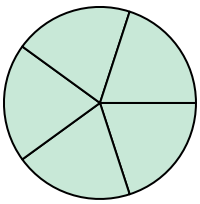

3)

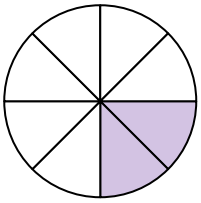

4)



5)



6)

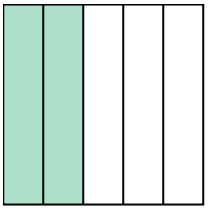

7)



8)



9)



10)



11)



12)

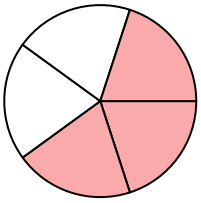

13)



14)

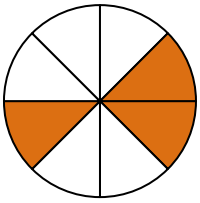

Respuestas

Ej. $\frac{1}{2}$

1. _____
2. _____
3. _____
4. _____
5. _____
6. _____
7. _____
8. _____
9. _____
10. _____
11. _____
12. _____
13. _____
14. _____

1-10	93	86	79	71	64	57	50	43	36	29
11-14	21	14	7	0						

Escribe la cantidad sombreada como una fracción.

Ej)

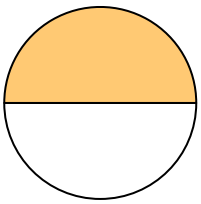

1)



2)

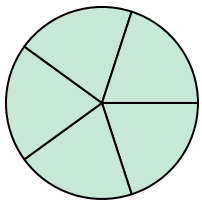

3)

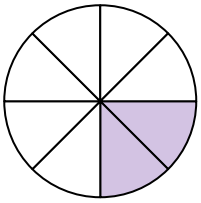

4)



5)



6)

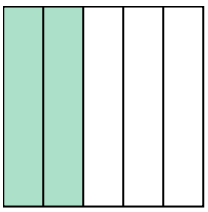

7)

8)



9)



10)



11)



12)

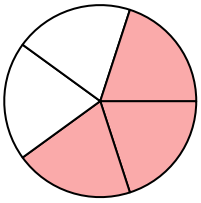

13)



14)

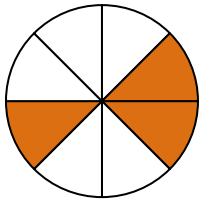

Respuestas

Ej.	1/2
1.	3/3
2.	5/5
3.	2/8
4.	3/3
5.	1/8
6.	2/5
7.	4/4
8.	3/4
9.	2/2
10.	4/4
11.	3/3
12.	3/5
13.	1/2
14.	3/8

1-10	93	86	79	71	64	57	50	43	36	29
11-14	21	14	7	0						

Expresar fracciones numéricamente

Nombre:

Escribe la cantidad sombreada como una fracción.

Ej)

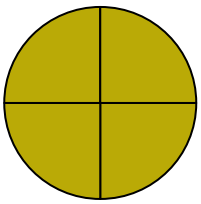

1)



2)

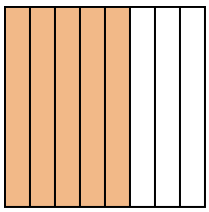

3)

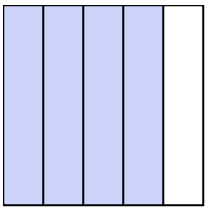

4)

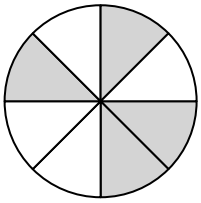

5)

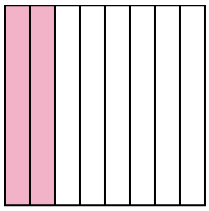

6)



7)

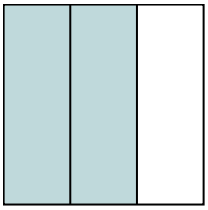

8)



9)

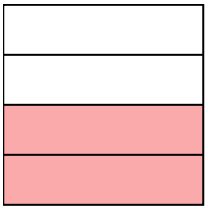

10)



11)

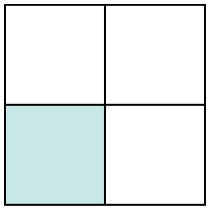

12)



13)



14)



Respuestas

Ej. 4/4

1. _____
2. _____
3. _____
4. _____
5. _____
6. _____
7. _____
8. _____
9. _____
10. _____
11. _____
12. _____
13. _____
14. _____

1-10	93	86	79	71	64	57	50	43	36	29
11-14	21	14	7	0						

Escribe la cantidad sombreada como una fracción.

Ej)

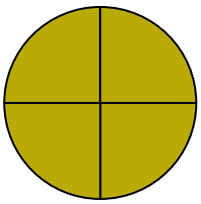

1)



2)

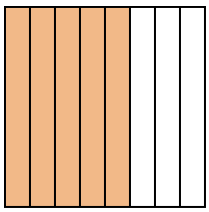

3)

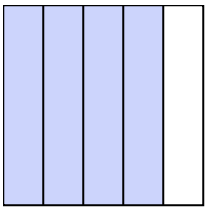

4)

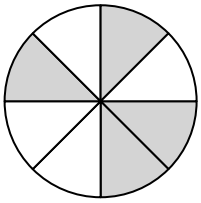

5)

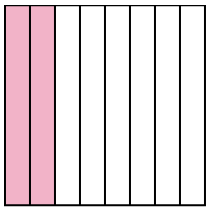

6)



7)

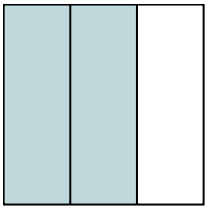

8)



9)

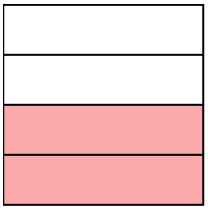

10)



11)

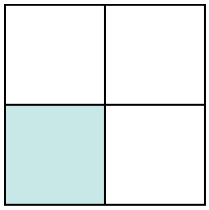

12)



13)

14)



Respuestas

Ej.	4/4
1.	1/3
2.	5/8
3.	4/5
4.	4/8
5.	2/8
6.	1/2
7.	2/3
8.	5/5
9.	2/4
10.	1/2
11.	1/4
12.	2/2
13.	1/5
14.	1/3

1-10	93	86	79	71	64	57	50	43	36	29
11-14	21	14	7	0						

Expresar fracciones numéricamente Nombre:

Escribe la cantidad sombreada como una fracción.

Ej)

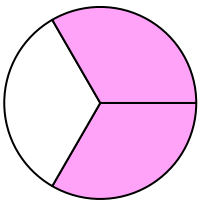

1)

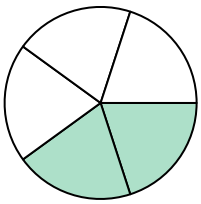

2)

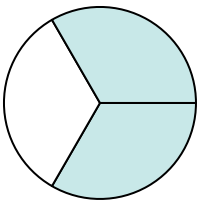

3)

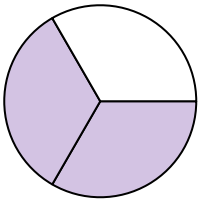

4)

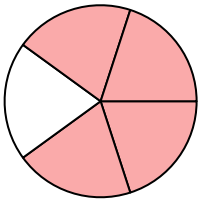

5)



6)



7)



8)

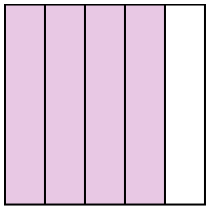

9)

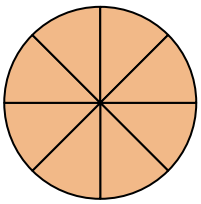

10)

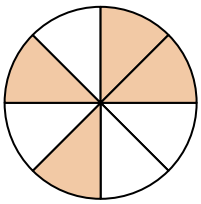

11)



12)

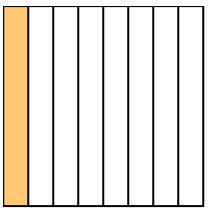

13)

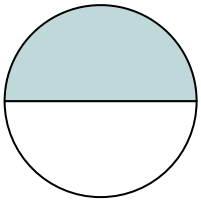

14)

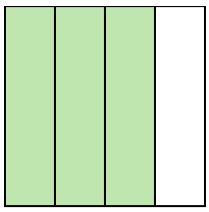

Respuestas

Ej. $\frac{2}{3}$

1. _____
2. _____
3. _____
4. _____
5. _____
6. _____
7. _____
8. _____
9. _____
10. _____
11. _____
12. _____
13. _____
14. _____

1-10	93	86	79	71	64	57	50	43	36	29
11-14	21	14	7	0						

Expresar fracciones numéricamente

Nombre: **Clave De Respuestas**

Escribe la cantidad sombreada como una fracción.

Ej)

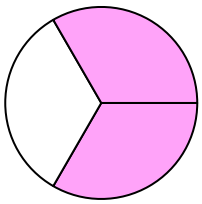

1)

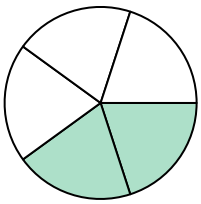

2)

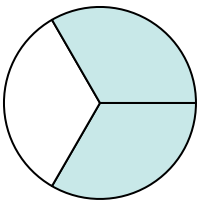

3)

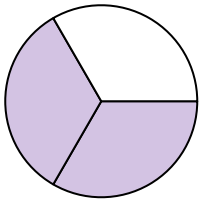

4)

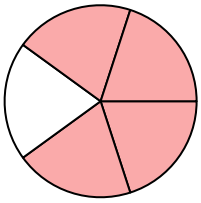

5)



6)



7)

8)

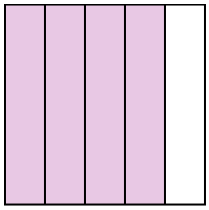

9)

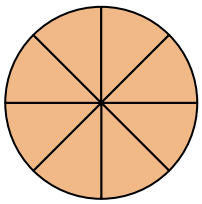

10)

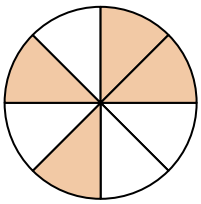

11)



12)

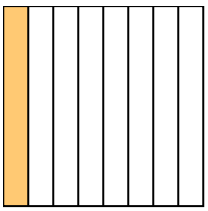

13)

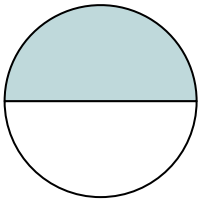

14)

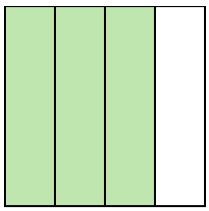

Respuestas

Ej.	2/3
1.	2/5
2.	2/3
3.	2/3
4.	4/5
5.	2/2
6.	4/4
7.	1/4
8.	4/5
9.	8/8
10.	4/8
11.	1/2
12.	1/8
13.	1/2
14.	3/4

1-10	93	86	79	71	64	57	50	43	36	29
11-14	21	14	7	0						

Expresar fracciones numéricamente Nombre:

Escribe la cantidad sombreada como una fracción.

Ej)



1)



2)

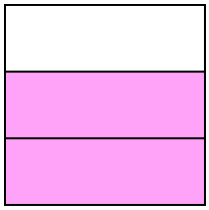

3)

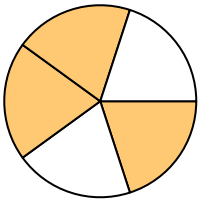

4)

5)

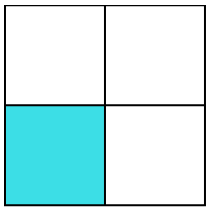

6)

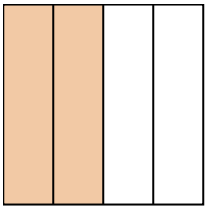

7)

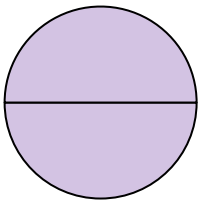

8)

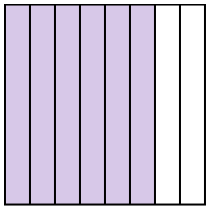

9)



10)

11)

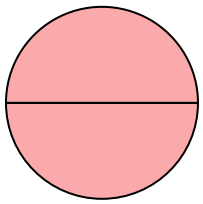

12)



13)



14)

Respuestas

Ej. $^{7}/_{8}$

1. _____
2. _____
3. _____
4. _____
5. _____
6. _____
7. _____
8. _____
9. _____
10. _____
11. _____
12. _____
13. _____
14. _____

1-10	93	86	79	71	64	57	50	43	36	29
11-14	21	14	7	0						

Expresar fracciones numéricamente

Nombre: **Clave De Respuestas**

Escribe la cantidad sombreada como una fracción.

Ej)



1)



2)

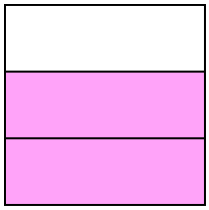

3)

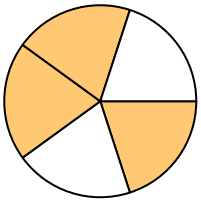

4)

5)

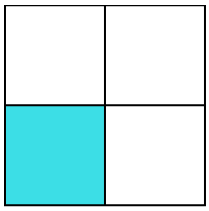

6)

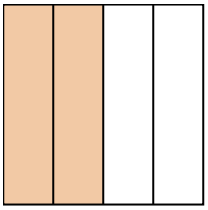

7)

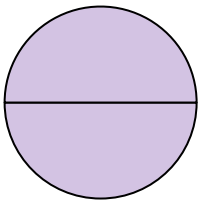

8)

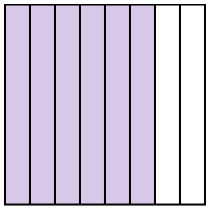

9)



10)

11)

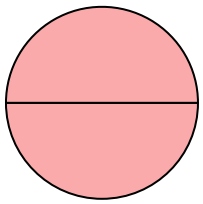

12)



13)



14)



Respuestas

Ej.	7/8
1.	1/3
2.	2/3
3.	3/5
4.	4/5
5.	1/4
6.	2/4
7.	2/2
8.	6/8
9.	4/5
10.	1/4
11.	2/2
12.	1/2
13.	5/8
14.	3/3

1-10	93	86	79	71	64	57	50	43	36	29
11-14	21	14	7	0						

Expresar fracciones numéricamente Nombre:

Escribe la cantidad sombreada como una fracción.

Ej)

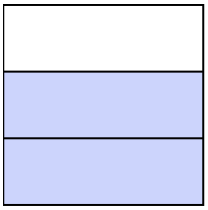

1)



2)



3)



4)

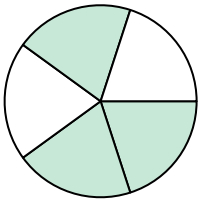

5)

6)

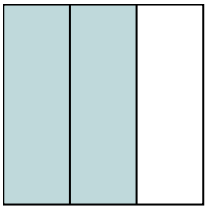

7)

8)

9)

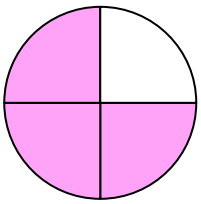

10)

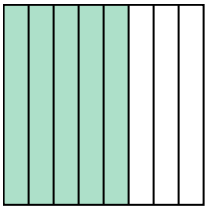

11)

12)



13)

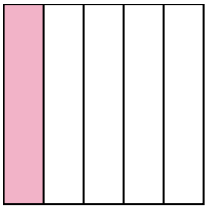

14)



Respuestas

Ej. $\frac{2}{3}$

1. _____
2. _____
3. _____
4. _____
5. _____
6. _____
7. _____
8. _____
9. _____
10. _____
11. _____
12. _____
13. _____
14. _____

1-10	93	86	79	71	64	57	50	43	36	29
11-14	21	14	7	0						

Expresar fracciones numéricamente

Nombre: **Clave De Respuestas**

Escribe la cantidad sombreada como una fracción.

Ej)

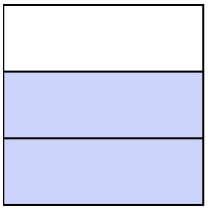

1)



2)



3)



4)

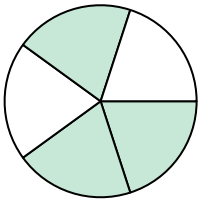

5)

6)

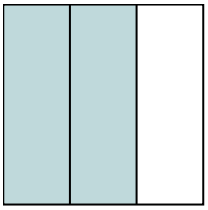

7)

8)

9)

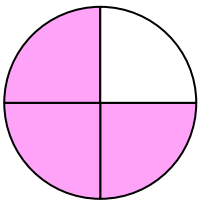

10)

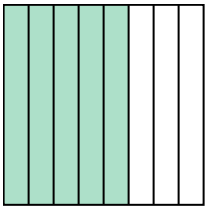

11)

12)



13)

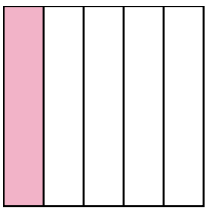

14)



Respuestas

Ej.	$\frac{2}{3}$
1.	$\frac{3}{3}$
2.	$\frac{2}{4}$
3.	$\frac{1}{2}$
4.	$\frac{3}{5}$
5.	$\frac{3}{8}$
6.	$\frac{2}{3}$
7.	$\frac{4}{8}$
8.	$\frac{3}{5}$
9.	$\frac{3}{4}$
10.	$\frac{5}{8}$
11.	$\frac{1}{4}$
12.	$\frac{2}{2}$
13.	$\frac{1}{5}$
14.	$\frac{1}{2}$

1-10	93	86	79	71	64	57	50	43	36	29
11-14	21	14	7	0						