Expresar fracciones numéricamente

Nombre:

Escribe la cantidad sombreada como una fracción.

Ej)



1)

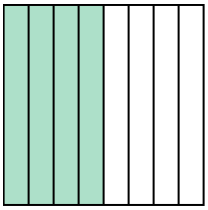

2)

3)



4)

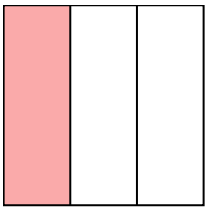

5)



6)

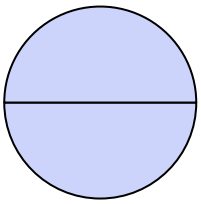

7)

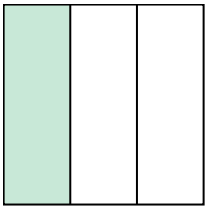

8)

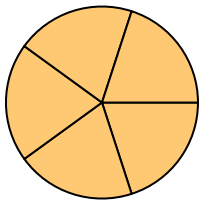

9)

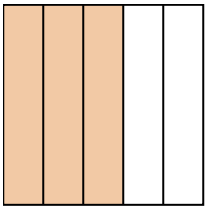

10)

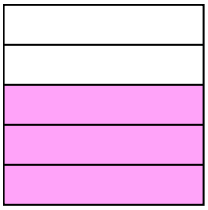

11)

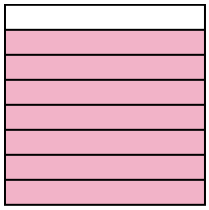

12)



13)

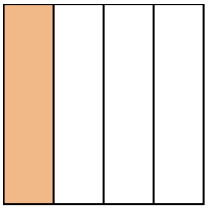

14)

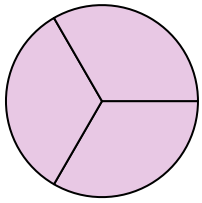

Respuestas

Ej. $\frac{1}{2}$

1. _____
2. _____
3. _____
4. _____
5. _____
6. _____
7. _____
8. _____
9. _____
10. _____
11. _____
12. _____
13. _____
14. _____

1-10	93	86	79	71	64	57	50	43	36	29
11-14	21	14	7	0						

Escribe la cantidad sombreada como una fracción.

Ej)



1)

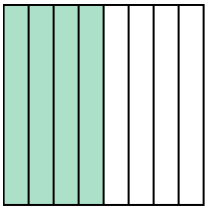

2)

3)



4)

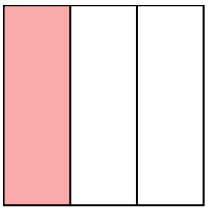

5)



6)

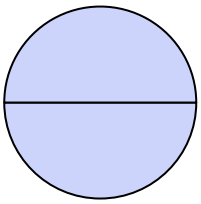

7)

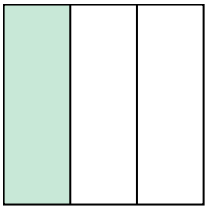

8)

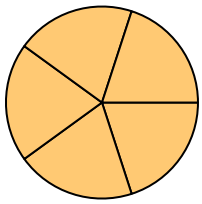

9)

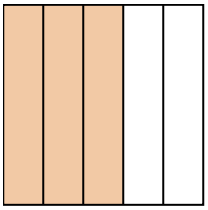

10)

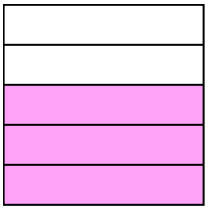

11)

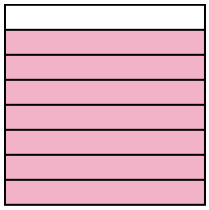

12)



13)

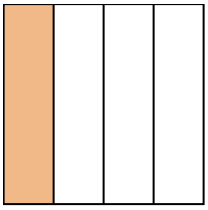

14)

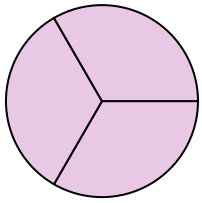

Respuestas

Ej.	1/2
1.	4/8
2.	6/8
3.	1/4
4.	1/3
5.	1/2
6.	2/2
7.	1/3
8.	5/5
9.	3/5
10.	3/5
11.	7/8
12.	4/4
13.	1/4
14.	3/3

1-10	93	86	79	71	64	57	50	43	36	29
11-14	21	14	7	0						