Dividir Fracciones con una recta numérica

Nombre:

Usa la recta numérica para resolver.

1) $2 \div \frac{3}{8}$

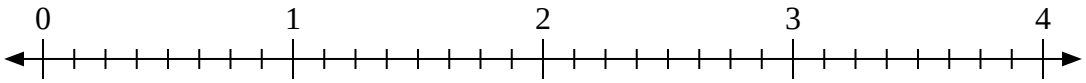

2) $3 \div \frac{2}{3}$



3) $3 \div \frac{1}{2}$

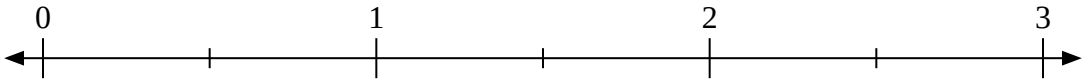

4) $2 \div \frac{4}{5}$

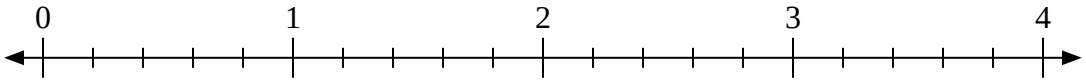

5) $5 \div \frac{1}{4}$

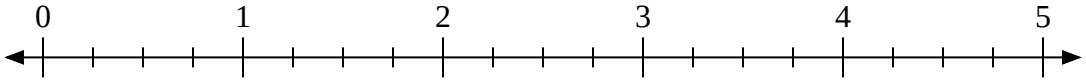

6) $4 \div \frac{1}{8}$

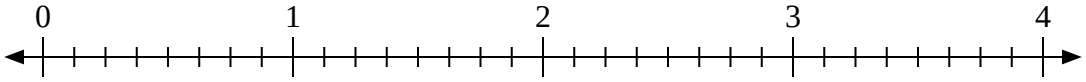

7) $2 \div \frac{3}{4}$

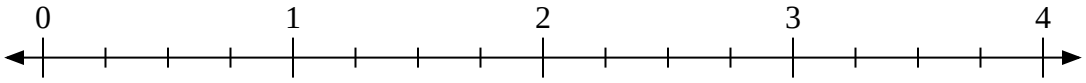

8) $4 \div \frac{2}{3}$

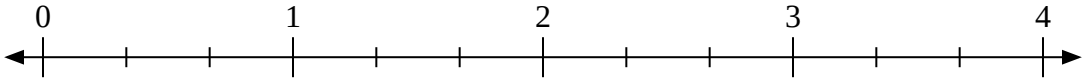

9) $3 \div \frac{4}{7}$

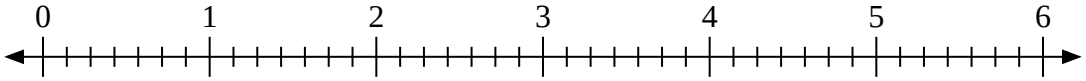

Respuestas

1. _____
2. _____
3. _____
4. _____
5. _____
6. _____
7. _____
8. _____
9. _____

1-9	89	78	67	56	44	33	22	11	0

Dividir Fracciones con una recta numérica

Nombre: **Clave De Respuestas**

Usa la recta numérica para resolver.

1) $2 \div \frac{3}{8}$

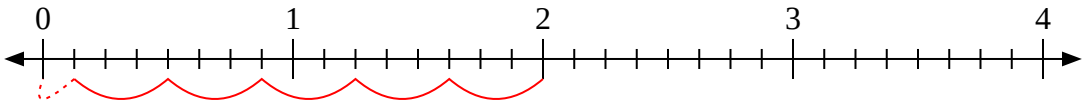

2) $3 \div \frac{2}{3}$



3) $3 \div \frac{1}{2}$

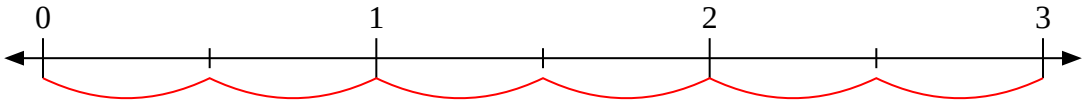

4) $2 \div \frac{4}{5}$

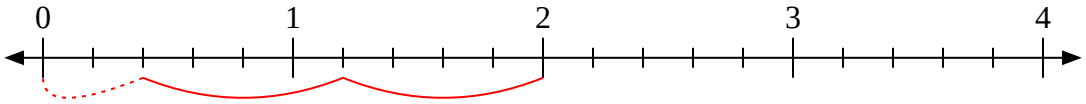

5) $5 \div \frac{1}{4}$

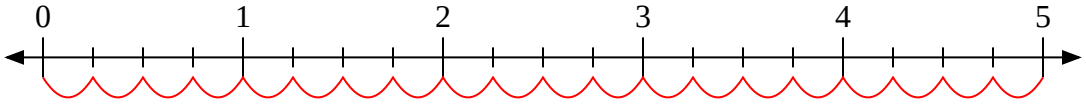

6) $4 \div \frac{1}{8}$

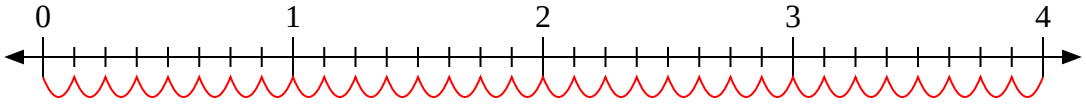

7) $2 \div \frac{3}{4}$

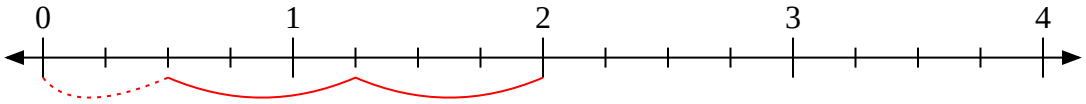

8) $4 \div \frac{2}{3}$

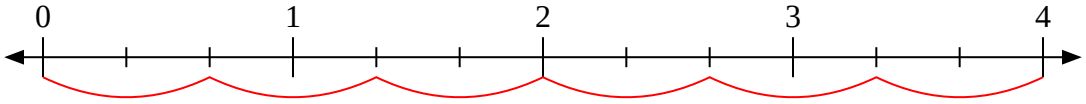

9) $3 \div \frac{4}{7}$

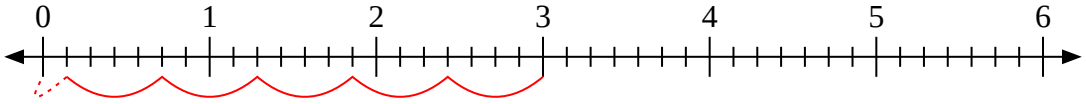

Respuestas

1. $5\frac{1}{3}$
2. $4\frac{1}{2}$
3. 6
4. $2\frac{2}{4}$
5. 20
6. 32
7. $2\frac{2}{3}$
8. 6
9. $5\frac{1}{4}$

1-9	89	78	67	56	44	33	22	11	0