Dividir Fracciones con una recta numérica Nombre:

Usa la recta numérica para resolver.

1) $6 \div \frac{3}{4}$

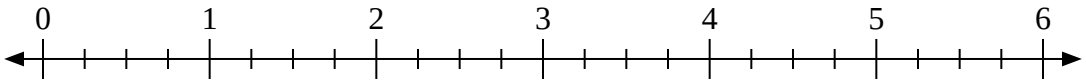

2) $5 \div \frac{1}{2}$

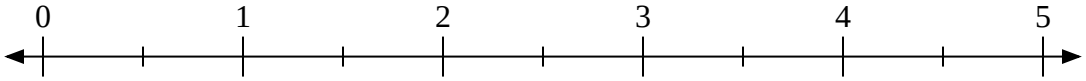

3) $3 \div \frac{6}{8}$

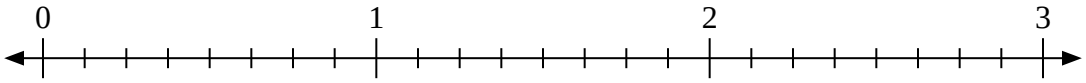

4) $3 \div \frac{3}{4}$

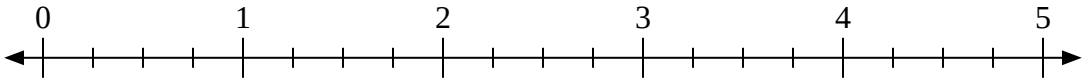

5) $6 \div \frac{3}{6}$

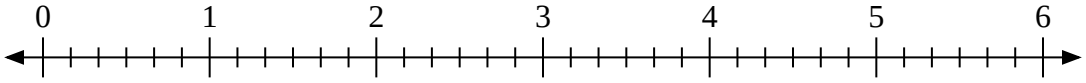

6) $5 \div \frac{1}{6}$

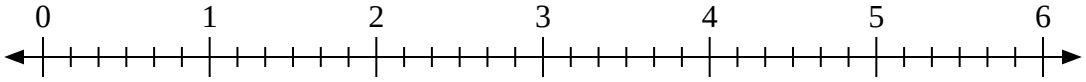

7) $3 \div \frac{1}{4}$

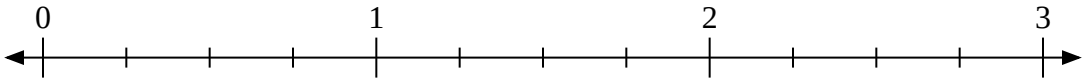

8) $3 \div \frac{2}{3}$



9) $3 \div \frac{3}{8}$

Respuestas

1. _____
2. _____
3. _____
4. _____
5. _____
6. _____
7. _____
8. _____
9. _____

1-9	89	78	67	56	44	33	22	11	0

Usa la recta numérica para resolver.

1) $6 \div \frac{3}{4}$

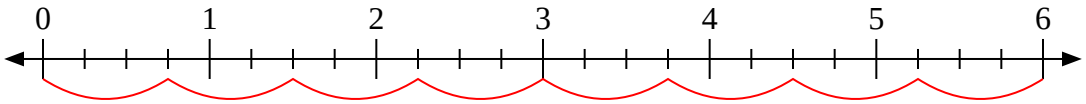

2) $5 \div \frac{1}{2}$

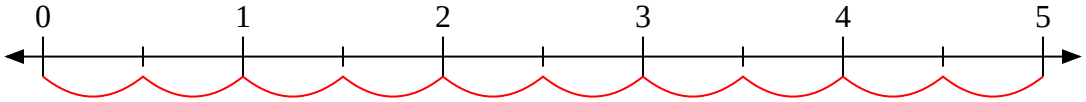

3) $3 \div \frac{6}{8}$

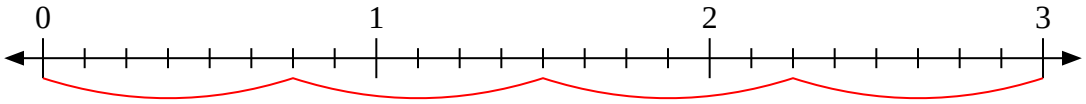

4) $3 \div \frac{3}{4}$

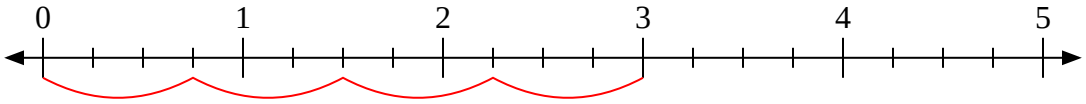

5) $6 \div \frac{3}{6}$

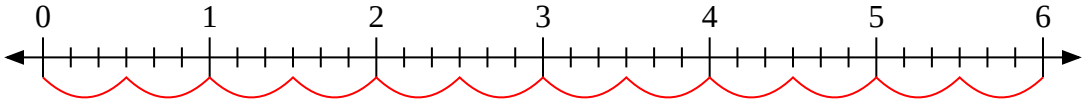

6) $5 \div \frac{1}{6}$

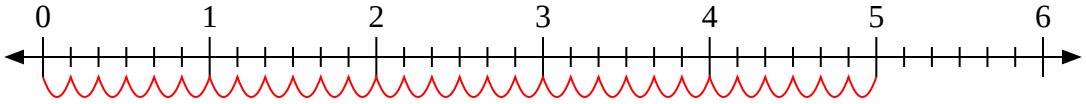

7) $3 \div \frac{1}{4}$

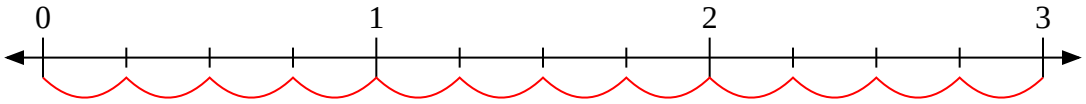

8) $3 \div \frac{2}{3}$

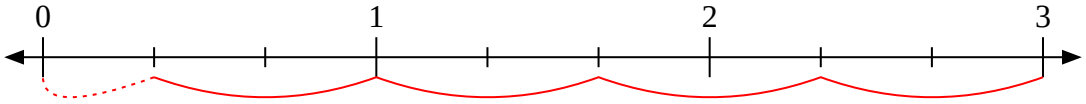

9) $3 \div \frac{3}{8}$

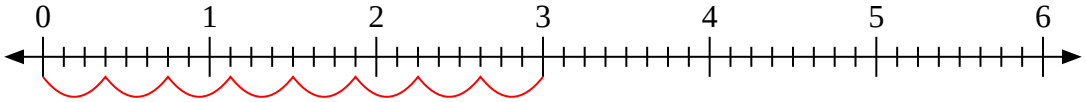

Respuestas

1. **8**
2. **10**
3. **4**
4. **4**
5. **12**
6. **30**
7. **12**
8. **$4\frac{1}{2}$**
9. **8**

1-9	89	78	67	56	44	33	22	11	0