Fracción, Decimal y Porcentaje (Visual)

Nombre:

Determina el valor escrito como fracción, decimal y porcentaje.

Ej)

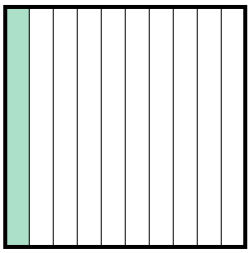

fracción $\frac{1}{10}$
décimal 0.1
porcentaje 10

1)

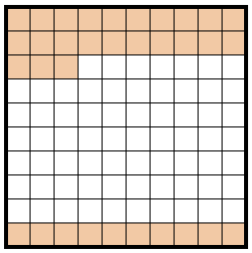

fracción _____
décimal _____
porcentaje _____

2)

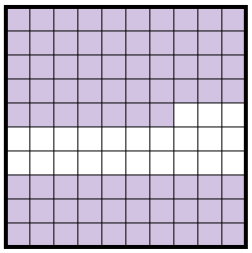

fracción _____
décimal _____
porcentaje _____

3)

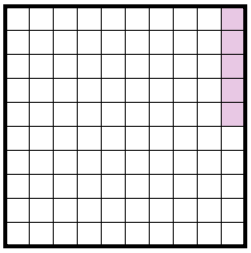

fracción _____
décimal _____
porcentaje _____

4)

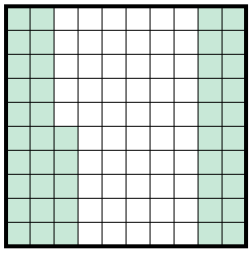

fracción _____
décimal _____
porcentaje _____

5)

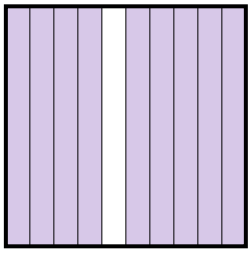

fracción _____
décimal _____
porcentaje _____

6)

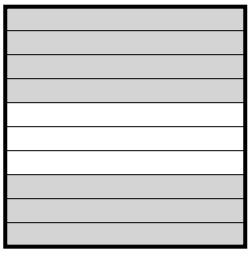

fracción _____
décimal _____
porcentaje _____

7)



fracción _____
décimal _____
porcentaje _____

8)



fracción _____
décimal _____
porcentaje _____

9)

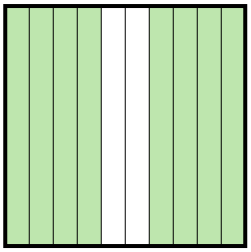

fracción _____
décimal _____
porcentaje _____

10)

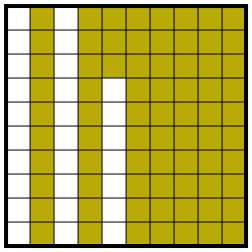

fracción _____
décimal _____
porcentaje _____

11)

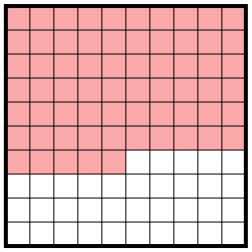

fracción _____
décimal _____
porcentaje _____

Respuestas

Ej.	$\frac{1}{10}$	0.1	10%
1.			
2.			
3.			
4.			
5.			
6.			
7.			
8.			
9.			
10.			
11.			

1-10	91	82	73	64	55	45	36	27	18	9
11	0									

Determina el valor escrito como fracción, decimal y porcentaje.

Ej)

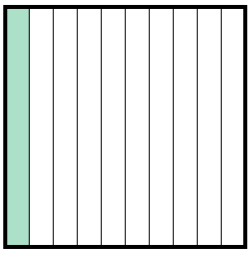

fracción $\frac{1}{10}$
décimal 0.1
porcentaje 10

1)

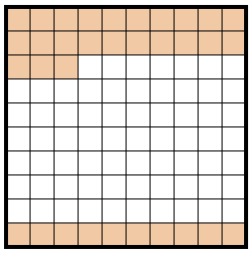

fracción $\frac{33}{100}$
décimal 0.33
porcentaje 33

2)

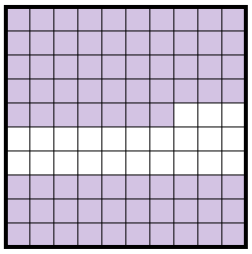

fracción $\frac{77}{100}$
décimal 0.77
porcentaje 77

3)

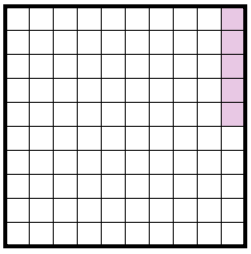

fracción $\frac{5}{100}$
décimal 0.05
porcentaje 5

4)

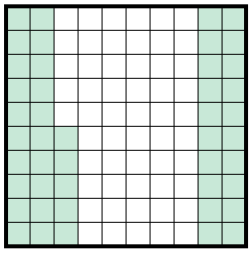

fracción $\frac{45}{100}$
décimal 0.45
porcentaje 45

5)

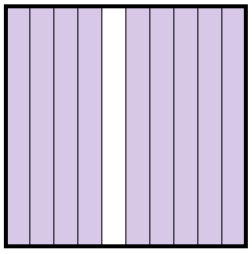

fracción $\frac{9}{10}$
décimal 0.9
porcentaje 90

6)

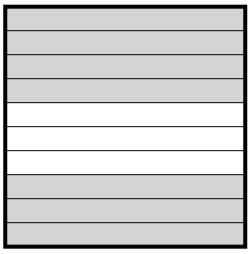

fracción $\frac{7}{10}$
décimal 0.7
porcentaje 70

7)



fracción $\frac{3}{10}$
décimal 0.3
porcentaje 30

8)



fracción $\frac{2}{10}$
décimal 0.2
porcentaje 20

9)

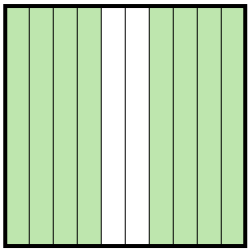

fracción $\frac{8}{10}$
décimal 0.8
porcentaje 80

10)

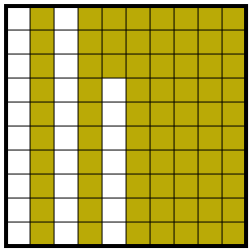

fracción $\frac{73}{100}$
décimal 0.73
porcentaje 73

11)

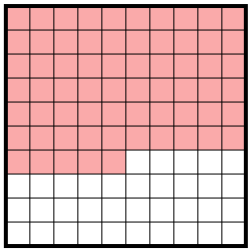

fracción $\frac{65}{100}$
décimal 0.65
porcentaje 65

Respuestas

Ej.	$\frac{1}{10}$	0.1	10%
1.	$\frac{33}{100}$	0.33	33%
2.	$\frac{77}{100}$	0.77	77%
3.	$\frac{5}{100}$	0.05	5%
4.	$\frac{45}{100}$	0.45	45%
5.	$\frac{9}{10}$	0.9	90%
6.	$\frac{7}{10}$	0.7	70%
7.	$\frac{3}{10}$	0.3	30%
8.	$\frac{2}{10}$	0.2	20%
9.	$\frac{8}{10}$	0.8	80%
10.	$\frac{73}{100}$	0.73	73%
11.	$\frac{65}{100}$	0.65	65%

1-10	91	82	73	64	55	45	36	27	18	9
11	0									