Comparando fracciones. Nombre:

Compara el tamaño de las fracciones usando <,> o =.

Ej) 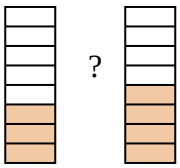

1) 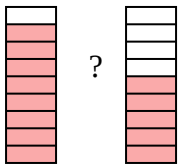

2) 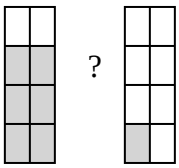

3) 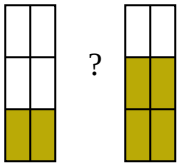

4) 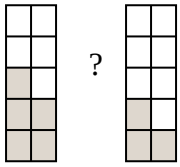

5) 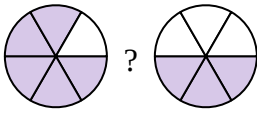

6) 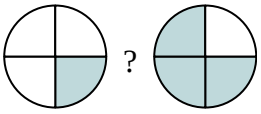

7) 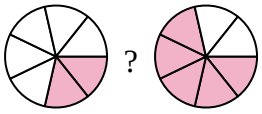

8) 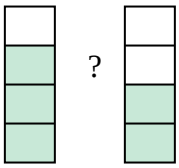

9) 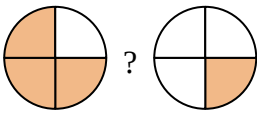

10) 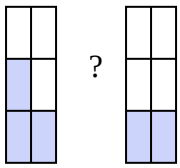

11) 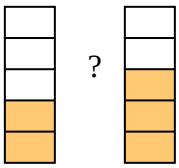

12) 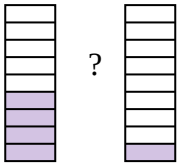

13) 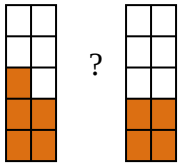

14) 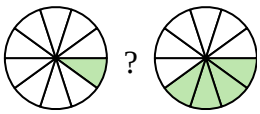

Respuestas

Ej.	$^3/_8$	<	$^4/_8$
1.			
2.			
3.			
4.			
5.			
6.			
7.			
8.			
9.			
10.			
11.			
12.			
13.			
14.			

1-10	93	86	79	71	64	57	50	43	36	29
11-14	21	14	7	0						

Comparando fracciones. Nombre: **Clave De Respuestas**

Compara el tamaño de las fracciones usando <,> o =.

Ej) 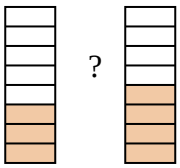

1) 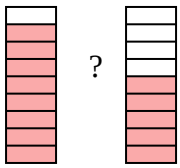

2) 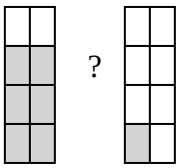

3) 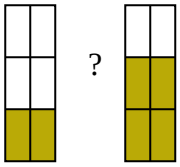

4) 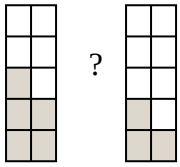

5) 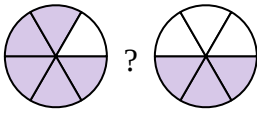

6) 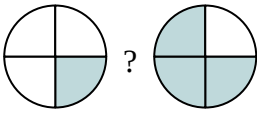

7) 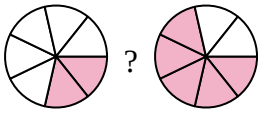

8) 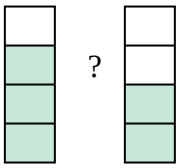

9) 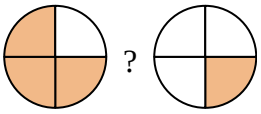

10) 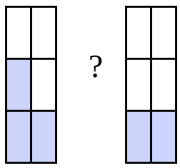

11) 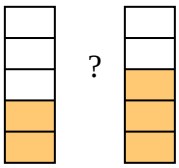

12) 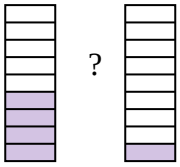

13) 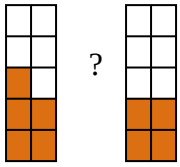

14) 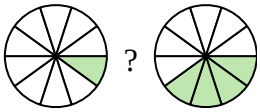

Respuestas

Ej.	$\frac{3}{8}$	<	$\frac{4}{8}$
1.	$\frac{8}{9}$	>	$\frac{5}{9}$
2.	$\frac{6}{8}$	>	$\frac{1}{8}$
3.	$\frac{2}{6}$	<	$\frac{4}{6}$
4.	$\frac{5}{10}$	>	$\frac{3}{10}$
5.	$\frac{5}{6}$	>	$\frac{3}{6}$
6.	$\frac{1}{4}$	<	$\frac{3}{4}$
7.	$\frac{2}{7}$	<	$\frac{5}{7}$
8.	$\frac{3}{4}$	>	$\frac{2}{4}$
9.	$\frac{3}{4}$	>	$\frac{1}{4}$
10.	$\frac{3}{6}$	>	$\frac{2}{6}$
11.	$\frac{2}{5}$	<	$\frac{3}{5}$
12.	$\frac{4}{9}$	>	$\frac{1}{9}$
13.	$\frac{5}{10}$	>	$\frac{4}{10}$
14.	$\frac{1}{10}$	<	$\frac{4}{10}$

1-10	93	86	79	71	64	57	50	43	36	29
11-14	21	14	7	0						