Dividiendo con una recta numérica Nombre:

Usa las rectas numéricas para resolver los problemas.

1) 32÷8=

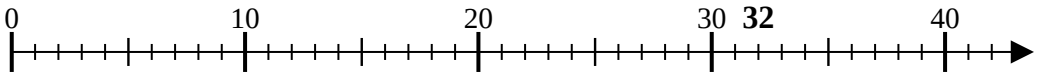

2) 20÷4=

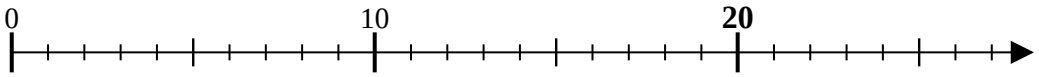

3) 27÷9=

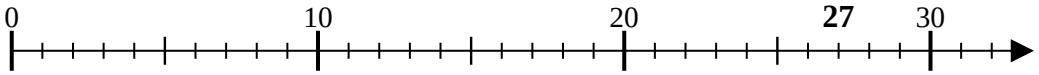

4) 15÷3=

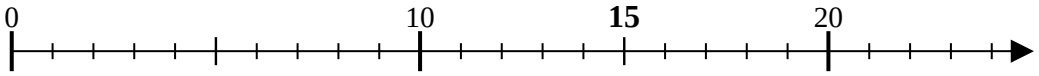

5) 12÷6=

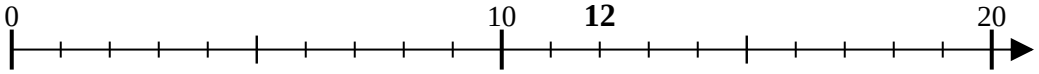

6) 8÷2=

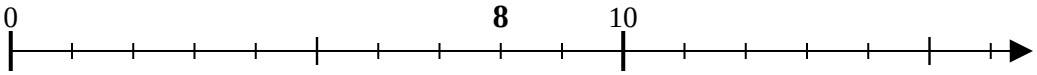

7) 8÷4=

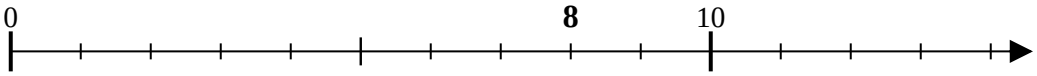

8) 28÷7=

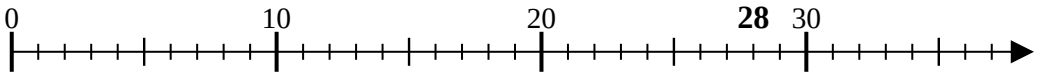

9) 12÷3=

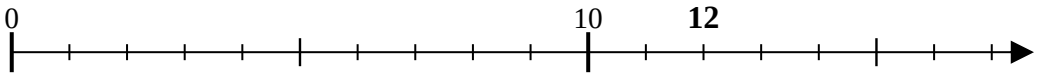

10) 6÷3=

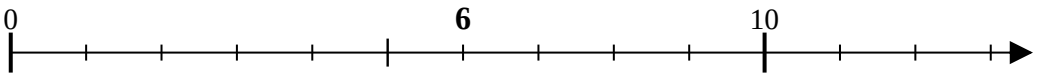

11) 4÷2=

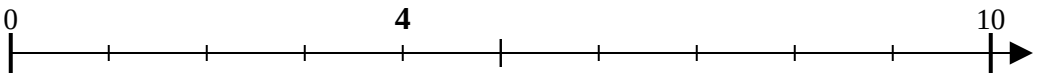

Respuestas

1. _____
2. _____
3. _____
4. _____
5. _____
6. _____
7. _____
8. _____
9. _____
10. _____
11. _____

Dividiendo con una recta numérica

Nombre: **Clave De Respuestas**

Usa las rectas numéricas para resolver los problemas.

1) 32÷8=

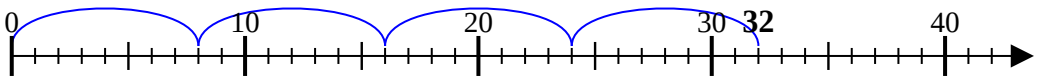

2) 20÷4=

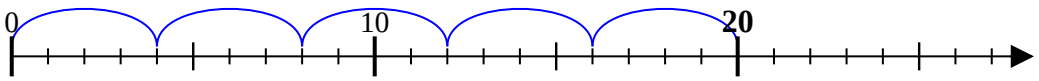

3) 27÷9=

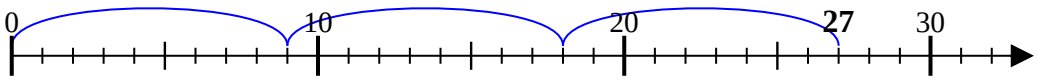

4) 15÷3=

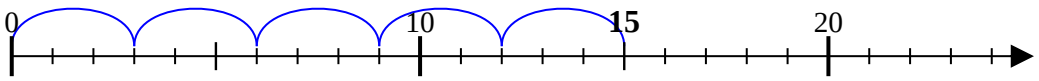

5) 12÷6=

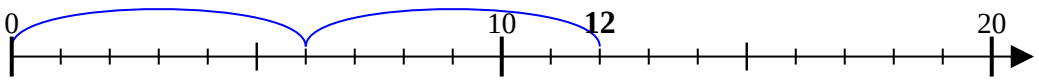

6) 8÷2=

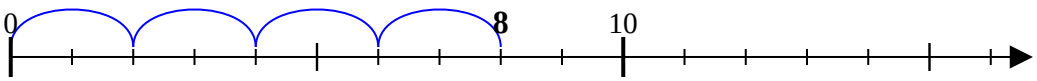

7) 8÷4=

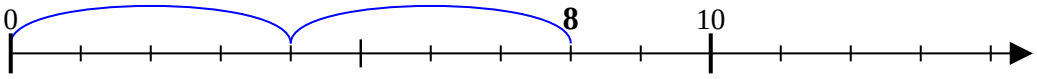

8) 28÷7=

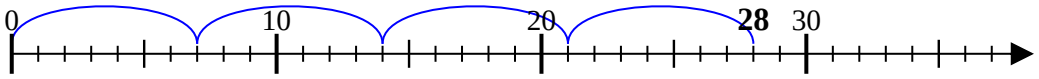

9) 12÷3=

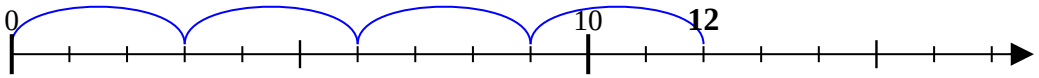

10) 6÷3=

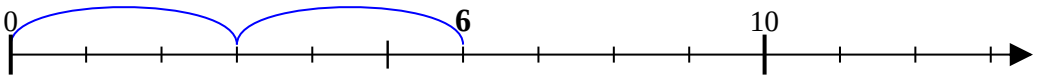

11) 4÷2=

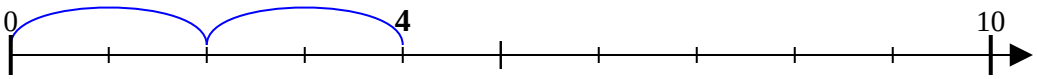

Respuestas

1. 4
2. 5
3. 3
4. 5
5. 2
6. 4
7. 2
8. 4
9. 4
10. 2
11. 2