Multiplicando Decimales (Visualmente)

Nombre:

Usa el modelo visual para resolver cada problema.

1) $2 \times 0.65 =$

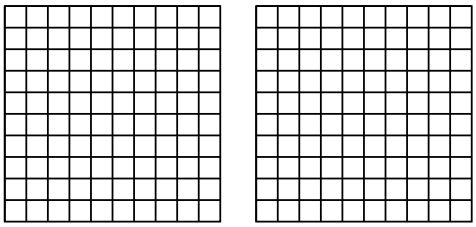

2) $4 \times 0.31 =$

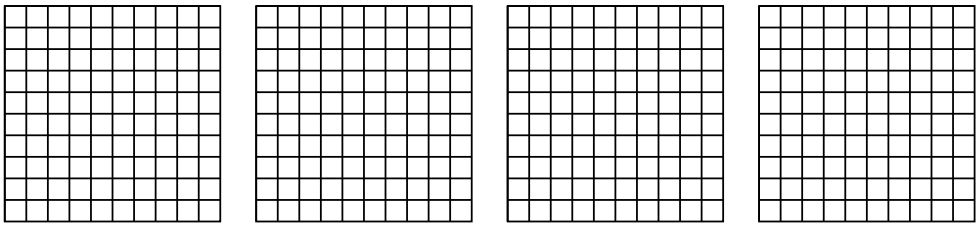

3) $4 \times 0.4 =$

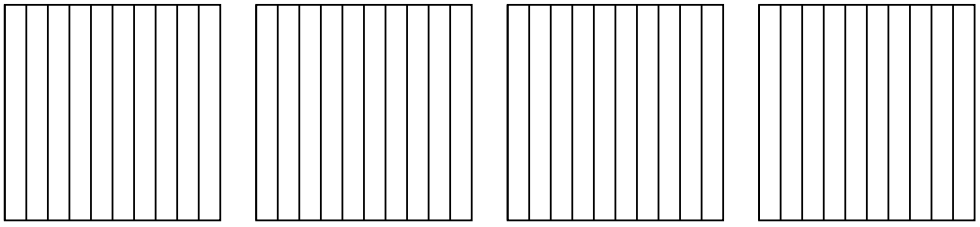

4) $4 \times 0.4 =$

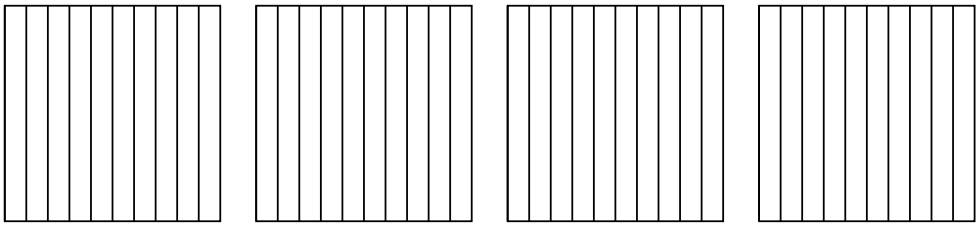

5) $2 \times 0.12 =$

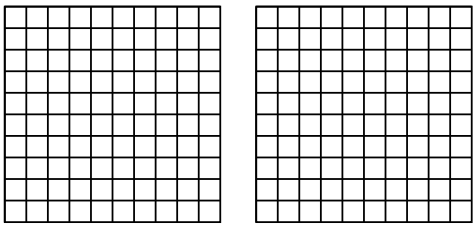

6) $2 \times 0.3 =$

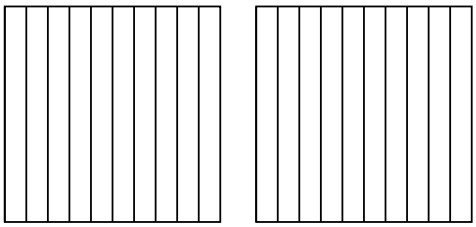

Respuestas

1. _____
2. _____
3. _____
4. _____
5. _____
6. _____

Multiplicando Decimales (Visualmente) Nombre: **Clave De Respuestas**

Usa el modelo visual para resolver cada problema.

1) 2 × 0.65 =

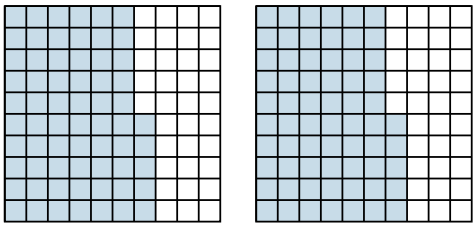

2) 4 × 0.31 =

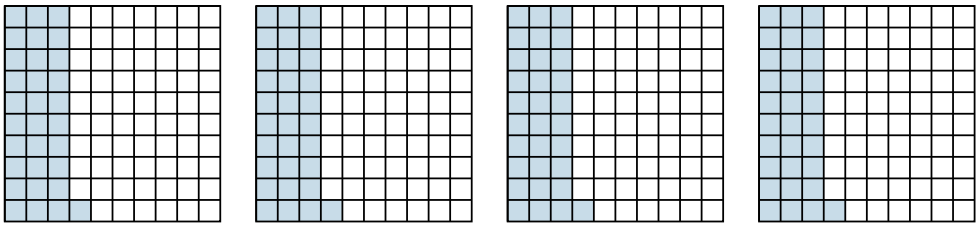

3) 4 × 0.4 =

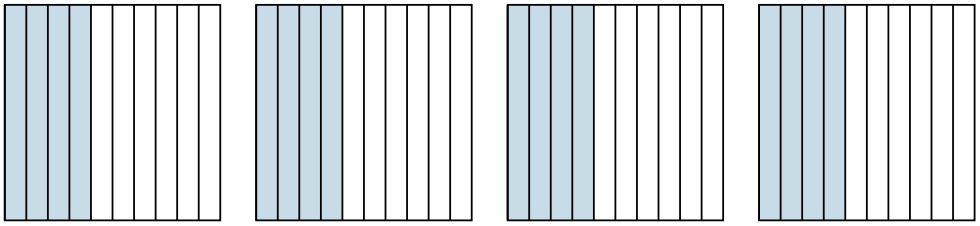

4) 4 × 0.4 =

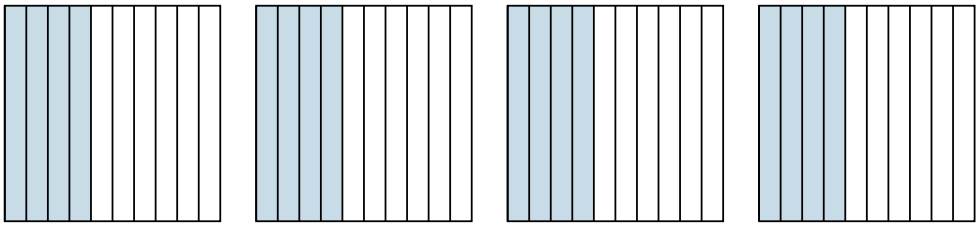

5) 2 × 0.12 =

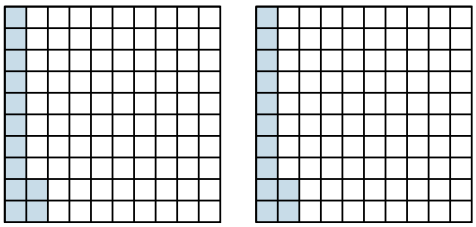

6) 2 × 0.3 =

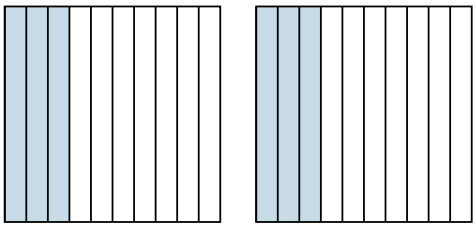

Respuestas

1. $^{130}/_{100} = 1.3$
2. $^{124}/_{100} = 1.24$
3. $^{16}/_{10} = 1.6$
4. $^{16}/_{10} = 1.6$
5. $^{24}/_{100} = 0.24$
6. $^{6}/_{10} = 0.6$

1-6	83	67	50	33	17	0