Encuentre el ancho, la altura y el área de los rectángulos. Nombre:

Determine el ancho, la altura y el área reales de cada rectángulo.
Redondea el área al número entero más cercano

1) 2.3 cm



1 cm

1 cm = 5 ft

2) 2.2 cm



1.5 cm

1 cm = 2 ft

3) 2.4 cm



2.2 cm

1 cm = 3 ft

4) 3.1 cm



3 cm

1 cm = 9 ft

5) 2.7 cm



3.4 cm

1 cm = 8 ft

6) 4.9 cm

2.4 cm

1 cm = 7 ft

7) 3.8 cm



4.8 cm

1 cm = 5 ft

8) 2.2 cm



2.4 cm

1 cm = 5 ft

Respuestas

1. _____ _____ _____
2. _____ _____ _____
3. _____ _____ _____
4. _____ _____ _____
5. _____ _____ _____
6. _____ _____ _____
7. _____ _____ _____
8. _____ _____ _____

Encuentre el ancho, la altura y el área de los rectángulos. Nombre: **Clave De Respuestas**

Determine el ancho, la altura y el área reales de cada rectángulo.
Redondea el área al número entero más cercano

1)

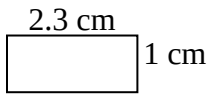

1 cm = 5 ft

2)

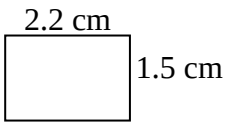

1 cm = 2 ft

3)

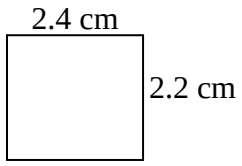

1 cm = 3 ft

4)

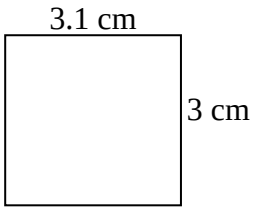

1 cm = 9 ft

5)

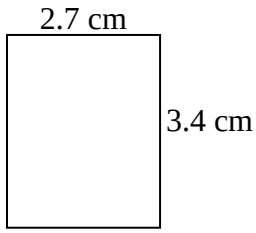

1 cm = 8 ft

6)

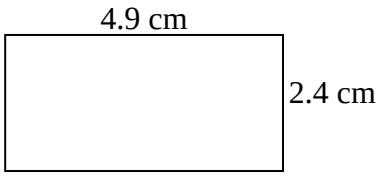

1 cm = 7 ft

7)

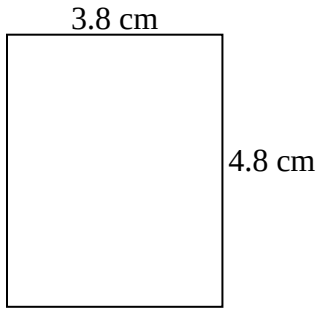

1 cm = 5 ft

8)

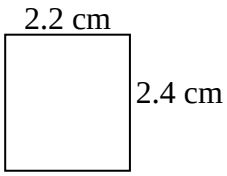

1 cm = 5 ft

Respuestas

1.	11.5	5	58
2.	4.4	3	13
3.	7.2	6.6	48
4.	27.9	27	753
5.	21.6	27.2	588
6.	34.3	16.8	576
7.	19	24	456
8.	11	12	132