Encuentra el área de la superficie Nombre:

Encuentra el área de la superficie de cada figura.

Ej)

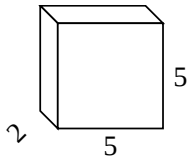

1)

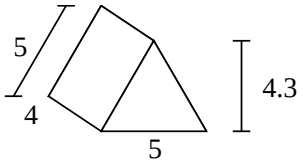

2)

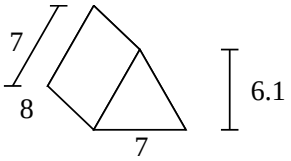

3)

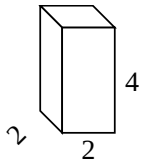

4)

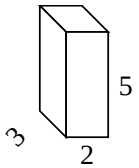

5)

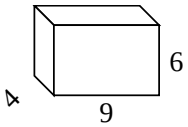

6)

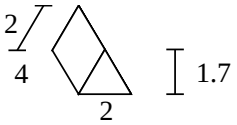

7)

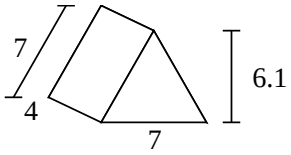

8)

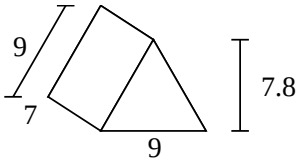

Respuestas

Ej. 90 cm^2

1. _____

2. _____

3. _____

4. _____

5. _____

6. _____

7. _____

8. _____

Encuentra el área de la superficie de cada figura.

Ej)

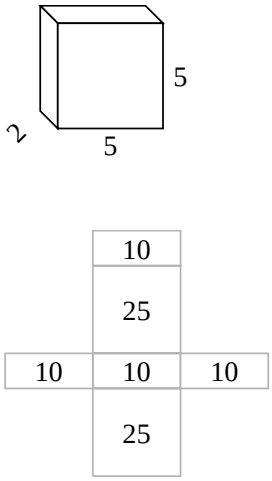

1)

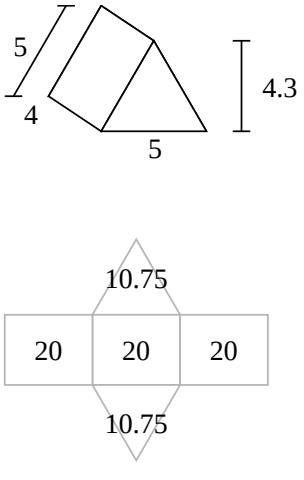

2)

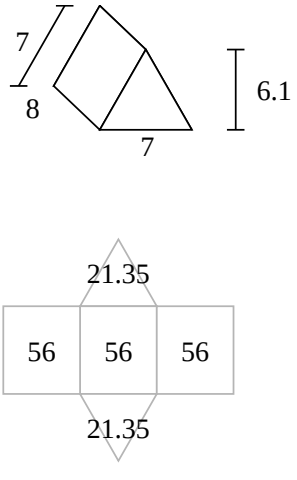

3)

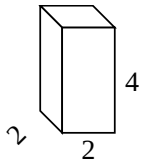

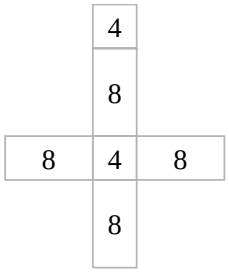

4)

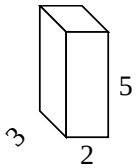

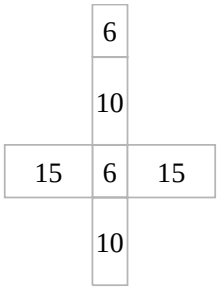

5)

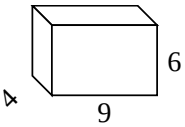

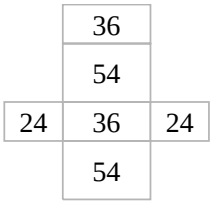

6)

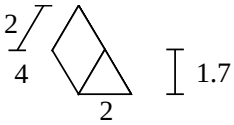

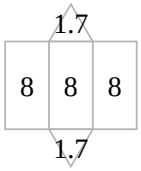

7)

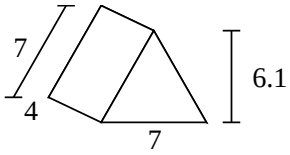

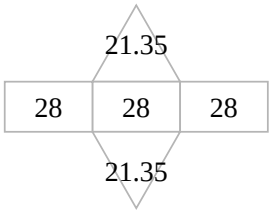

8)

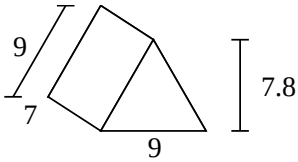

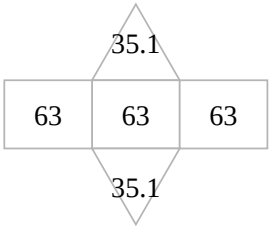

Respuestas

Ej.	90 cm^2
1.	81.5 cm^2
2.	210.7 cm^2
3.	40 cm^2
4.	62 cm^2
5.	228 cm^2
6.	27.4 cm^2
7.	126.7 cm^2
8.	259.2 cm^2

1-8	88	75	63	50	38	25	13	0