Encuentra el valor de X de cada figura. Cada figura está en centímetros (cm). No a escala.

1) area = $^{4}/_{18}$ cm^2

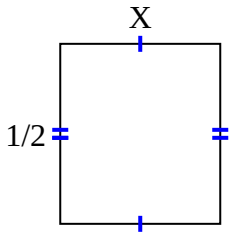

2) area = $^{6}/_{40}$ cm^2

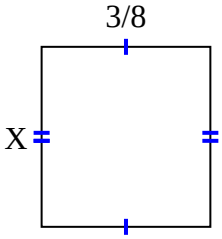

3) area = $^{6}/_{21}$ cm^2

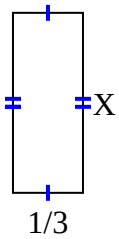

4) area = $^{2}/_{16}$ cm^2

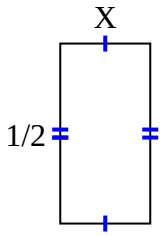

5) area = $^{12}/_{30}$ cm^2

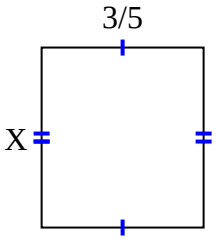

6) area = $^{2}/_{49}$ cm^2

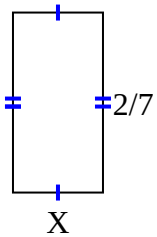

7) area = $^{3}/_{40}$ cm^2

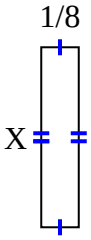

8) area = $^{24}/_{72}$ cm^2

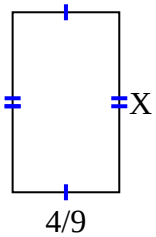

9) area = $^{2}/_{30}$ cm^2

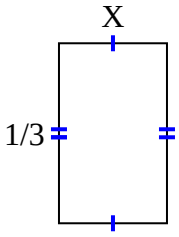

10) area = $^{1}/_{21}$ cm^2

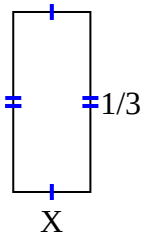

11) area = $^{5}/_{30}$ cm^2

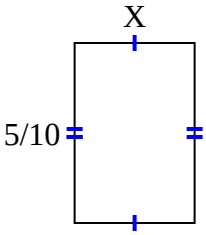

12) area = $^{4}/_{40}$ cm^2

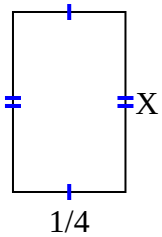

Respuestas

1. _____
2. _____
3. _____
4. _____
5. _____
6. _____
7. _____
8. _____
9. _____
10. _____
11. _____
12. _____

1-10	92	83	75	67	58	50	42	33	25	17
11-12	8	0								

Encuentra el valor de X de cada figura. Cada figura está en centímetros (cm). No a escala.

1) area = $^{4}/_{18}$ cm^2

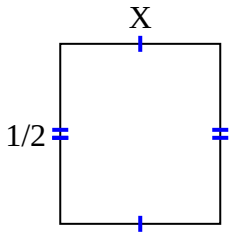

2) area = $^{6}/_{40}$ cm^2

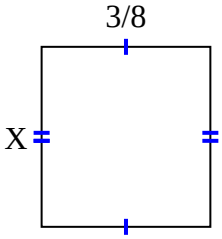

3) area = $^{6}/_{21}$ cm^2

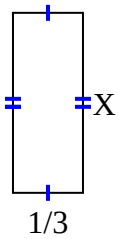

4) area = $^{2}/_{16}$ cm^2

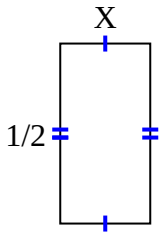

5) area = $^{12}/_{30}$ cm^2

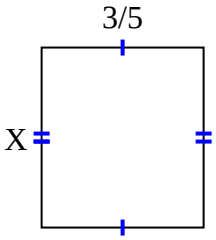

6) area = $^{2}/_{49}$ cm^2

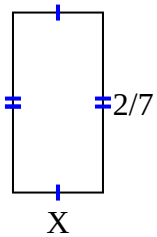

7) area = $^{3}/_{40}$ cm^2

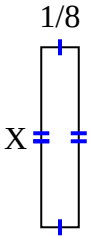

8) area = $^{24}/_{72}$ cm^2

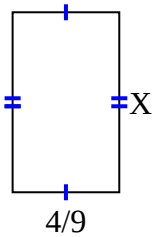

9) area = $^{2}/_{30}$ cm^2

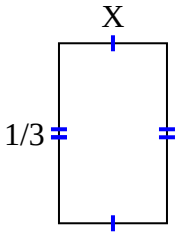

10) area = $^{1}/_{21}$ cm^2

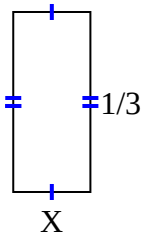

11) area = $^{5}/_{30}$ cm^2

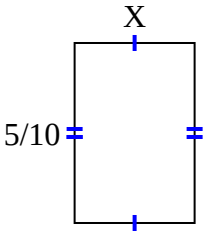

12) area = $^{4}/_{40}$ cm^2

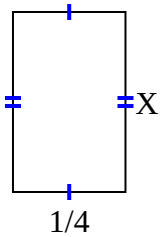

Respuestas

1. $^{4}/_{9}$
2. $^{2}/_{5}$
3. $^{6}/_{7}$
4. $^{2}/_{8}$
5. $^{4}/_{6}$
6. $^{1}/_{7}$
7. $^{3}/_{5}$
8. $^{6}/_{8}$
9. $^{2}/_{10}$
10. $^{1}/_{7}$
11. $^{1}/_{3}$
12. $^{4}/_{10}$

1-10	92	83	75	67	58	50	42	33	25	17
11-12	8	0								