Encontrando el Área

Nombre:

Encuentra el área (en cm) de los rectangulos mostrados.

1)

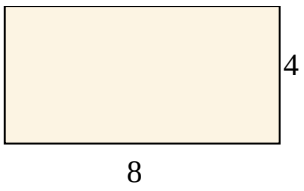

2)

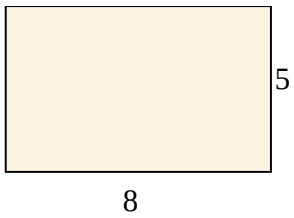

3)

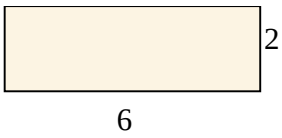

4)

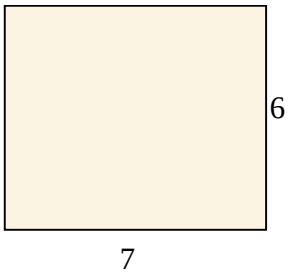

5)

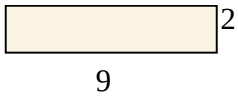

6)

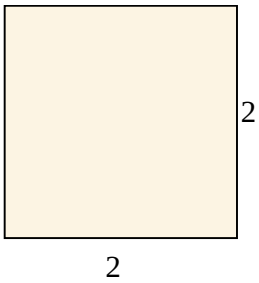

7)

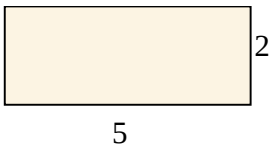

8)

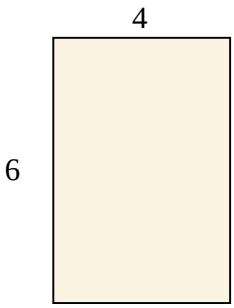

9)

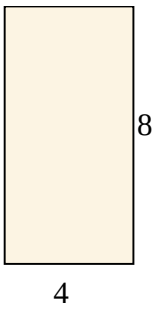

10)

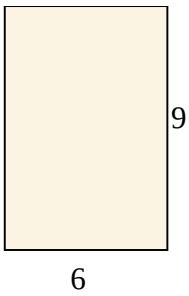

11)



12)

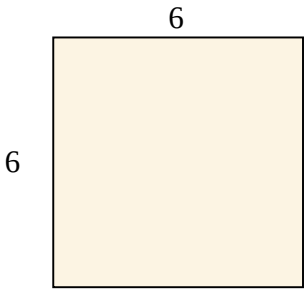

Respuestas

1. _____
2. _____
3. _____
4. _____
5. _____
6. _____
7. _____
8. _____
9. _____
10. _____
11. _____
12. _____

1-10	92	83	75	67	58	50	42	33	25	17
11-12	8	0								

Encontrando el Área

Nombre: **Clave De Respuestas**

Encuentra el área (en cm) de los rectangulos mostrados.

1)

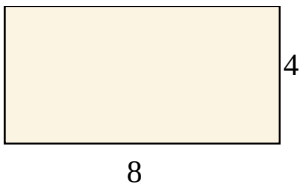

2)

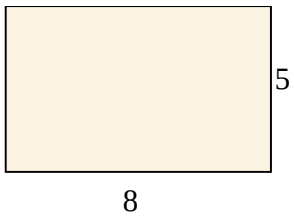

3)

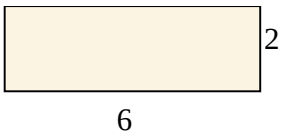

4)

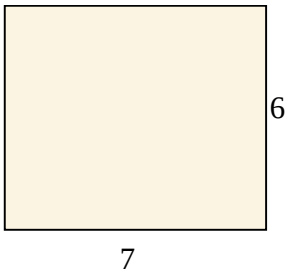

5)

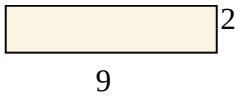

6)

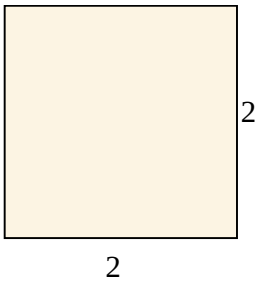

7)

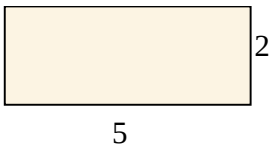

8)

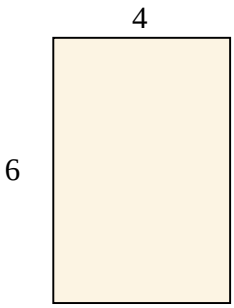

9)

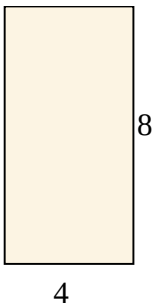

10)

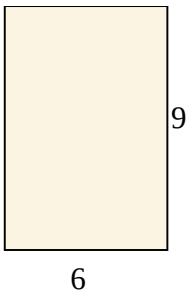

11)



12)

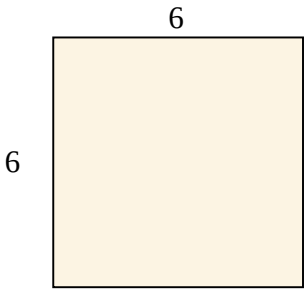

Respuestas

1. **32**
2. **40**
3. **12**
4. **42**
5. **18**
6. **4**
7. **10**
8. **24**
9. **32**
10. **54**
11. **28**
12. **36**

1-10	92	83	75	67	58	50	42	33	25	17
11-12	8	0								