Determinando el área con unidades cuadradas Nombre:

**Determina el área. Cada SVGREPLACE = 1 unidad ($u^2$)**

**1)**



**2)**

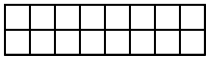

**3)**

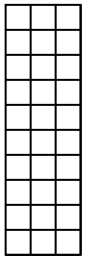

**4)**

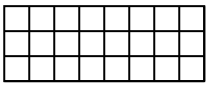

**5)**

**6)**

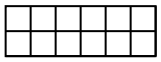

**7)**



**8)**



**9)**



**10)**



**11)**

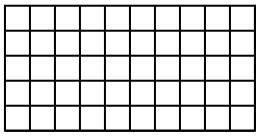

**12)**

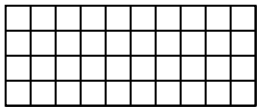

**13)**



**14)**

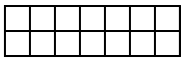

**15)**

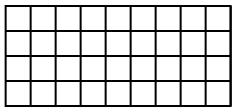

## Respuestas

1. _____
2. _____
3. _____
4. _____
5. _____
6. _____
7. _____
8. _____
9. _____
10. _____
11. _____
12. _____
13. _____
14. _____
15. _____



| | | | | | | | | | | |
|---|---|---|---|---|---|---|---|---|---|---|
| 1-10 | 93 | 87 | 80 | 73 | 67 | 60 | 53 | 47 | 40 | 33 |
| 11-15 | 27 | 20 | 13 | 7 | 0 | | | | | |

Determinando el área con unidades cuadradas

Nombre: **Clave De Respuestas**

**Determina el área. Cada SVGREPLACE = 1 unidad ($u^2$)**

**1)**

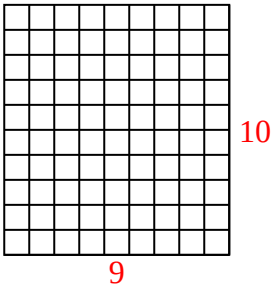


**2)**

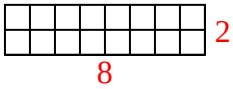


**3)**

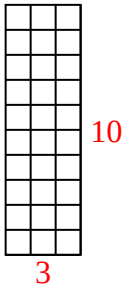


**4)**

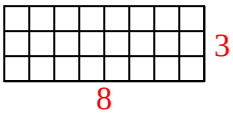


**5)**

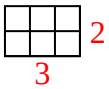


**6)**

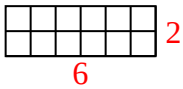


**7)**

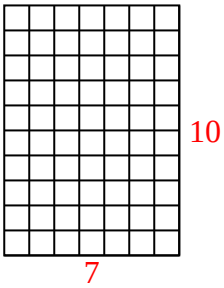


**8)**

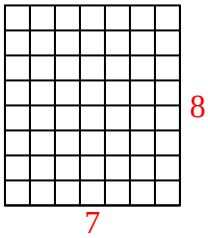


**9)**

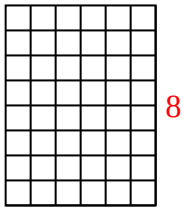


**10)**

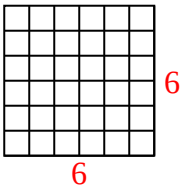


**11)**

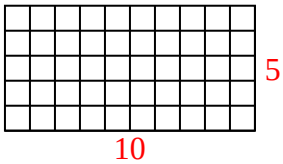


**12)**

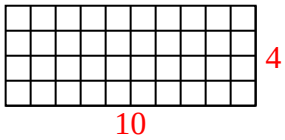


**13)**

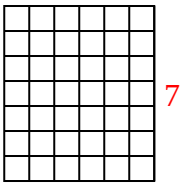


**14)**

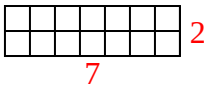


**15)**

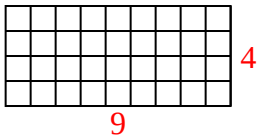


## Respuestas

1. **90 $u^2$**
2. **16 $u^2$**
3. **30 $u^2$**
4. **24 $u^2$**
5. **6 $u^2$**
6. **12 $u^2$**
7. **70 $u^2$**
8. **56 $u^2$**
9. **48 $u^2$**
10. **36 $u^2$**
11. **50 $u^2$**
12. **40 $u^2$**
13. **42 $u^2$**
14. **14 $u^2$**
15. **36 $u^2$**

| | | | | | | | | | | |
|---|---|---|---|---|---|---|---|---|---|---|
| 1-10 | 93 | 87 | 80 | 73 | 67 | 60 | 53 | 47 | 40 | 33 |
| 11-15 | 27 | 20 | 13 | 7 | 0 | | | | | |