Encuentra la circunferencia de un círculo

Nombre:

Encuentra la circunferencia de cada círculo. Los círculos no están a escala.

1)

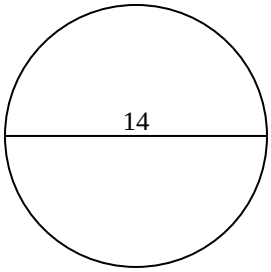

2)

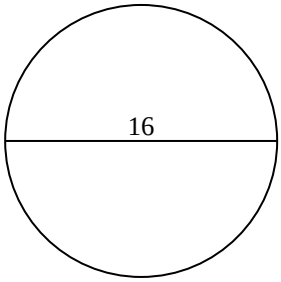

3)

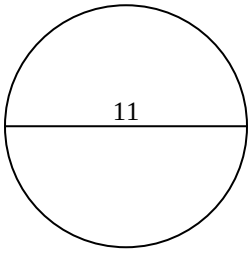

4)

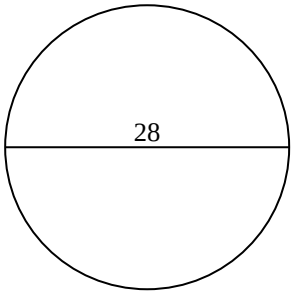

5)

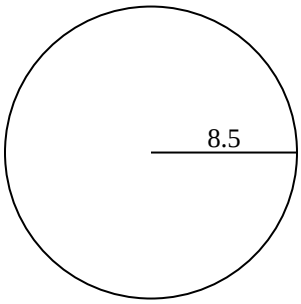

6)

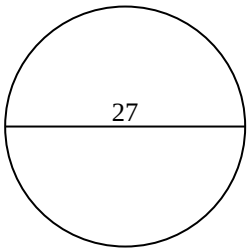

7)

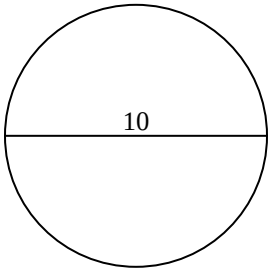

8)

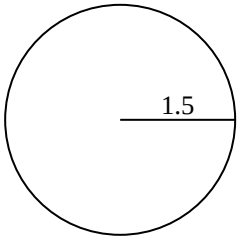

9)

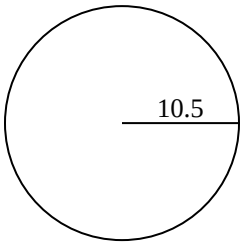

10)

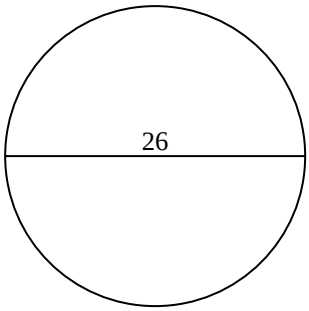

Respuestas

1. _____
2. _____
3. _____
4. _____
5. _____
6. _____
7. _____
8. _____
9. _____
10. _____

1-10	90	80	70	60	50	40	30	20	10	0

Encuentra la circunferencia de un círculo

Nombre: **Clave De Respuestas**

Encuentra la circunferencia de cada círculo. Los círculos no están a escala.

1)

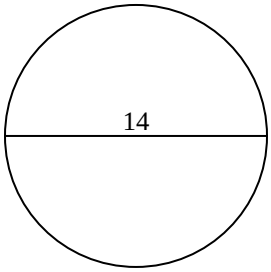

2)

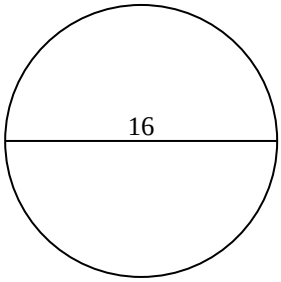

3)

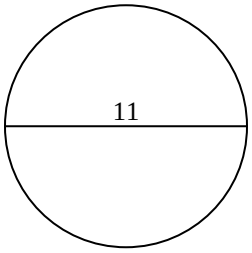

4)

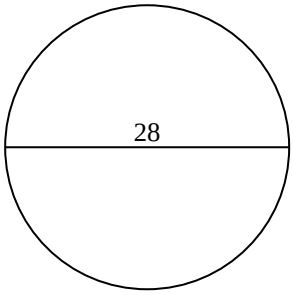

5)

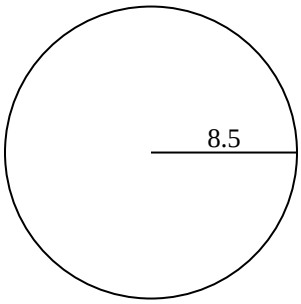

6)

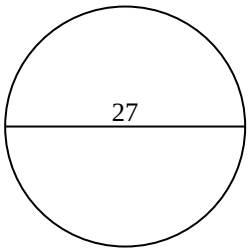

7)

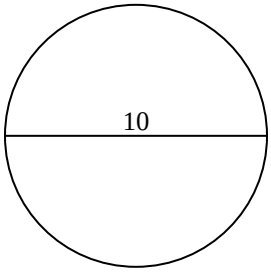

8)

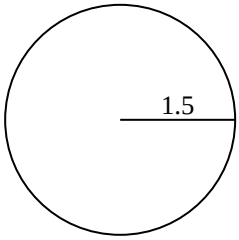

9)

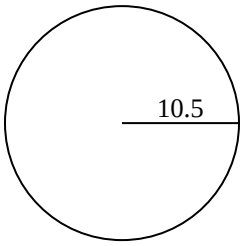

10)

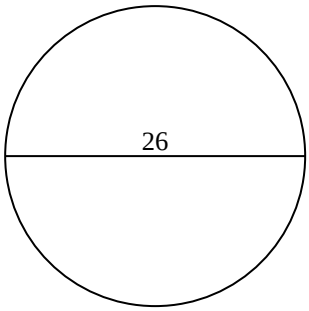

Respuestas

1. **43.98 cm**
2. **50.27 cm**
3. **34.56 cm**
4. **87.96 cm**
5. **53.41 cm**
6. **84.82 cm**
7. **31.42 cm**
8. **9.42 cm**
9. **65.97 cm**
10. **81.68 cm**

1-10	90	80	70	60	50	40	30	20	10	0

Encuentra la circunferencia de un círculo Nombre:

Encuentra la circunferencia de cada círculo. Los círculos no están a escala.

87.96 cm	81.68 cm	84.82 cm	53.41 cm	34.56 cm
50.27 cm	9.42 cm	43.98 cm	31.42 cm	65.97 cm

1)

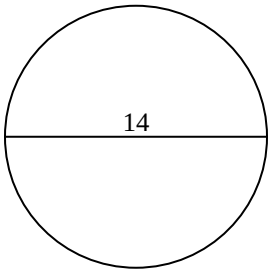

2)

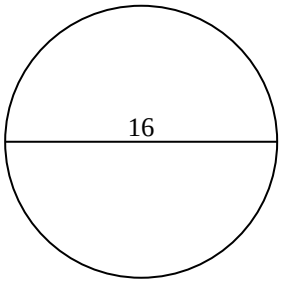

3)

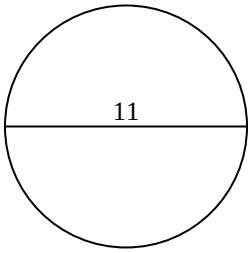

4)

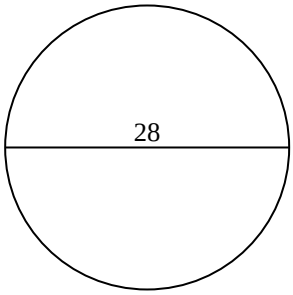

5)

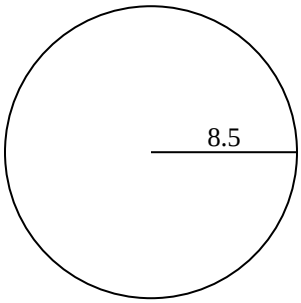

6)

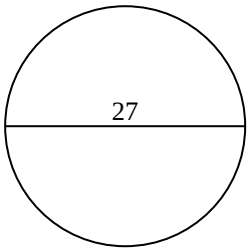

7)

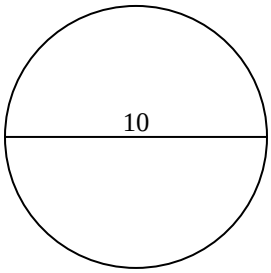

8)

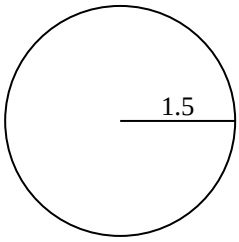

9)

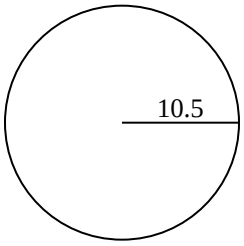

10)

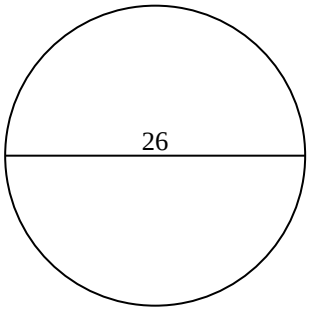

Respuestas

1. _____
2. _____
3. _____
4. _____
5. _____
6. _____
7. _____
8. _____
9. _____
10. _____