Determina el área con bloques

Nombre:

Encuentra el área de cada sección sombreada. Cada bloque tiene 1 unidad cuadrada (u^2)

1)



2)

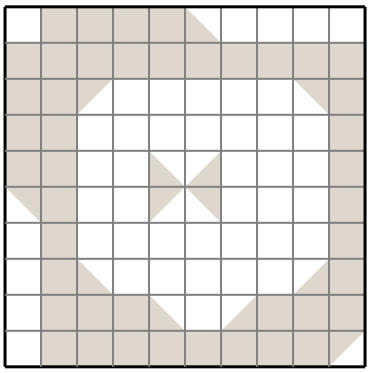

3)

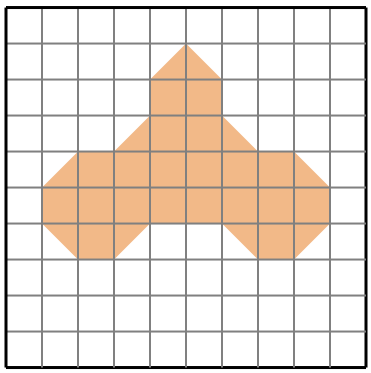

4)

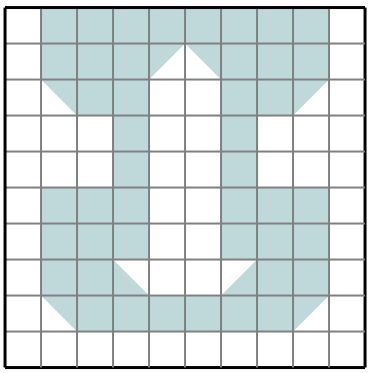

5)

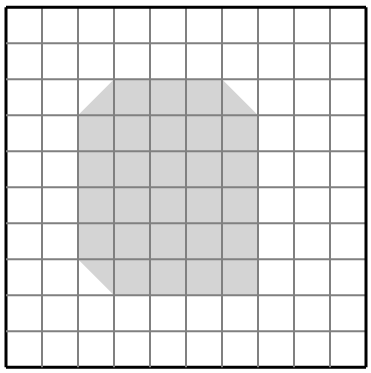

6)



7)

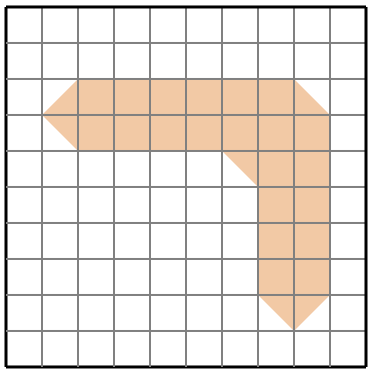

8)

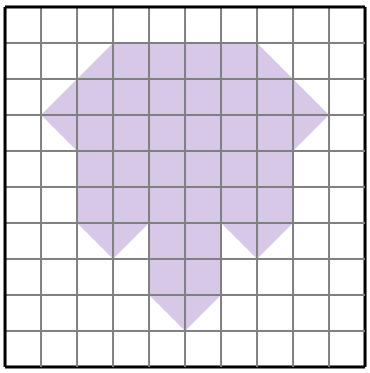

Respuestas

1. _____
2. _____
3. _____
4. _____
5. _____
6. _____
7. _____
8. _____

1-8	88	75	63	50	38	25	13	0

Determina el área con bloques

Nombre: **Clave De Respuestas**

Encuentra el área de cada sección sombreada. Cada bloque tiene 1 unidad cuadrada (u^2)

1)

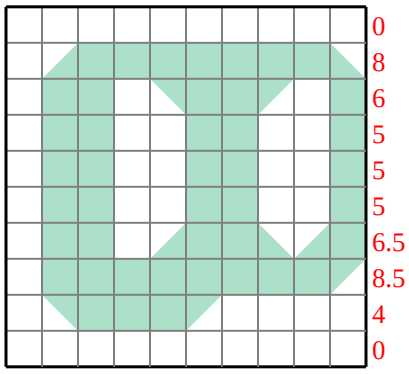

2)

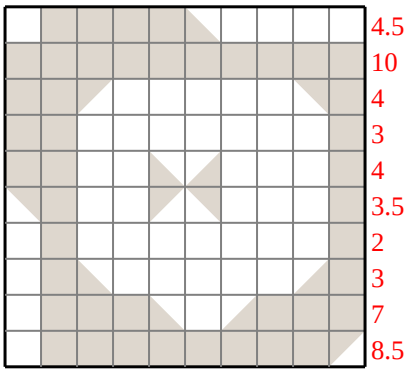

3)

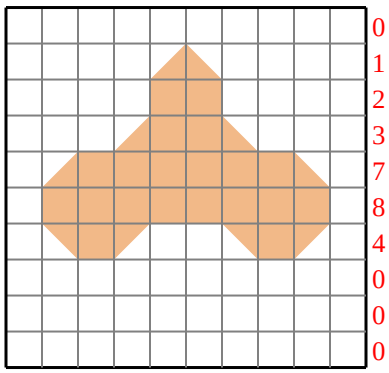

4)

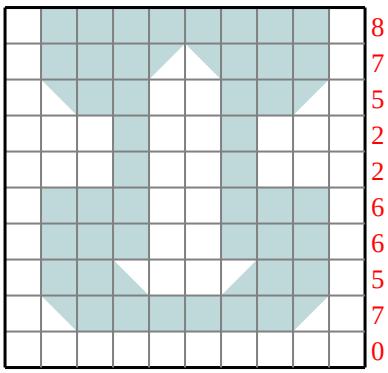

5)

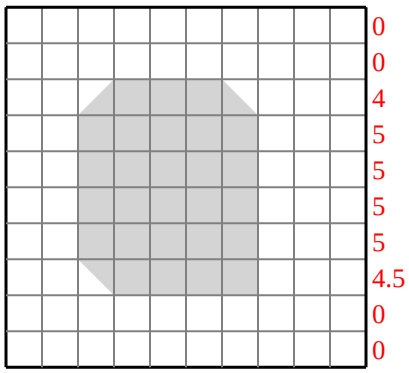

6)

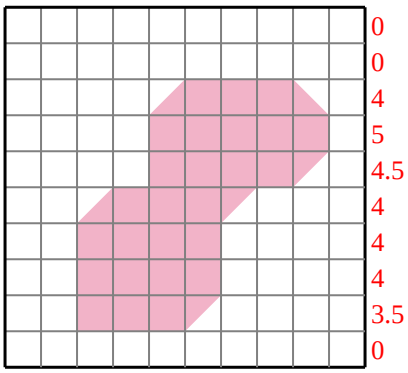

7)

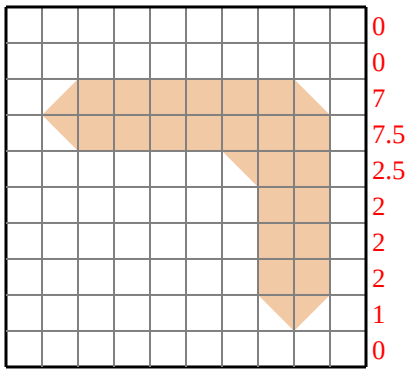

8)

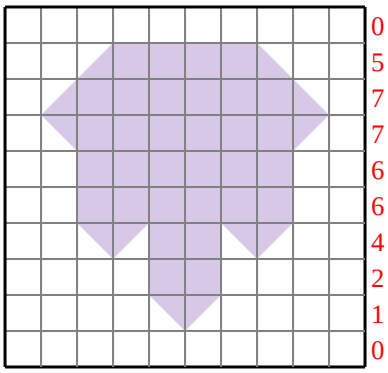

Respuestas

1. **48 u^2**
2. **49.5 u^2**
3. **25 u^2**
4. **48 u^2**
5. **28.5 u^2**
6. **29 u^2**
7. **24 u^2**
8. **38 u^2**

1-8	88	75	63	50	38	25	13	0