Encuentra el área de un círculo

Nombre:

Encuentra el área de cada círculo. Los círculos no están a escala.

1)

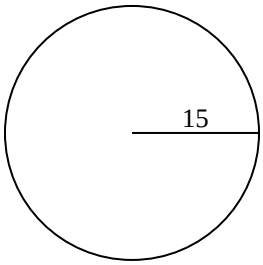

2)

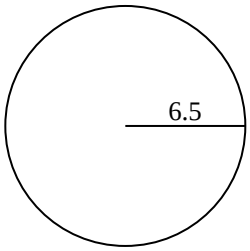

3)

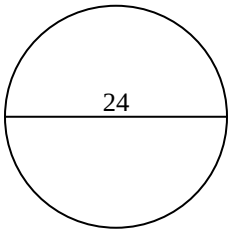

4)

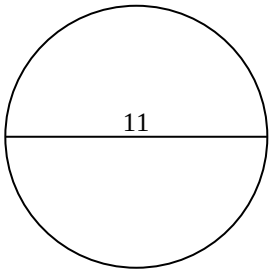

5)

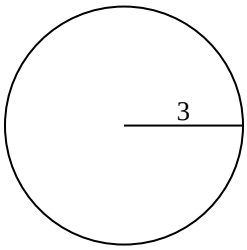

6)

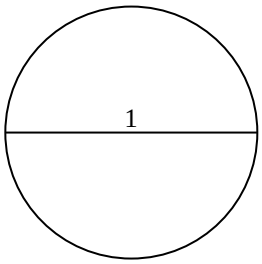

7)

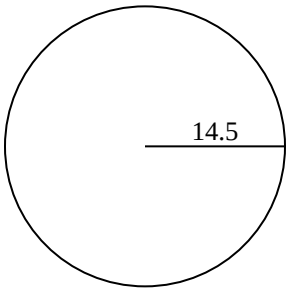

8)

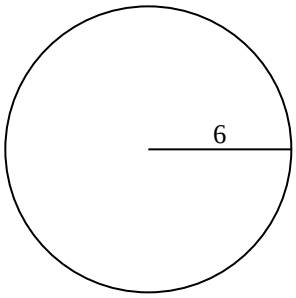

9)

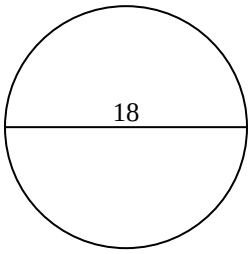

10)

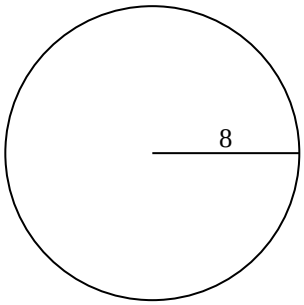

Respuestas

1. _____
2. _____
3. _____
4. _____
5. _____
6. _____
7. _____
8. _____
9. _____
10. _____

1-10	90	80	70	60	50	40	30	20	10	0

Encuentra el área de un círculo

Nombre: **Clave De Respuestas**

Encuentra el área de cada círculo. Los círculos no están a escala.

1)

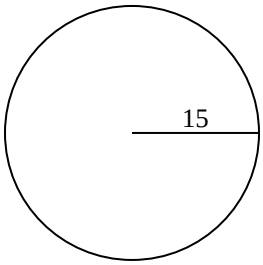

2)

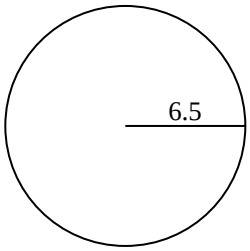

3)

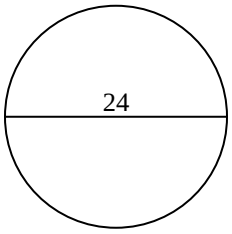

4)

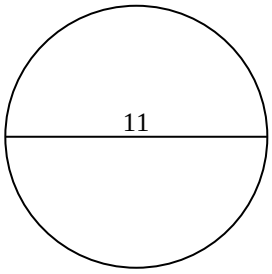

5)

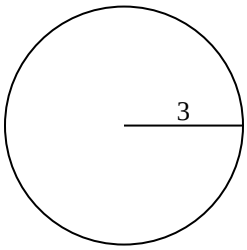

6)

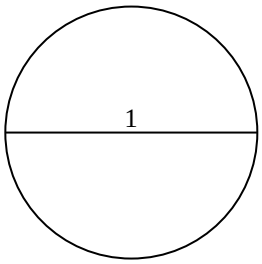

7)

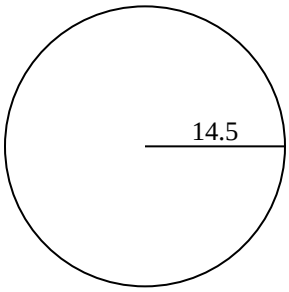

8)

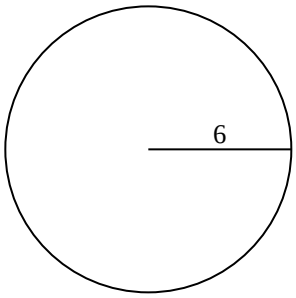

9)

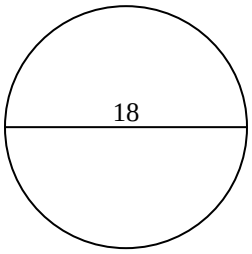

10)

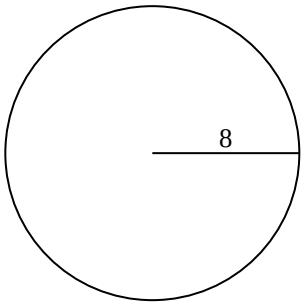

Respuestas

1. **706.9**
2. **132.7**
3. **452.4**
4. **95**
5. **28.3**
6. **0.8**
7. **660.5**
8. **113.1**
9. **254.5**
10. **201.1**

1-10	90	80	70	60	50	40	30	20	10	0

Encuentra el área de un círculo

Nombre:

Encuentra el área de cada círculo. Los círculos no están a escala.

254.5	0.8	28.3	706.9	660.5
132.7	452.4	113.1	95	

1)

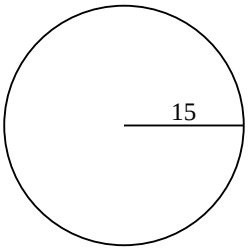

2)

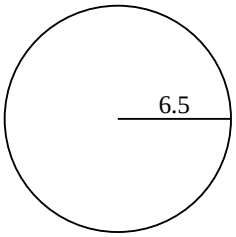

3)

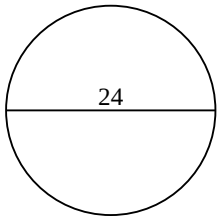

4)

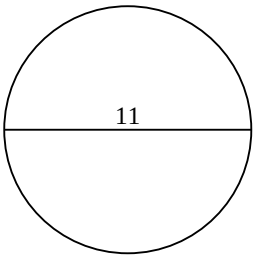

5)

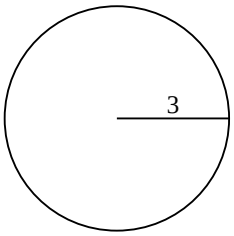

6)

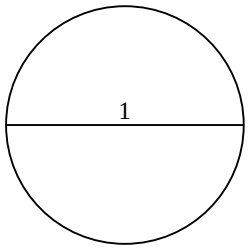

7)

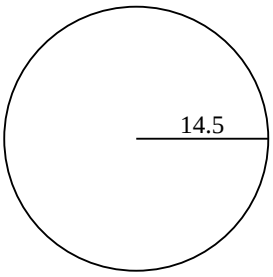

8)

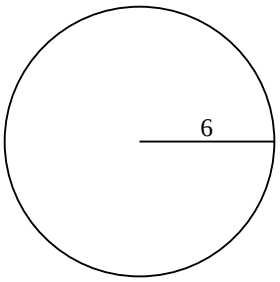

9)

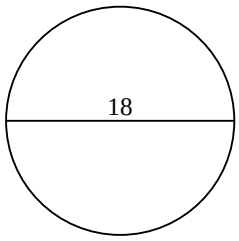

Respuestas

1. _____
2. _____
3. _____
4. _____
5. _____
6. _____
7. _____
8. _____
9. _____