Encuentra el área de un círculo

Nombre:

Encuentra el área de cada círculo. Los círculos no están a escala.

1)

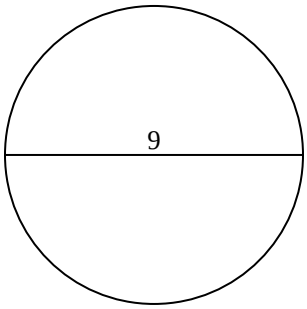

2)

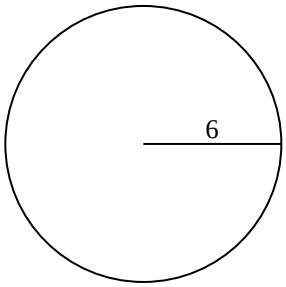

3)

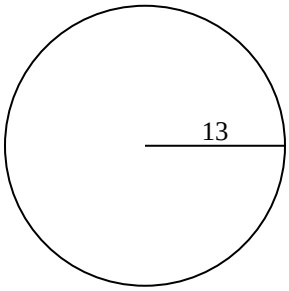

4)

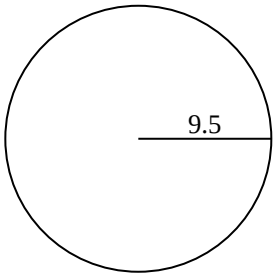

5)

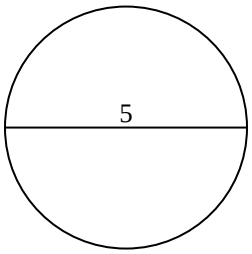

6)

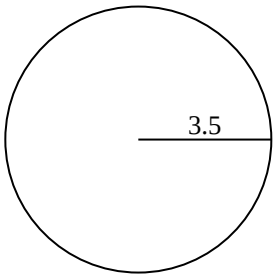

7)

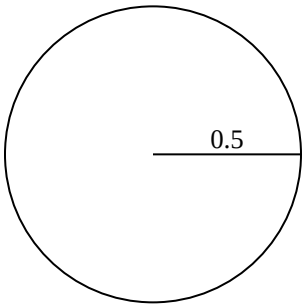

8)

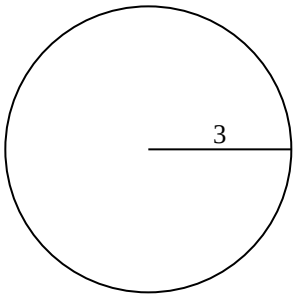

9)

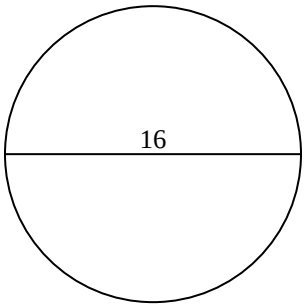

10)

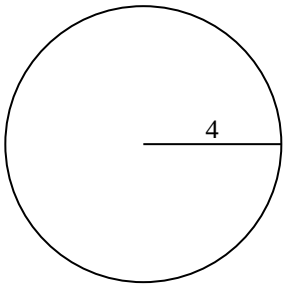

Respuestas

1. _____
2. _____
3. _____
4. _____
5. _____
6. _____
7. _____
8. _____
9. _____
10. _____

1-10	90	80	70	60	50	40	30	20	10	0

Nombre: **Clave De Respuestas**

Encuentra el área de cada círculo. Los círculos no están a escala.

1)

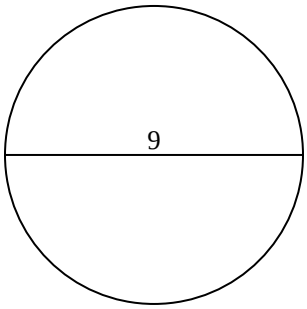

2)

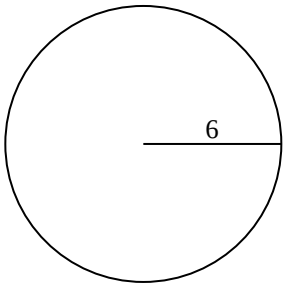

3)

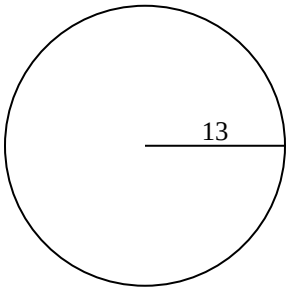

4)

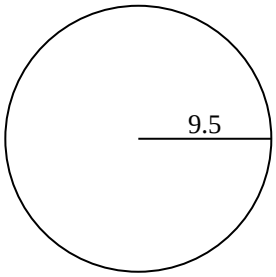

5)

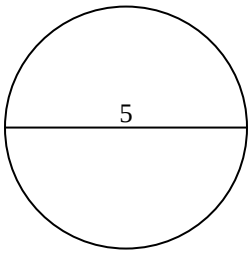

6)

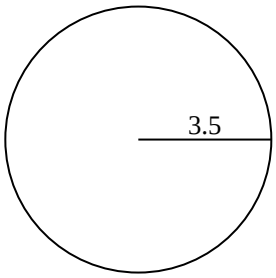

7)

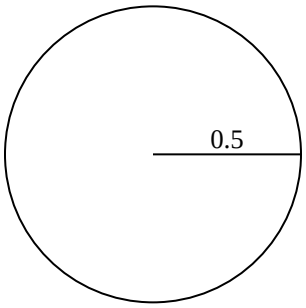

8)

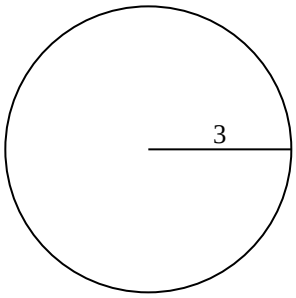

9)

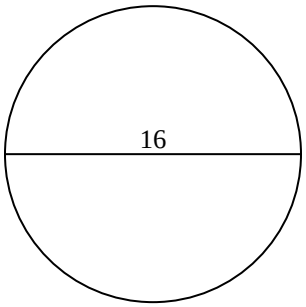

10)

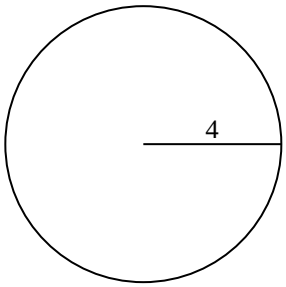

Respuestas

1. **63.6**
2. **113.1**
3. **530.9**
4. **283.5**
5. **19.6**
6. **38.5**
7. **0.8**
8. **28.3**
9. **201.1**
10. **50.3**

1-10	90	80	70	60	50	40	30	20	10	0

Encuentra el área de un círculo

Nombre:

Encuentra el área de cada círculo. Los círculos no están a escala.

28.3	113.1	201.1	38.5	283.5
0.8	19.6	63.6	530.9	

1)

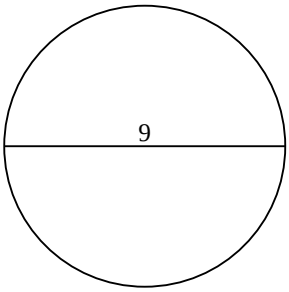

2)

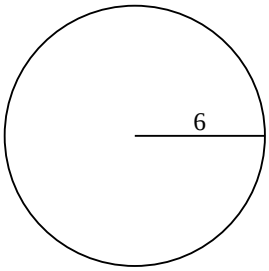

3)

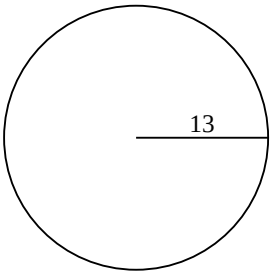

4)

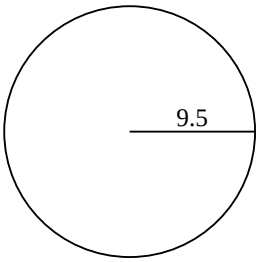

5)

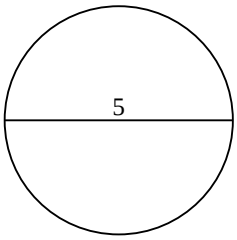

6)

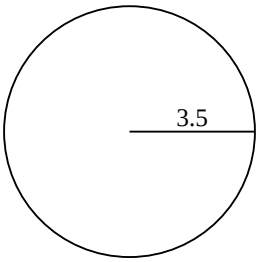

7)

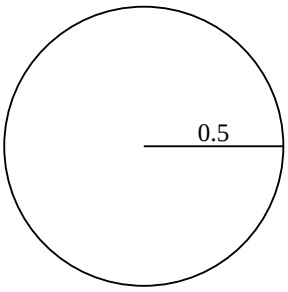

8)

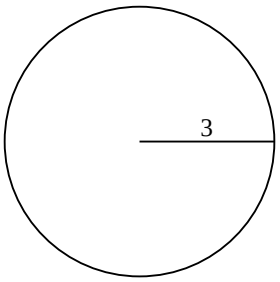

9)

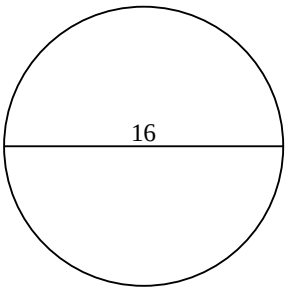

Respuestas

1. _____
2. _____
3. _____
4. _____
5. _____
6. _____
7. _____
8. _____
9. _____

1-9	89	78	67	56	44	33	22	11	0