Encuentra los ángulos suplementarios Nombre:

Encuentra el valor de 'A' en el conjunto de ángulos suplementarios.

1)

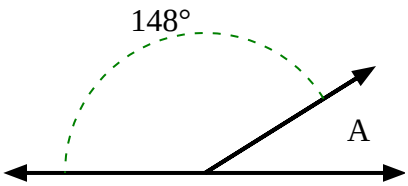

2)

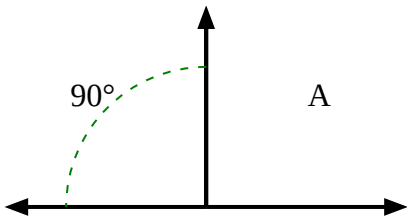

3)

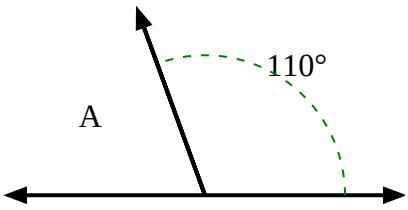

4)

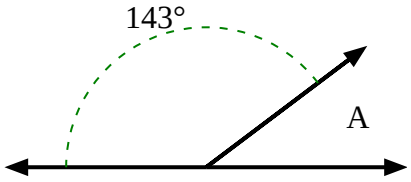

5)

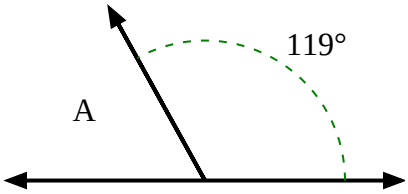

6)

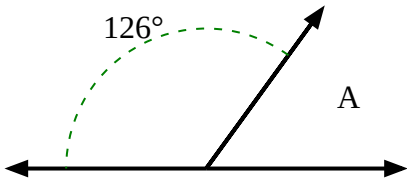

7)

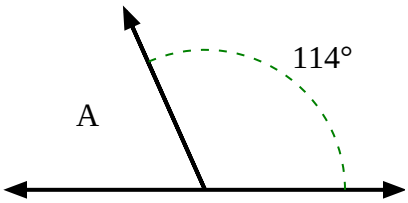

8)

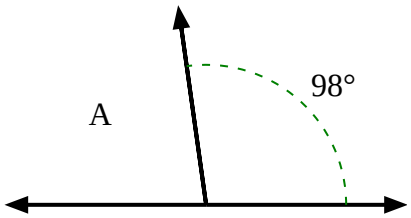

9)

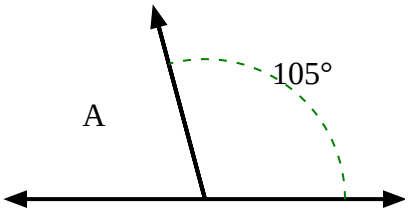

10)

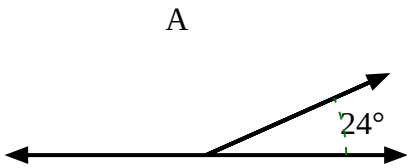

Respuestas

1. _____
2. _____
3. _____
4. _____
5. _____
6. _____
7. _____
8. _____
9. _____
10. _____

1-10	90	80	70	60	50	40	30	20	10	0

Encuentra el valor de 'A' en el conjunto de ángulos suplementarios.

1)

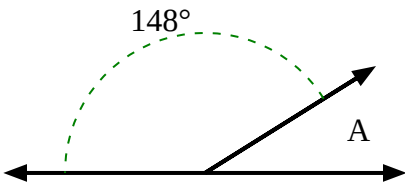

2)

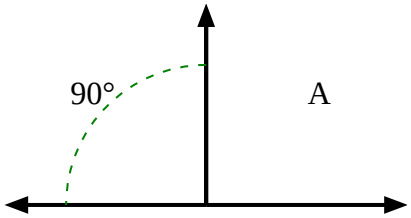

3)

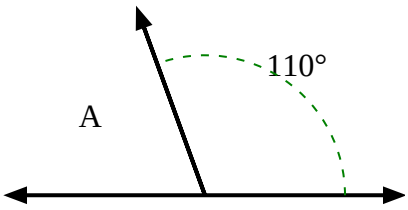

4)

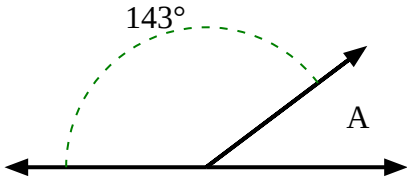

5)

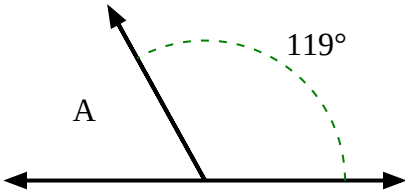

6)

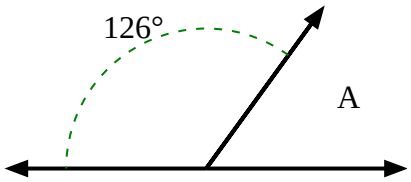

7)

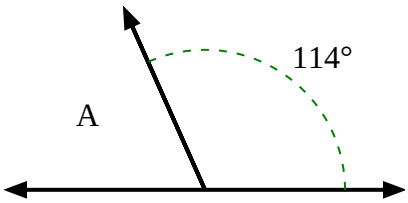

8)

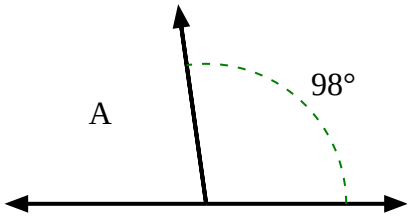

9)

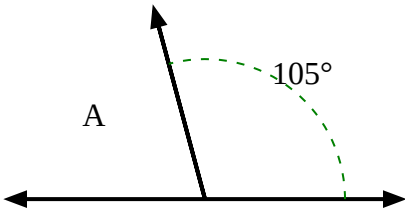

10)

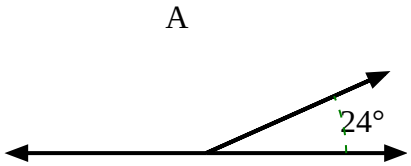

Respuestas

1. **32°**
2. **90°**
3. **70°**
4. **37°**
5. **61°**
6. **54°**
7. **66°**
8. **82°**
9. **75°**
10. **156°**

1-10	90	80	70	60	50	40	30	20	10	0