Encontrando el volumen

Nombre:

Encontrar el volumen de cada prisma rectangular. Recuerda V = Base × Altura y V=Largo × ancho × alto.

1)

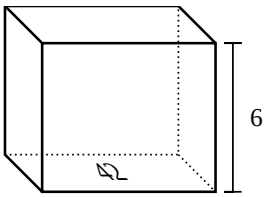

2)

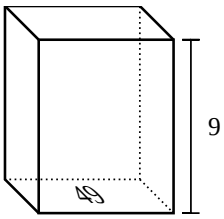

3)

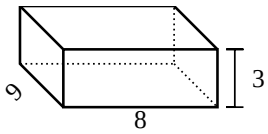

4)

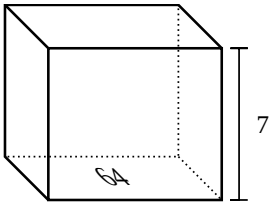

5)

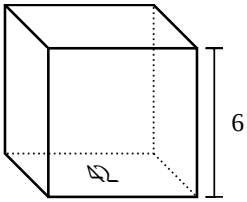

6)

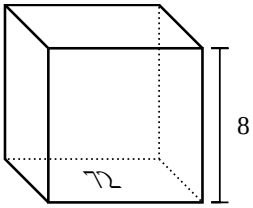

7)

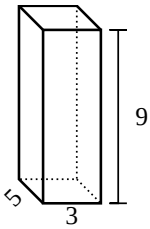

8)

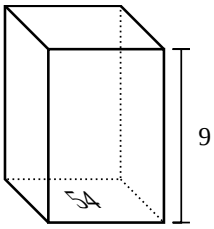

9)

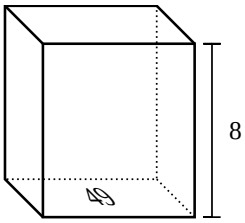

10)

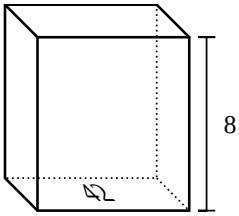

11)

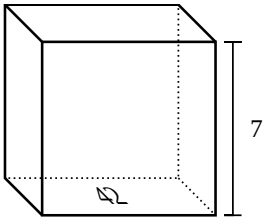

12)

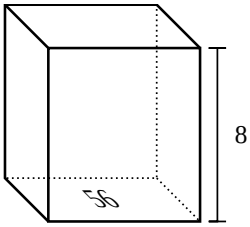

13)

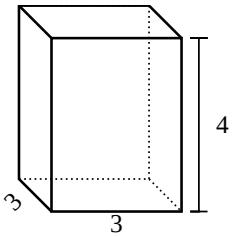

14)

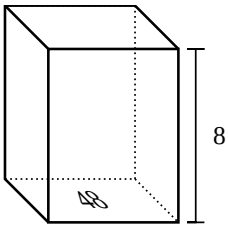

15)

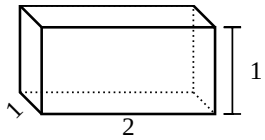

Respuestas

1. _____
2. _____
3. _____
4. _____
5. _____
6. _____
7. _____
8. _____
9. _____
10. _____
11. _____
12. _____
13. _____
14. _____
15. _____

1-10	93	87	80	73	67	60	53	47	40	33
11-15	27	20	13	7	0					

Encontrando el volumen

Nombre: **Clave De Respuestas**

Encontrar el volumen de cada prisma rectangular. Recuerda V = Base × Altura y V=Largo × ancho × alto.

1)

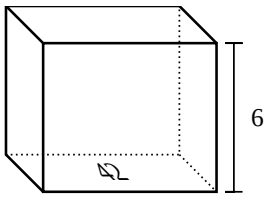

2)

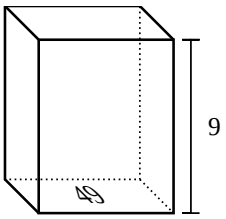

3)

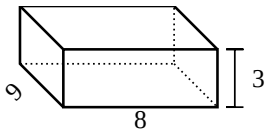

4)

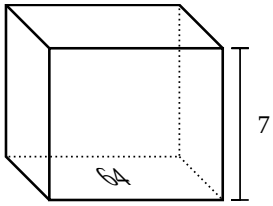

5)

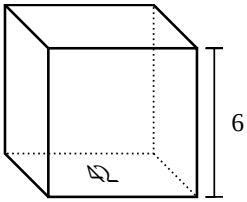

6)

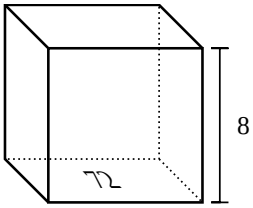

7)

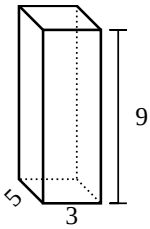

8)

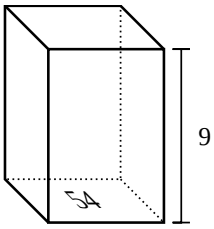

9)

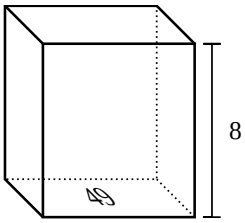

10)

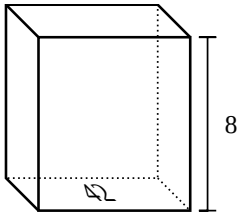

11)

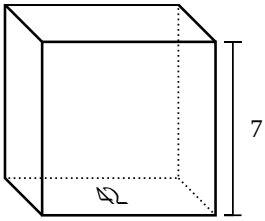

12)

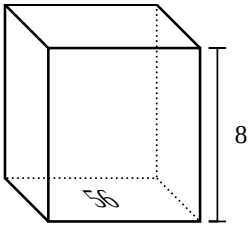

13)

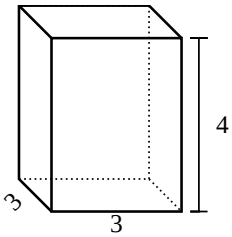

14)

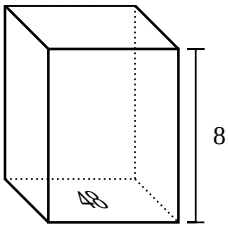

15)

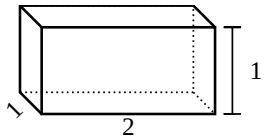

Respuestas

1. $252\ cm^3$
2. $441\ cm^3$
3. $216\ cm^3$
4. $448\ cm^3$
5. $252\ cm^3$
6. $576\ cm^3$
7. $135\ cm^3$
8. $486\ cm^3$
9. $392\ cm^3$
10. $336\ cm^3$
11. $294\ cm^3$
12. $448\ cm^3$
13. $36\ cm^3$
14. $384\ cm^3$
15. $2\ cm^3$

1-10	93	87	80	73	67	60	53	47	40	33
11-15	27	20	13	7	0					