Determinación del volumen de los prismas rectangulares unidos Nombre:

Encuentra el volumen total de cada figura. La medida es en cm (no a escala).

Respuestas

1. _____

2. _____

3. _____

4. _____

5. _____

1)

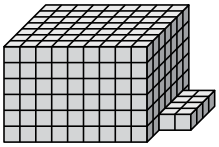

2)

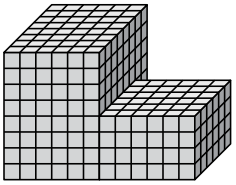

3)

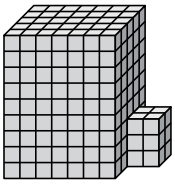

4)

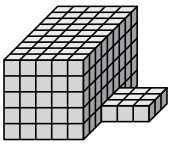

5)

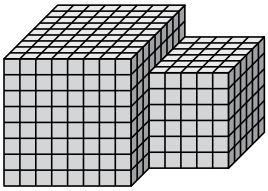

1-5	80	60	40	20	0

Determinación del volumen de los prismas rectangulares unidos Nombre: **Clave De Respuestas**

Encuentra el volumen total de cada figura. La medida es en cm (no a escala).

1)

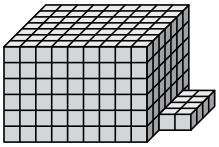

$9 \times 7 \times 6 = 378$
$2 \times 4 \times 1 = 8$

2)

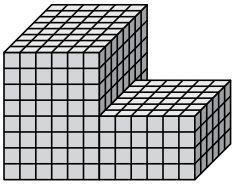

$6 \times 8 \times 8 = 384$
$6 \times 6 \times 4 = 144$

3)

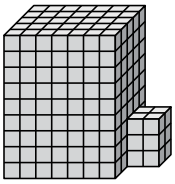

$7 \times 5 \times 9 = 315$
$2 \times 2 \times 3 = 12$

4)

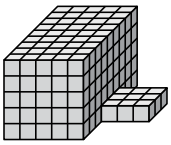

$5 \times 9 \times 5 = 225$
$3 \times 3 \times 1 = 9$

5)

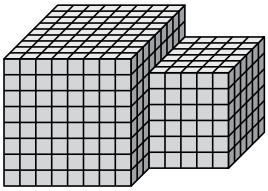

$8 \times 9 \times 8 = 576$
$5 \times 6 \times 6 = 180$

Respuestas

1. **386 cm^3**
2. **528 cm^3**
3. **327 cm^3**
4. **234 cm^3**
5. **756 cm^3**

1-5	80	60	40	20	0