Encondo los ángulos faltantes

Nombre:

Encuentra el valor del ángulo 'A' y el ángulo 'B'.

1)

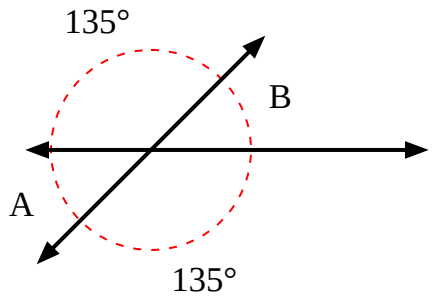

2)

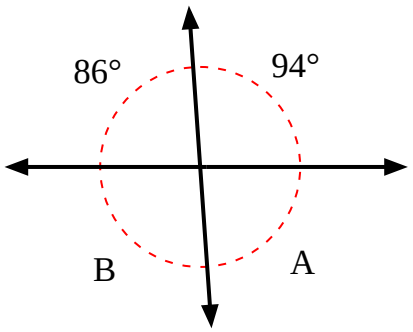

3)

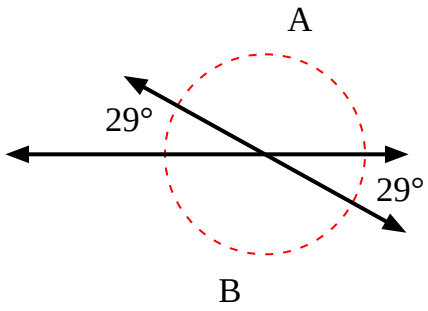

4)

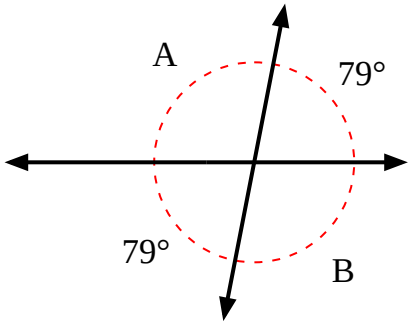

5)

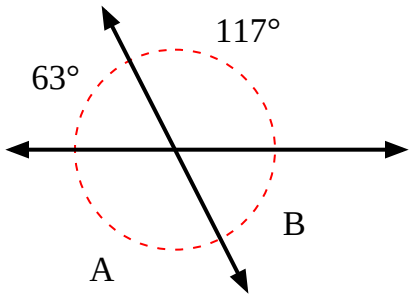

6)

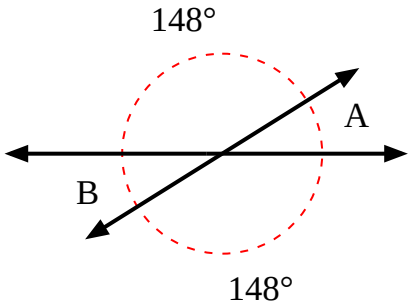

7)

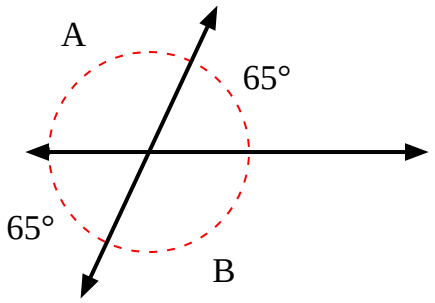

8)

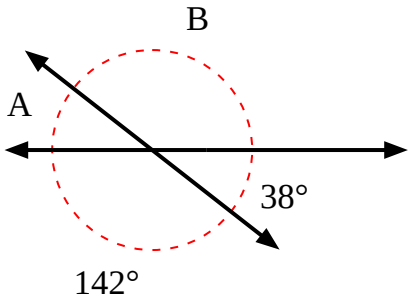

Respuestas

1. _____ _____
2. _____ _____
3. _____ _____
4. _____ _____
5. _____ _____
6. _____ _____
7. _____ _____
8. _____ _____

1-8	88	75	63	50	38	25	13	0

Encondo los ángulos faltantes

Nombre: **Clave De Respuestas**

Encuentra el valor del ángulo 'A' y el ángulo 'B'.

1)

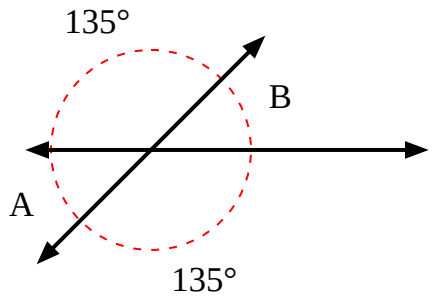

2)

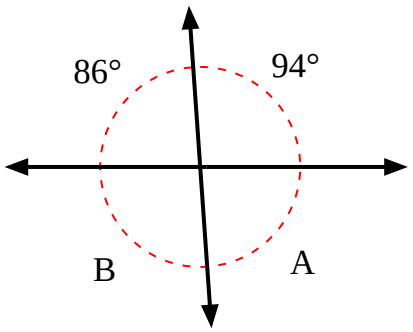

3)

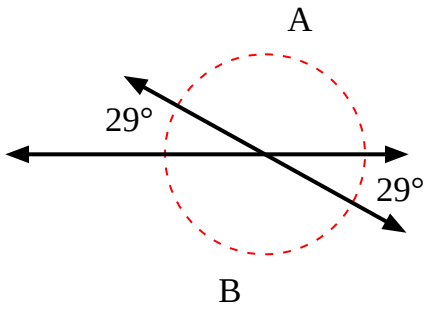

4)

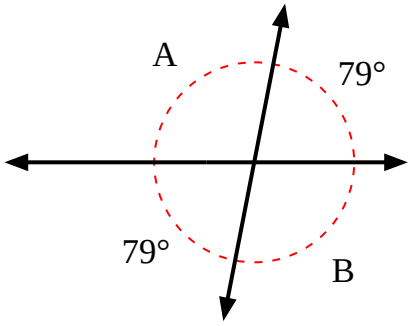

5)

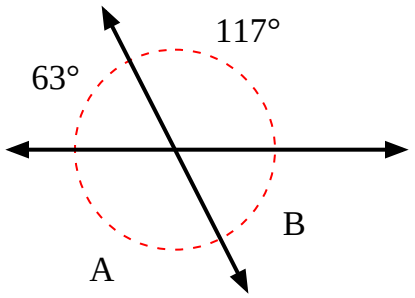

6)

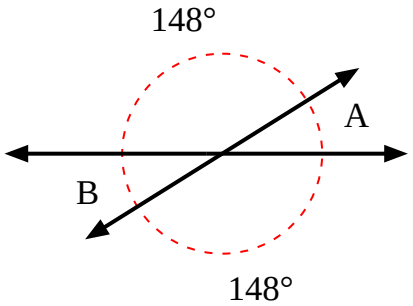

7)

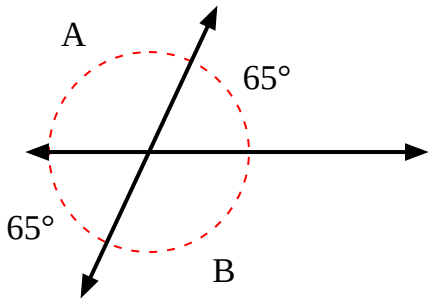

8)

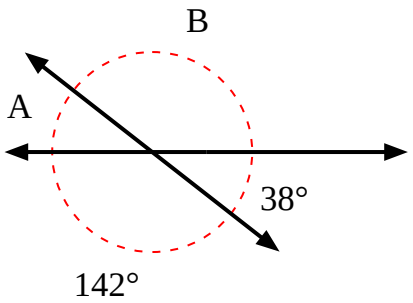

Respuestas

1.	45°	45°
2.	86°	94°
3.	151°	151°
4.	101°	101°
5.	117°	63°
6.	32°	32°
7.	115°	115°
8.	38°	142°

1-8	88	75	63	50	38	25	13	0