Determinando un Ángulo Visualmente

Nombre:

Determina si el ángulo mostrado es agudo, obtuso, recto o llano.

Ej)

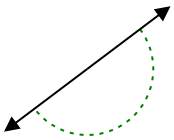

1)

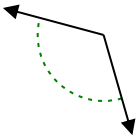

2)

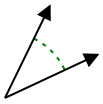

3)

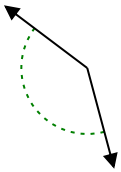

4)

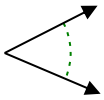

5)

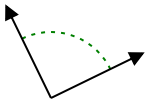

6)

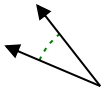

7)

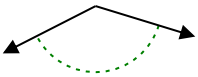

8)

9)

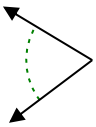

10)

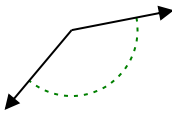

11)

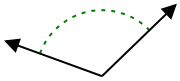

12)

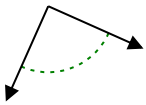

13)

14)

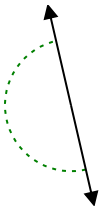

15)

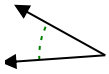

16)

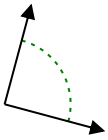

17)

18)

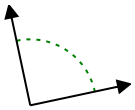

19)

20)

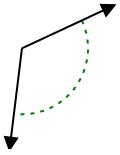

Respuestas

Ej. recto

1. _____
2. _____
3. _____
4. _____
5. _____
6. _____
7. _____
8. _____
9. _____
10. _____
11. _____
12. _____
13. _____
14. _____
15. _____
16. _____
17. _____
18. _____
19. _____
20. _____

1-10	95	90	85	80	75	70	65	60	55	50
11-20	45	40	35	30	25	20	15	10	5	0

Determinando un Ángulo Visualmente

Nombre: **Clave De Respuestas**

Determina si el ángulo mostrado es agudo, obtuso, recto o llano.

Ej)

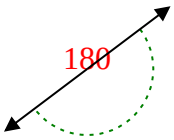

1)

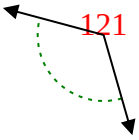

2)

3)

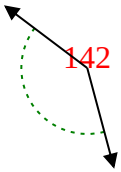

4)

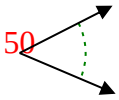

5)

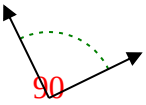

6)

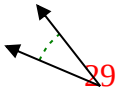

7)

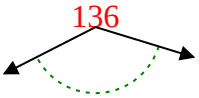

8)

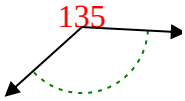

9)

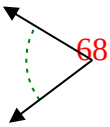

10)

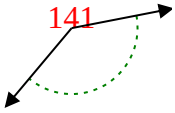

11)

12)

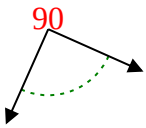

13)

14)

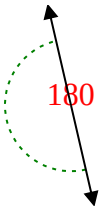

15)

16)

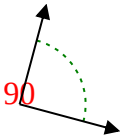

17)

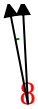

18)

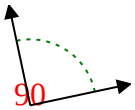

19)

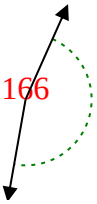

20)

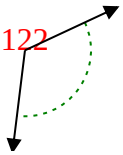

Respuestas

Ej. recto
1. obtuso
2. agudo
3. obtuso
4. agudo
5. derecho
6. agudo
7. obtuso
8. obtuso
9. agudo
10. obtuso
11. obtuso
12. derecho
13. agudo
14. recto
15. agudo
16. derecho
17. agudo
18. derecho
19. obtuso
20. obtuso

1-10	95	90	85	80	75	70	65	60	55	50
11-20	45	40	35	30	25	20	15	10	5	0