Crear de triángulos

Nombre:

Utiliza un transportador para crear un triángulo a partir de la figura que se muestra. Responde con los ángulos que faltan. Las respuestas variarán.

1)

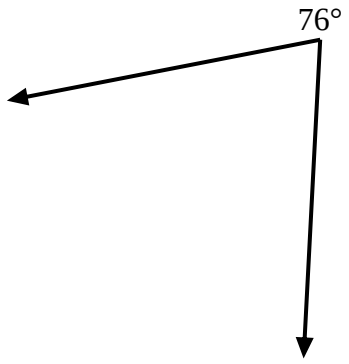

2)

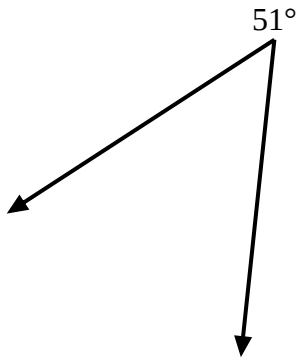

3)

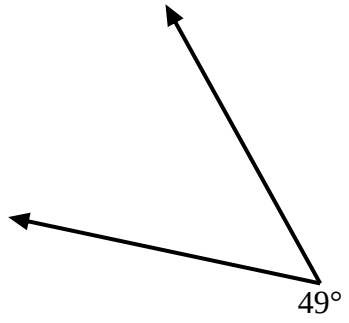

4)

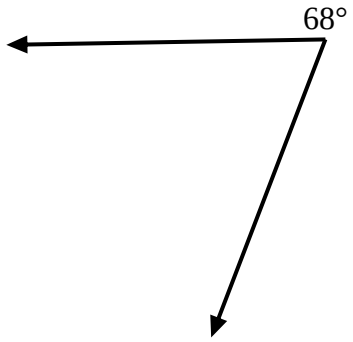

5)

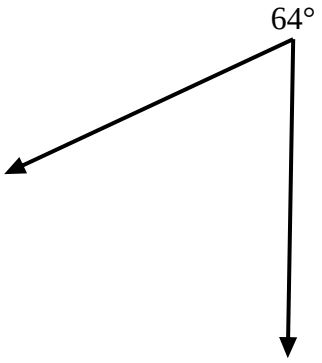

6)

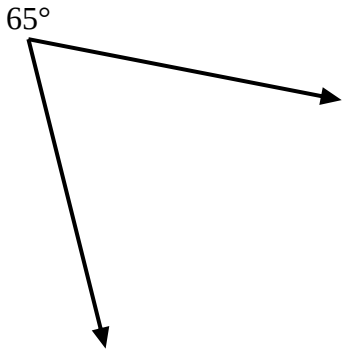

7)

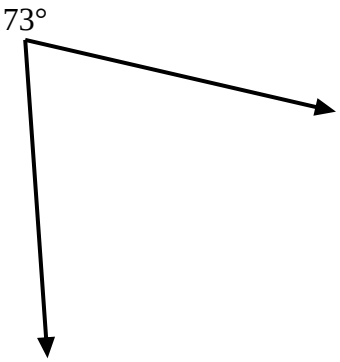

8)

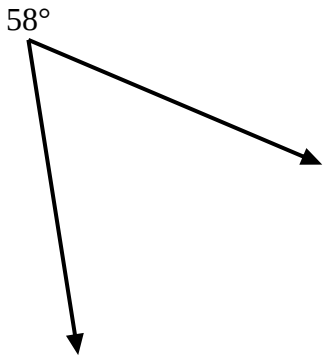

Respuestas

1. _____
2. _____
3. _____
4. _____
5. _____
6. _____
7. _____
8. _____

1-8	88	75	63	50	38	25	13	0

Crear de triángulos

Nombre: **Clave De Respuestas**

Utiliza un transportador para crear un triángulo a partir de la figura que se muestra. Responde con los ángulos que faltan. Las respuestas variarán.

1)

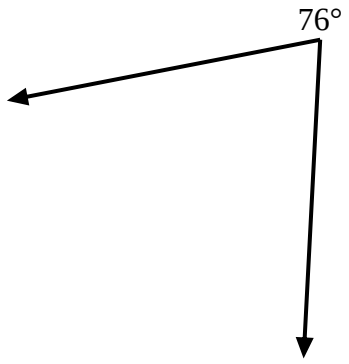

2)

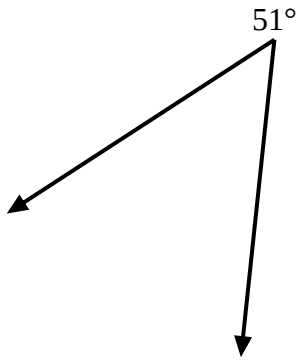

3)

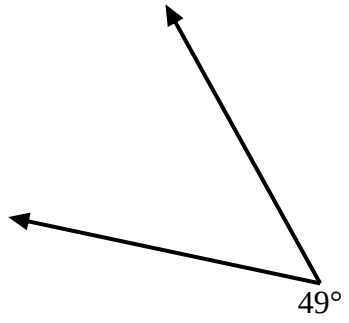

4)

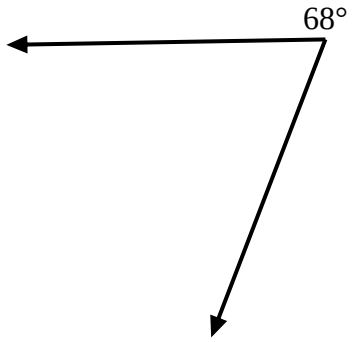

5)

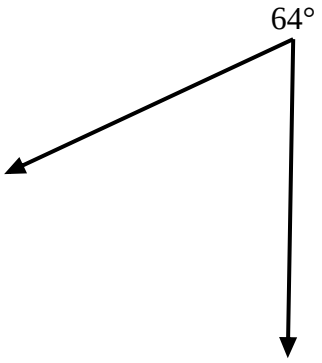

6)

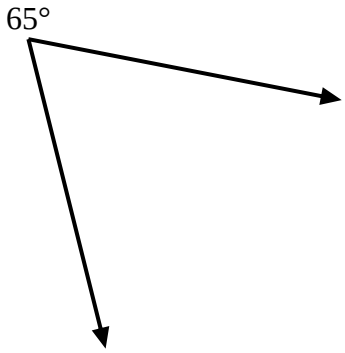

7)

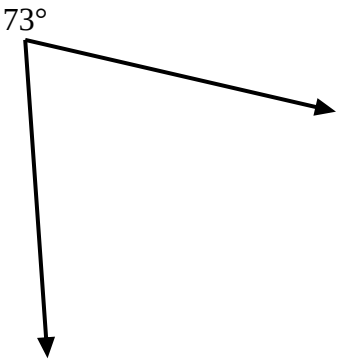

8)

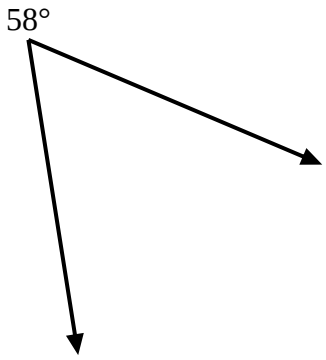

Respuestas

1. =104
2. =129
3. =131
4. =112
5. =116
6. =115
7. =107
8. =122